Encontrando ángulos con formas

Nombre:

Cuenta el número de ángulos Agudos, Obtusos y Rectos dentro de cada figura

Ej)

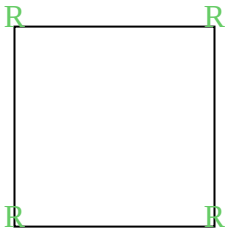

1)

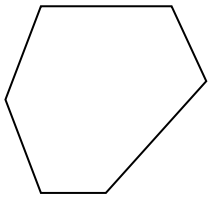

2)

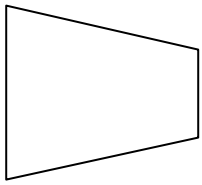

3)

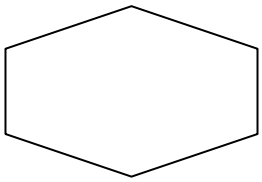

4)

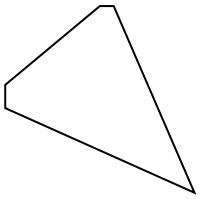

5)

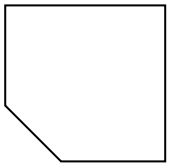

6)

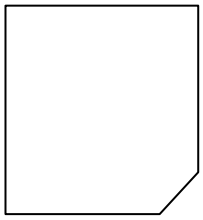

7)

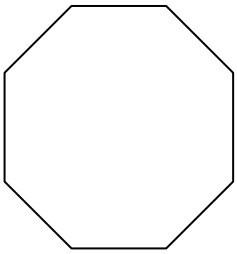

8)

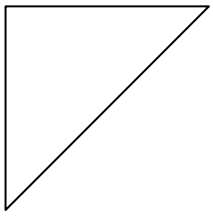

9)

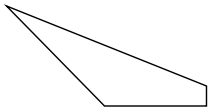

10)

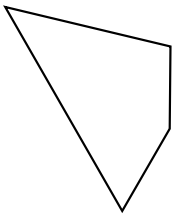

11)

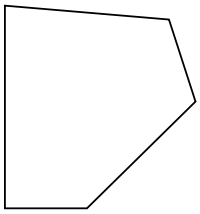

Respuestas

	A	O	R
Ej.	0	0	4
1.			
2.			
3.			
4.			
5.			
6.			
7.			
8.			
9.			
10.			
11.			

1-10	91	82	73	64	55	45	36	27	18	9
11	0									

Nombre: **Clave De Respuestas**

Cuenta el número de ángulos Agudos, Obtusos y Rectos dentro de cada figura

Ej)

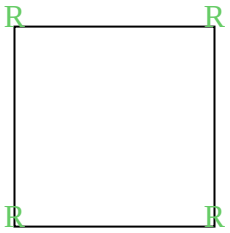

1)

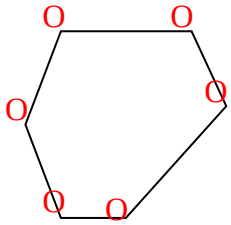

2)

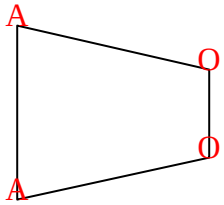

3)

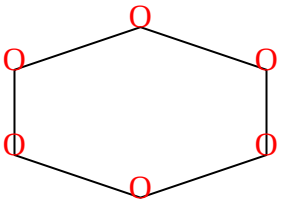

4)

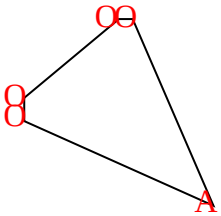

5)

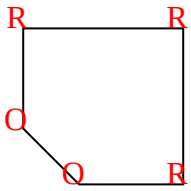

6)

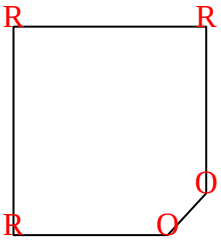

7)

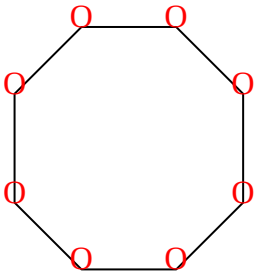

8)

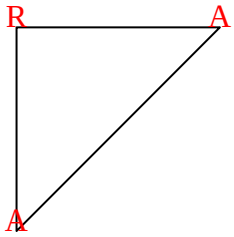

9)

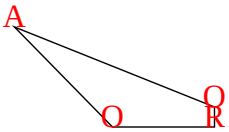

10)

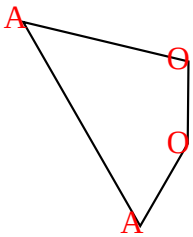

11)

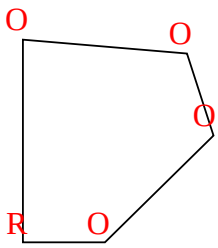

Respuestas

	A	O	R
Ej.	0	0	4
1.	0	6	0
2.	2	2	0
3.	0	6	0
4.	1	4	0
5.	0	2	3
6.	0	2	3
7.	0	8	0
8.	2	0	1
9.	1	2	1
10.	2	2	0
11.	0	4	1

1-10	91	82	73	64	55	45	36	27	18	9
11	0									