Encontrando ángulos con formas

Nombre:

Cuenta el número de ángulos Agudos, Obtusos, Rectos y Reflejos dentro de cada figura.

Ej)

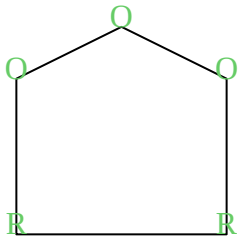

1)

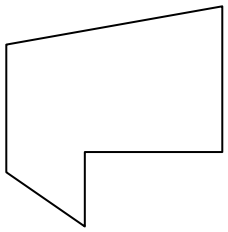

2)

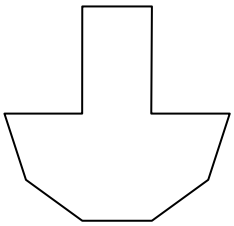

3)

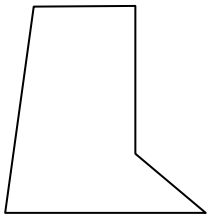

4)

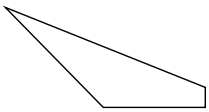

5)

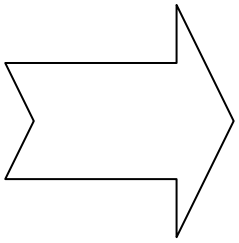

6)

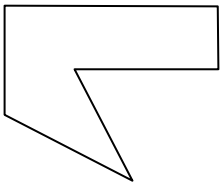

7)



8)

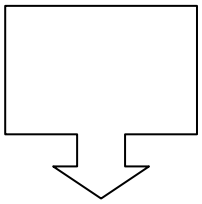

9)

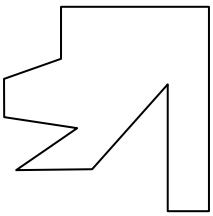

10)

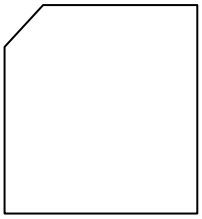

11)

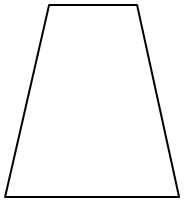

Respuestas

	A	O	R	X
Ej.	0	3	2	0
1.				
2.				
3.				
4.				
5.				
6.				
7.				
8.				
9.				
10.				
11.				

1-10	91	82	73	64	55	45	36	27	18	9
11	0									

Cuenta el número de ángulos Agudos, Obtusos, Rectos y Reflejos dentro de cada figura.

Ej)

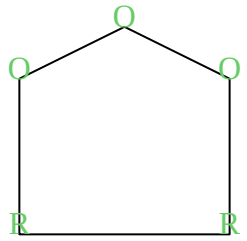

1)

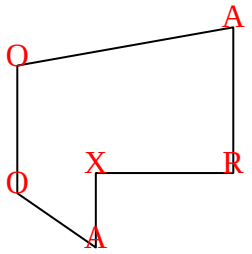

2)

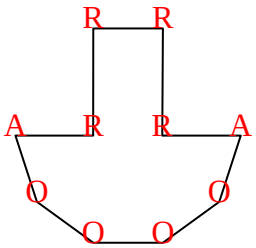

3)

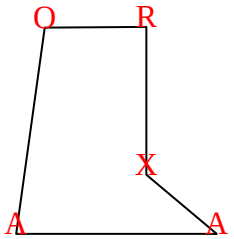

4)

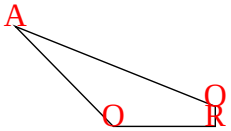

5)

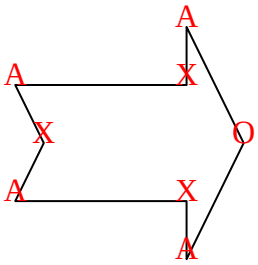

6)

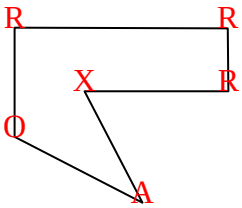

7)

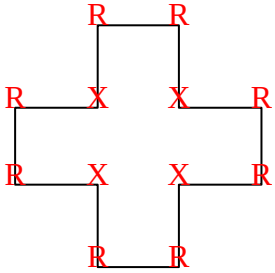

8)

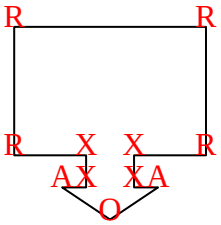

9)

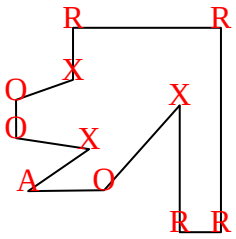

10)

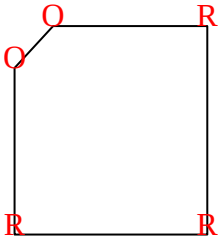

11)

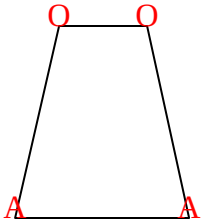

Respuestas

	A	O	R	X
Ej.	0	3	2	0
1.	2	2	1	1
2.	2	4	4	0
3.	2	1	1	1
4.	1	2	1	0
5.	4	1	0	3
6.	1	1	3	1
7.	0	0	8	4
8.	2	1	4	4
9.	1	3	4	3
10.	0	2	3	0
11.	2	2	0	0

1-10	91	82	73	64	55	45	36	27	18	9
11	0									