Encontrando ángulos con formas

Nombre:

Cuenta el número de ángulos Agudos, Obtusos, Rectos y Reflejos dentro de cada figura.

Ej)

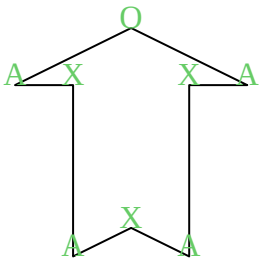

1)



2)

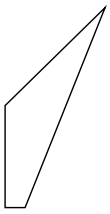

3)

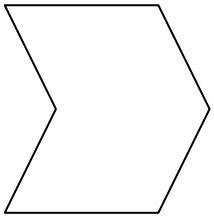

4)

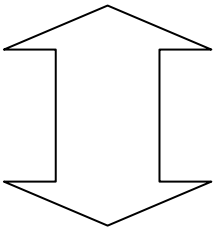

5)

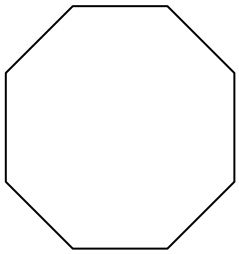

6)

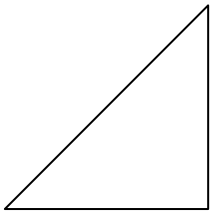

7)



8)



9)

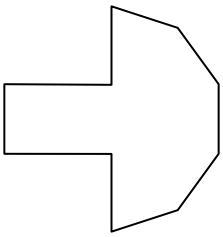

10)

11)

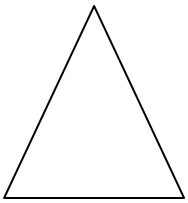

Respuestas

	A	O	R	X
Ej.	4	1	0	3
1.				
2.				
3.				
4.				
5.				
6.				
7.				
8.				
9.				
10.				
11.				

1-10	91	82	73	64	55	45	36	27	18	9
11	0									

Nombre: **Clave De Respuestas**

Cuenta el número de ángulos Agudos, Obtusos, Rectos y Reflejos dentro de cada figura.

Ej)

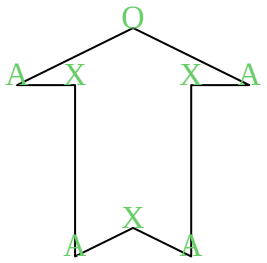

1)

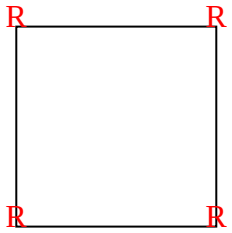

2)

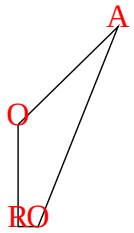

3)

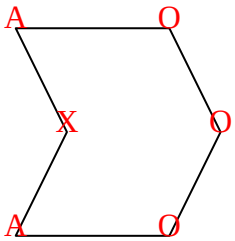

4)

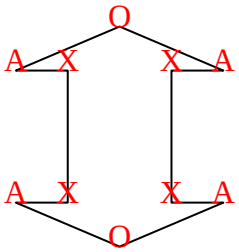

5)

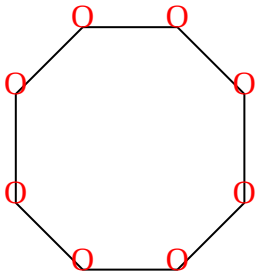

6)

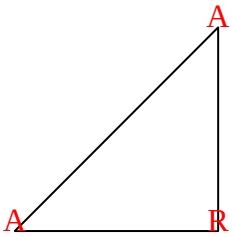

7)

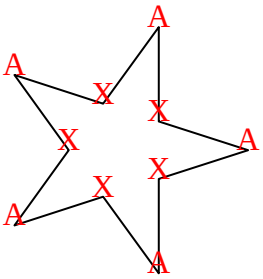

8)

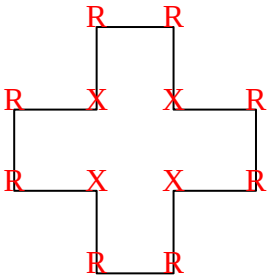

9)

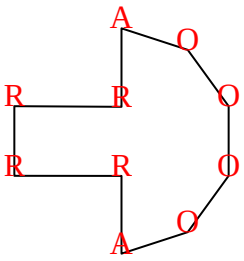

10)



11)

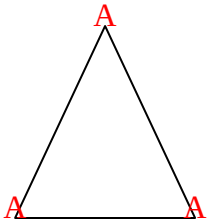

Respuestas

	A	O	R	X
Ej.	4	1	0	3
1.	0	0	4	0
2.	1	2	1	0
3.	2	3	0	1
4.	4	2	0	4
5.	0	8	0	0
6.	2	0	1	0
7.	5	0	0	5
8.	0	0	8	4
9.	2	4	4	0
10.	0	0	4	0
11.	3	0	0	0

1-10	91	82	73	64	55	45	36	27	18	9
11	0									