Dividiendo con una recta numérica

Nombre:

Usa las rectas numéricas para resolver los problemas.

1) 32 ÷ 8 =

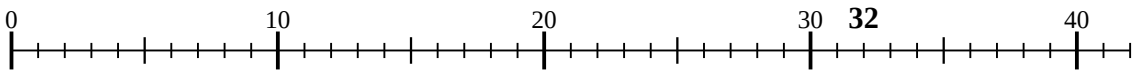

2) 20 ÷ 10 =

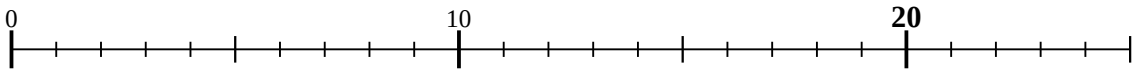

3) 40 ÷ 10 =

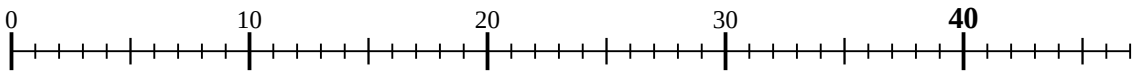

4) 15 ÷ 3 =

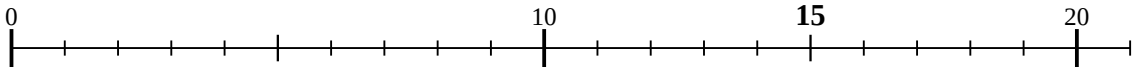

5) 9 ÷ 3 =

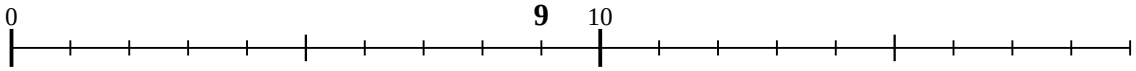

6) 10 ÷ 5 =

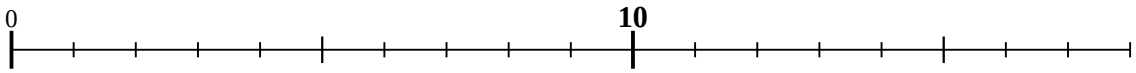

7) 8 ÷ 4 =



8) 36 ÷ 9 =

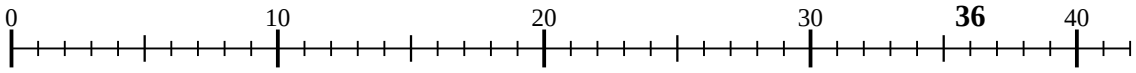

9) 12 ÷ 3 =

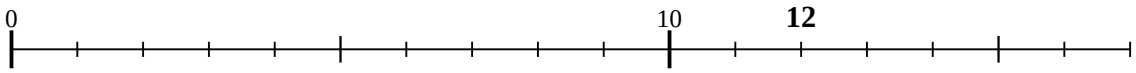

10) 6 ÷ 2 =



11) 8 ÷ 2 =

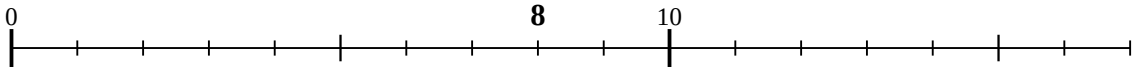

Respuestas

1. _____
2. _____
3. _____
4. _____
5. _____
6. _____
7. _____
8. _____
9. _____
10. _____
11. _____

1-10	91	82	73	64	55	45	36	27	18	9
11	0									

Dividiendo con una recta numérica

Nombre: **Clave De Respuestas**

Usa las rectas numéricas para resolver los problemas.

1) 32 ÷ 8 =

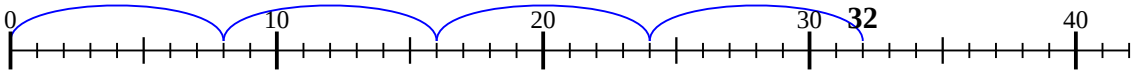

2) 20 ÷ 10 =

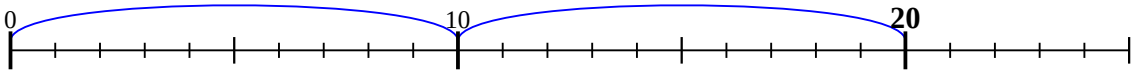

3) 40 ÷ 10 =

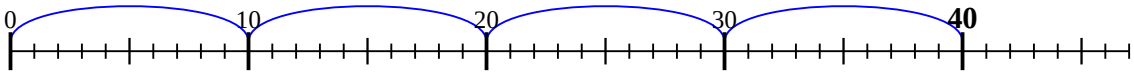

4) 15 ÷ 3 =

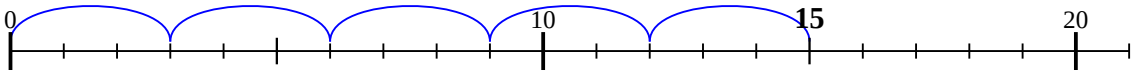

5) 9 ÷ 3 =

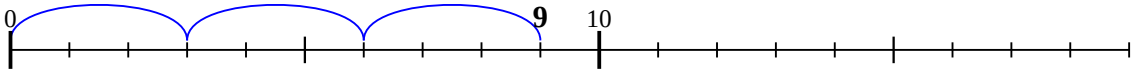

6) 10 ÷ 5 =

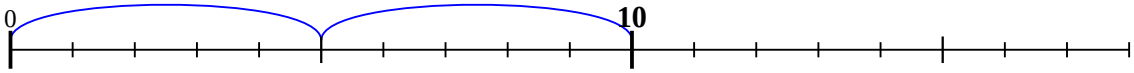

7) 8 ÷ 4 =



8) 36 ÷ 9 =

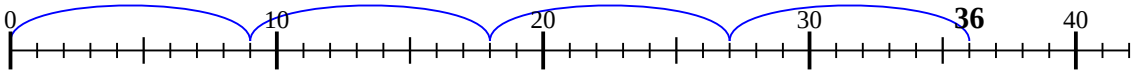

9) 12 ÷ 3 =

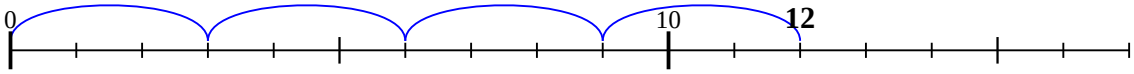

10) 6 ÷ 2 =

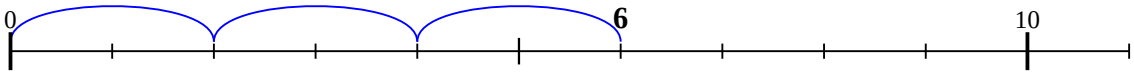

11) 8 ÷ 2 =

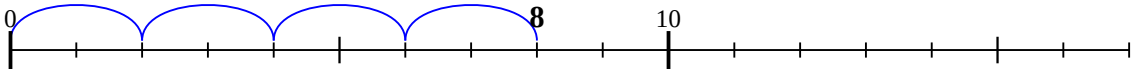

Respuestas

1. 4
2. 2
3. 4
4. 5
5. 3
6. 2
7. 2
8. 4
9. 4
10. 3
11. 4

1-10	91	82	73	64	55	45	36	27	18	9
11	0									