Dividiendo con una recta numérica

Nombre:

Usa las rectas numéricas para resolver los problemas.

1) 36 ÷ 9 =

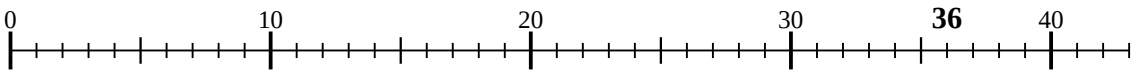

2) 8 ÷ 4 =

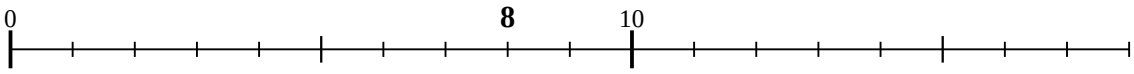

3) 21 ÷ 7 =

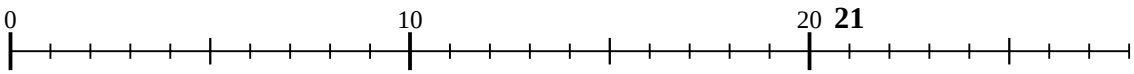

4) 12 ÷ 4 =

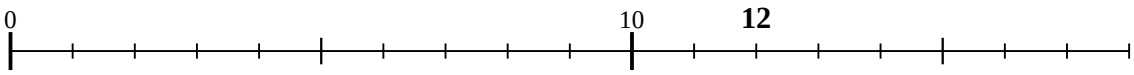

5) 20 ÷ 4 =

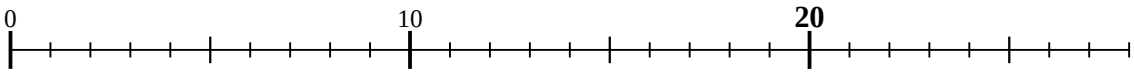

6) 28 ÷ 7 =

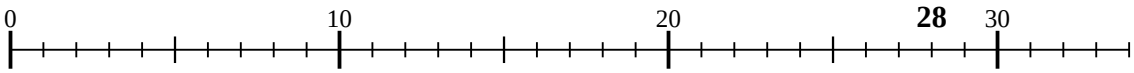

7) 40 ÷ 8 =

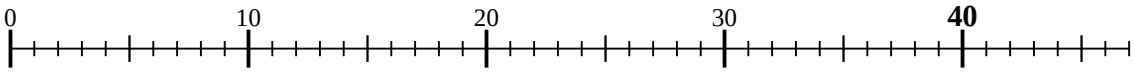

8) 16 ÷ 4 =

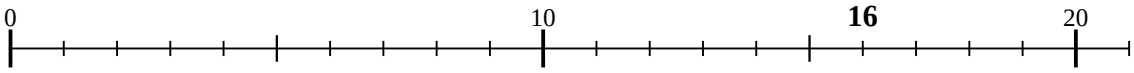

9) 15 ÷ 5 =

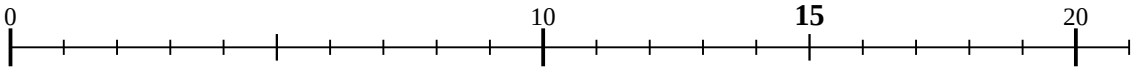

10) 4 ÷ 2 =



11) 32 ÷ 8 =

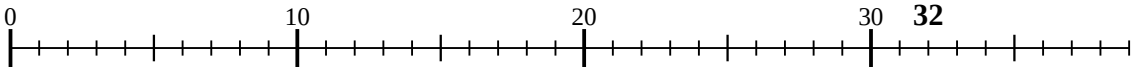

Respuestas

1. _____
2. _____
3. _____
4. _____
5. _____
6. _____
7. _____
8. _____
9. _____
10. _____
11. _____

1-10	91	82	73	64	55	45	36	27	18	9
11	0									

Dividiendo con una recta numérica

Nombre: **Clave De Respuestas**

Usa las rectas numéricas para resolver los problemas.

1) 36 ÷ 9 =

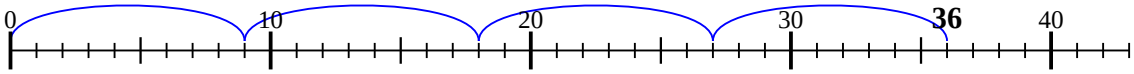

2) 8 ÷ 4 =

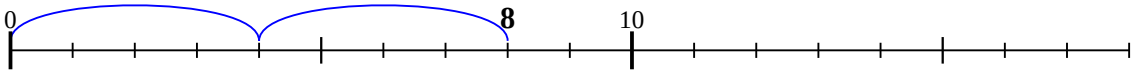

3) 21 ÷ 7 =

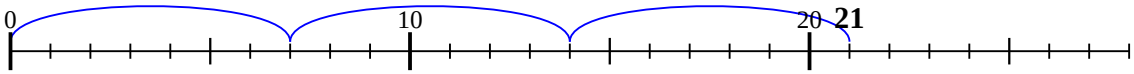

4) 12 ÷ 4 =

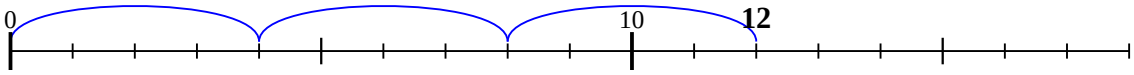

5) 20 ÷ 4 =

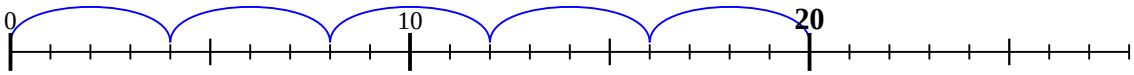

6) 28 ÷ 7 =

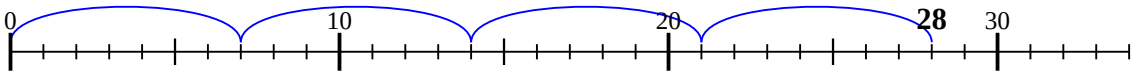

7) 40 ÷ 8 =

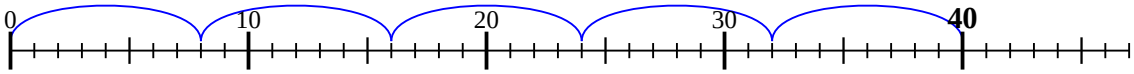

8) 16 ÷ 4 =

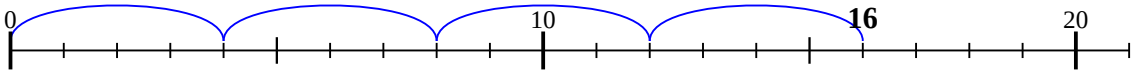

9) 15 ÷ 5 =

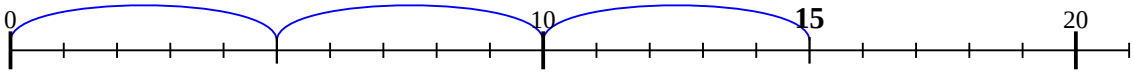

10) 4 ÷ 2 =



11) 32 ÷ 8 =

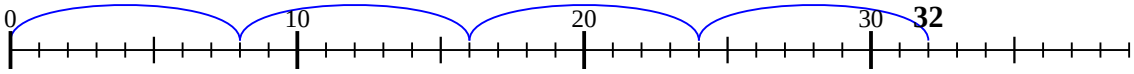

Respuestas

1. 4
2. 2
3. 3
4. 3
5. 5
6. 4
7. 5
8. 4
9. 3
10. 2
11. 4

1-10	91	82	73	64	55	45	36	27	18	9
11	0									