Dividiendo con una recta numérica

Nombre:

Usa las rectas numéricas para resolver los problemas.

1) 18 ÷ 9 =

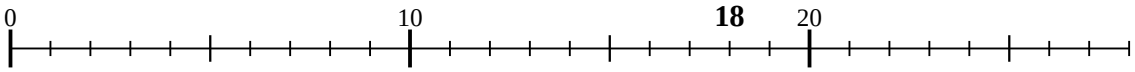

2) 36 ÷ 9 =

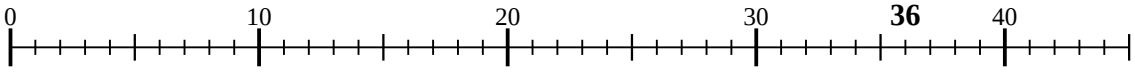

3) 9 ÷ 3 =

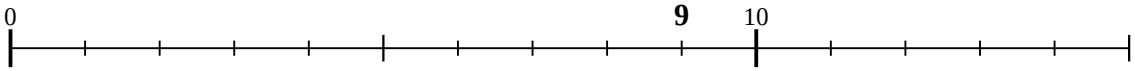

4) 10 ÷ 2 =

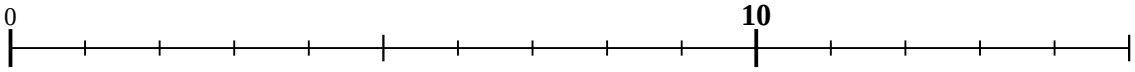

5) 4 ÷ 2 =



6) 35 ÷ 7 =

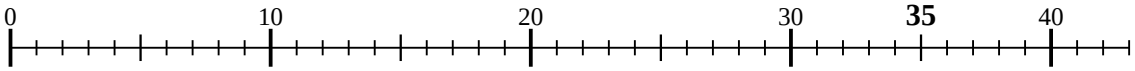

7) 16 ÷ 8 =

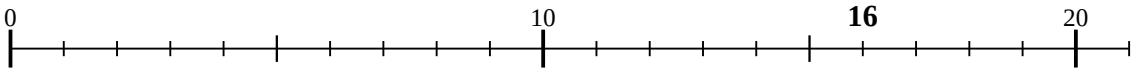

8) 24 ÷ 8 =

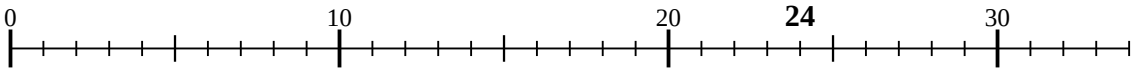

9) 21 ÷ 7 =

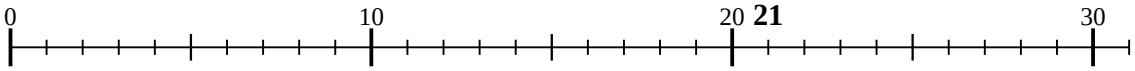

10) 32 ÷ 8 =

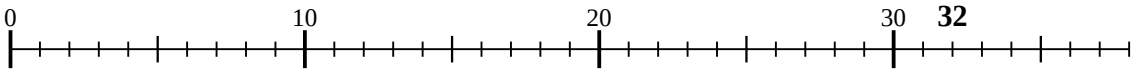

11) 50 ÷ 10 =

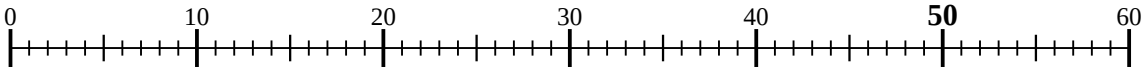

Respuestas

1. _____
2. _____
3. _____
4. _____
5. _____
6. _____
7. _____
8. _____
9. _____
10. _____
11. _____

1-10	91	82	73	64	55	45	36	27	18	9
11	0									

Dividiendo con una recta numérica

Nombre: **Clave De Respuestas**

Usa las rectas numéricas para resolver los problemas.

1) 18 ÷ 9 =

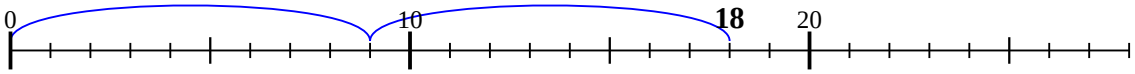

2) 36 ÷ 9 =

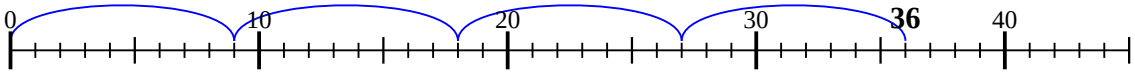

3) 9 ÷ 3 =

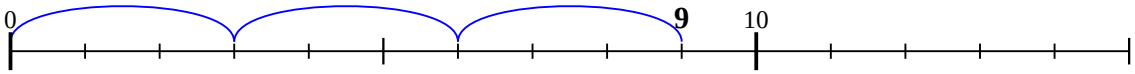

4) 10 ÷ 2 =

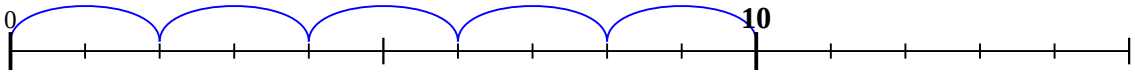

5) 4 ÷ 2 =



6) 35 ÷ 7 =

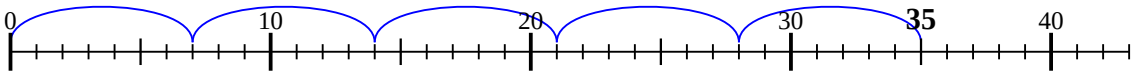

7) 16 ÷ 8 =

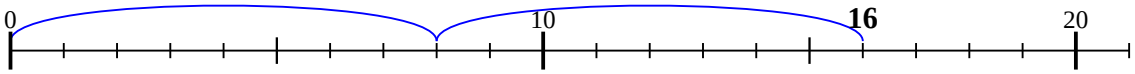

8) 24 ÷ 8 =

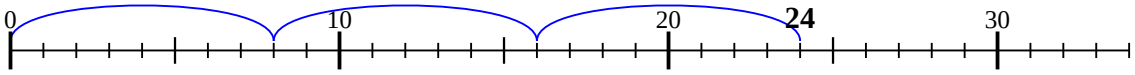

9) 21 ÷ 7 =

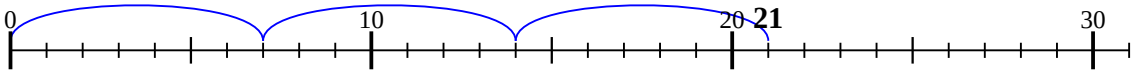

10) 32 ÷ 8 =

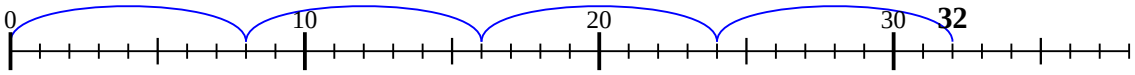

11) 50 ÷ 10 =

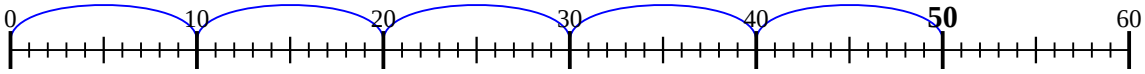

Respuestas

1. 2
2. 4
3. 3
4. 5
5. 2
6. 5
7. 2
8. 3
9. 3
10. 4
11. 5

1-10	91	82	73	64	55	45	36	27	18	9
11	0									