Dividiendo con una recta numérica

Nombre:

Usa las rectas numéricas para resolver los problemas.

1) 18 ÷ 6 =

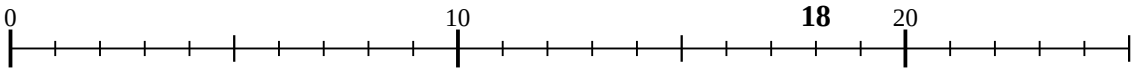

2) 6 ÷ 3 =

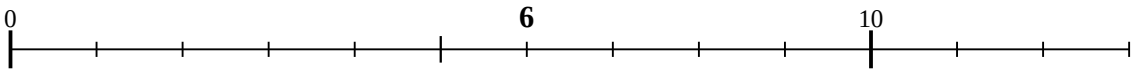

3) 14 ÷ 7 =

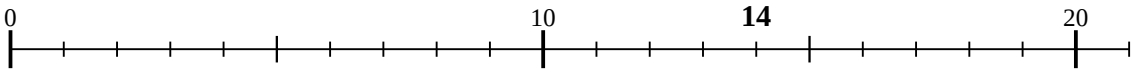

4) 10 ÷ 2 =

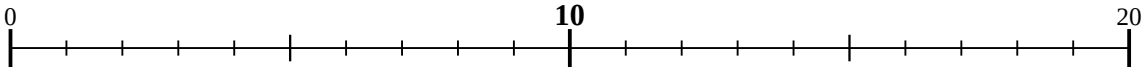

5) 8 ÷ 2 =



6) 24 ÷ 8 =

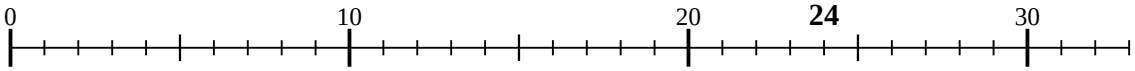

7) 40 ÷ 10 =

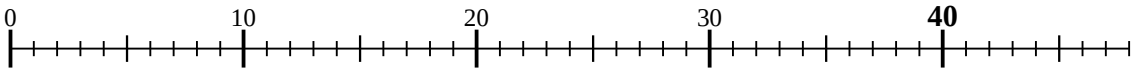

8) 20 ÷ 4 =

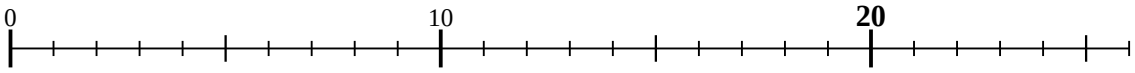

9) 4 ÷ 2 =

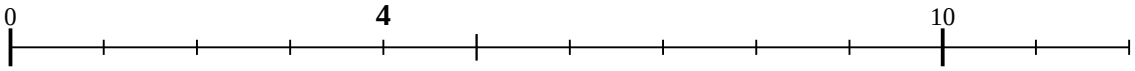

10) 21 ÷ 7 =

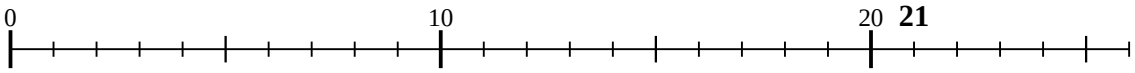

11) 6 ÷ 2 =

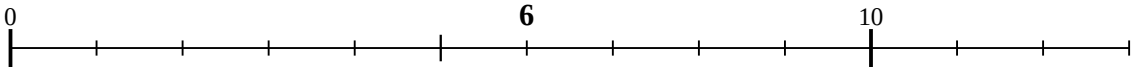

Respuestas

1. _____
2. _____
3. _____
4. _____
5. _____
6. _____
7. _____
8. _____
9. _____
10. _____
11. _____

1-10	91	82	73	64	55	45	36	27	18	9
11	0									

Dividiendo con una recta numérica

Nombre: **Clave De Respuestas**

Usa las rectas numéricas para resolver los problemas.

1) 18 ÷ 6 =

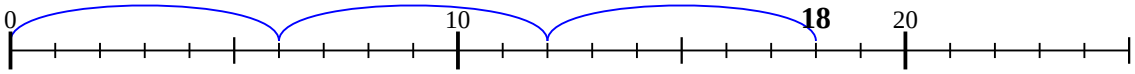

2) 6 ÷ 3 =

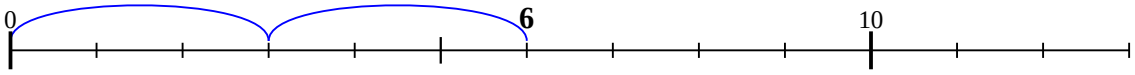

3) 14 ÷ 7 =

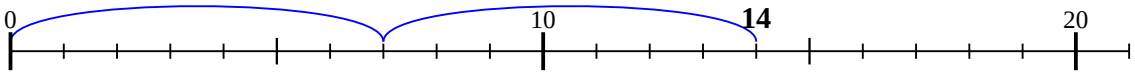

4) 10 ÷ 2 =

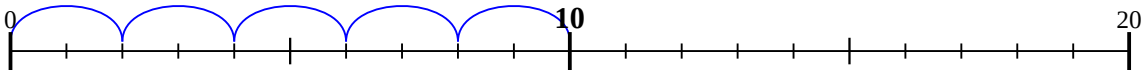

5) 8 ÷ 2 =

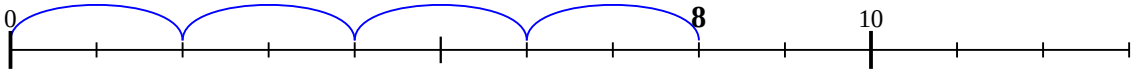

6) 24 ÷ 8 =

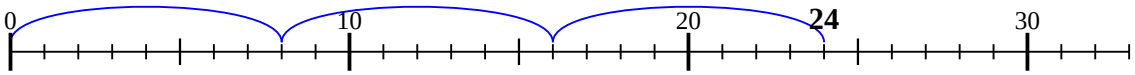

7) 40 ÷ 10 =

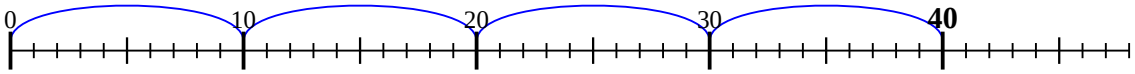

8) 20 ÷ 4 =

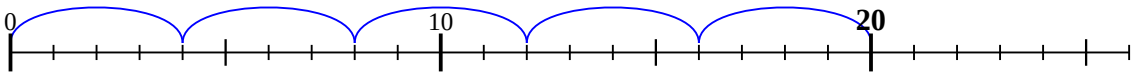

9) 4 ÷ 2 =

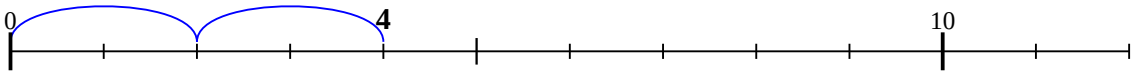

10) 21 ÷ 7 =

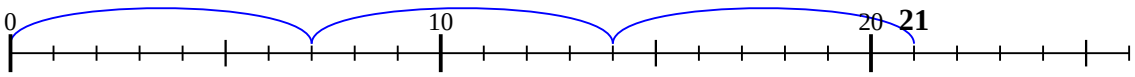

11) 6 ÷ 2 =

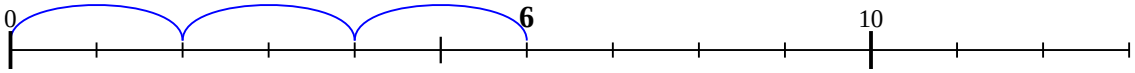

Respuestas

1. **3**
2. **2**
3. **2**
4. **5**
5. **4**
6. **3**
7. **4**
8. **5**
9. **2**
10. **3**
11. **3**

1-10	91	82	73	64	55	45	36	27	18	9
11	0									