Dividiendo con una recta numérica

Nombre:

Usa las rectas numéricas para resolver los problemas.

1) 12 ÷ 6 =

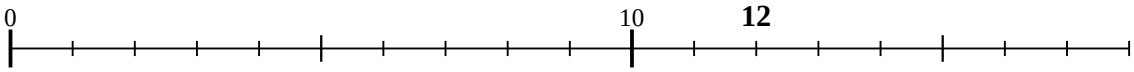

2) 50 ÷ 10 =

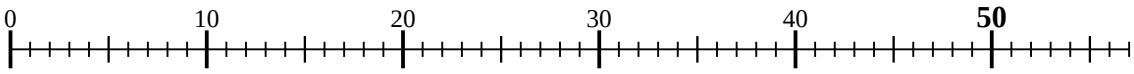

3) 35 ÷ 7 =

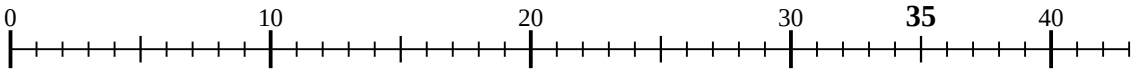

4) 6 ÷ 2 =

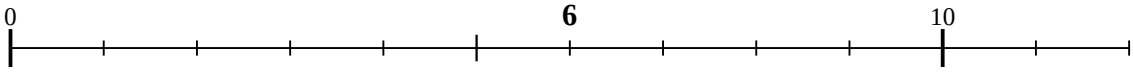

5) 40 ÷ 8 =

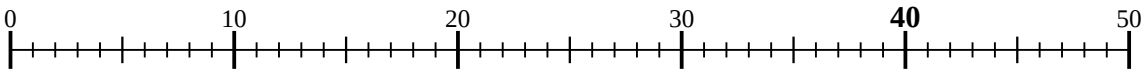

6) 24 ÷ 8 =

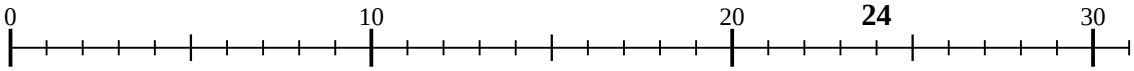

7) 36 ÷ 9 =

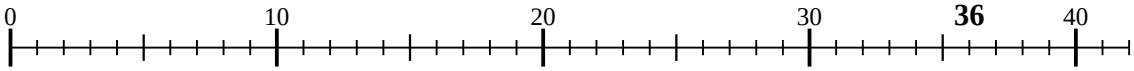

8) 45 ÷ 9 =

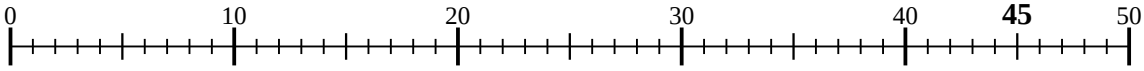

9) 28 ÷ 7 =

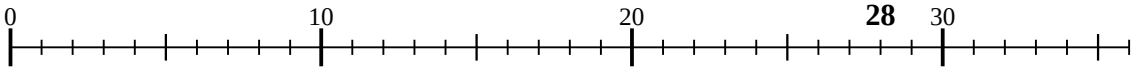

10) 12 ÷ 3 =

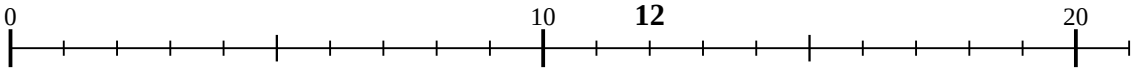

11) 32 ÷ 8 =

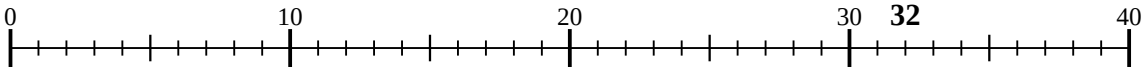

Respuestas

1. _____
2. _____
3. _____
4. _____
5. _____
6. _____
7. _____
8. _____
9. _____
10. _____
11. _____

1-10	91	82	73	64	55	45	36	27	18	9
11	0									

Dividiendo con una recta numérica

Nombre: **Clave De Respuestas**

Usa las rectas numéricas para resolver los problemas.

1) 12 ÷ 6 =

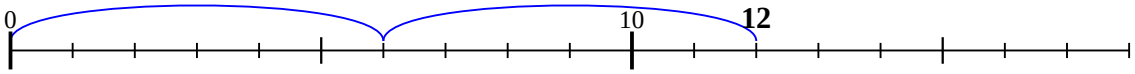

2) 50 ÷ 10 =

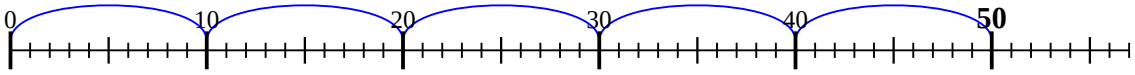

3) 35 ÷ 7 =

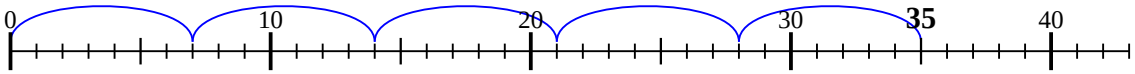

4) 6 ÷ 2 =

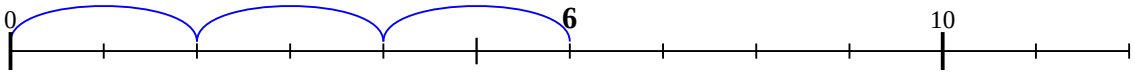

5) 40 ÷ 8 =

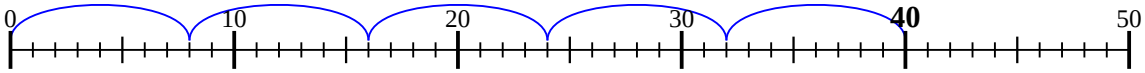

6) 24 ÷ 8 =

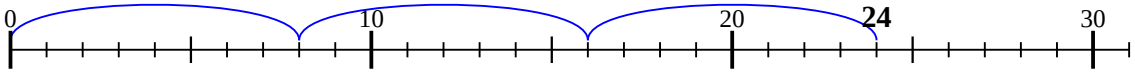

7) 36 ÷ 9 =

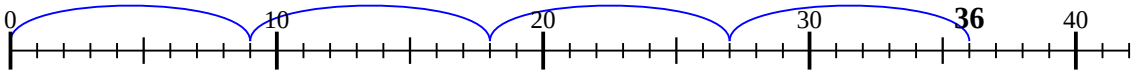

8) 45 ÷ 9 =

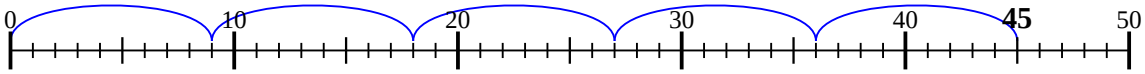

9) 28 ÷ 7 =

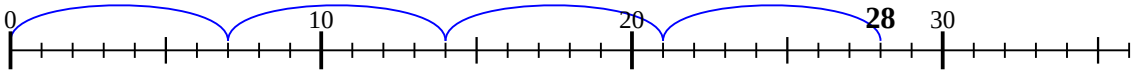

10) 12 ÷ 3 =

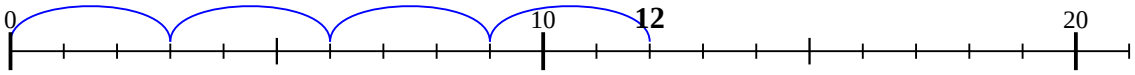

11) 32 ÷ 8 =

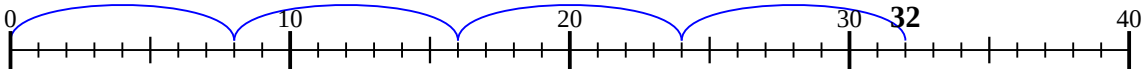

Respuestas

1. 2
2. 5
3. 5
4. 3
5. 5
6. 3
7. 4
8. 5
9. 4
10. 4
11. 4

1-10	91	82	73	64	55	45	36	27	18	9
11	0									