# Dividiendo con una recta numérica

Nombre:

**Usa las rectas numéricas para resolver los problemas.**

**1)** 20 ÷ 4 =

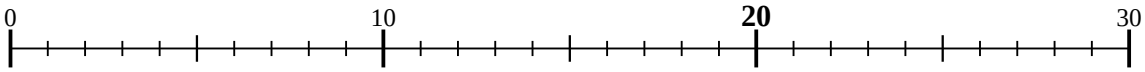


**2)** 40 ÷ 8 =

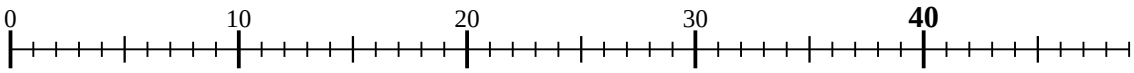


**3)** 28 ÷ 7 =

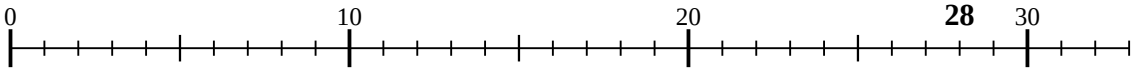


**4)** 20 ÷ 10 =

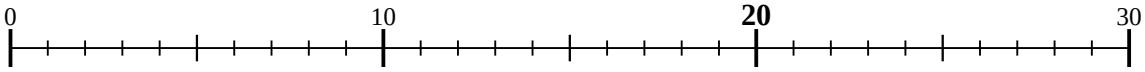


**5)** 36 ÷ 9 =

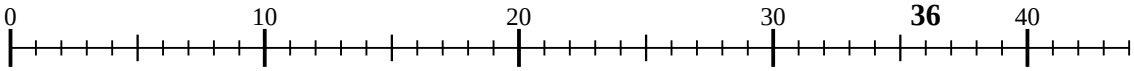


**6)** 32 ÷ 8 =

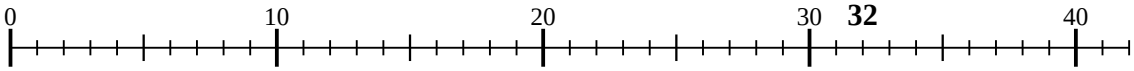


**7)** 16 ÷ 8 =

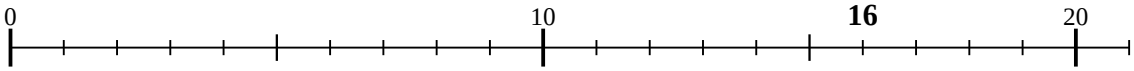


**8)** 18 ÷ 9 =

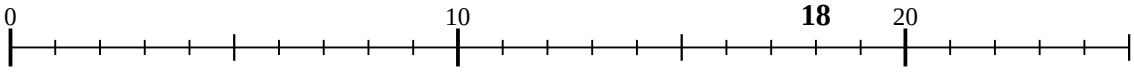


**9)** 21 ÷ 7 =

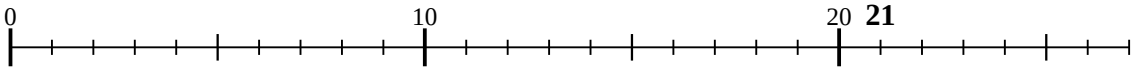


**10)** 12 ÷ 3 =

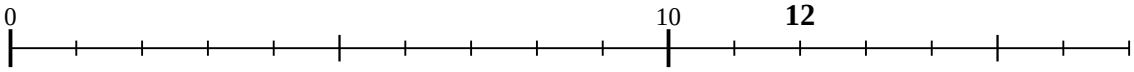


**11)** 25 ÷ 5 =

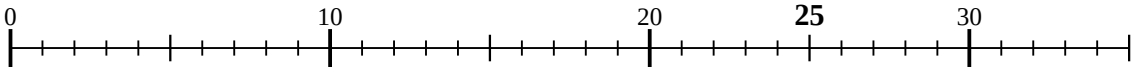


**Respuestas**

1. _____
2. _____
3. _____
4. _____
5. _____
6. _____
7. _____
8. _____
9. _____
10. _____
11. _____



| | | | | | | | | | | |
|---|---|---|---|---|---|---|---|---|---|---|
| 1-10 | 91 | 82 | 73 | 64 | 55 | 45 | 36 | 27 | 18 | 9 |
| 11 | 0 | | | | | | | | | |

Dividiendo con una recta numérica

Nombre: **Clave De Respuestas**

**Usa las rectas numéricas para resolver los problemas.**

**1)** 20 ÷ 4 =

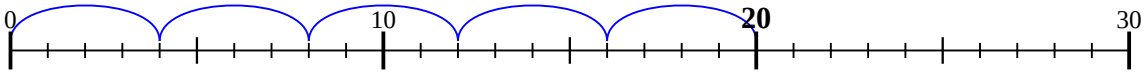


**2)** 40 ÷ 8 =

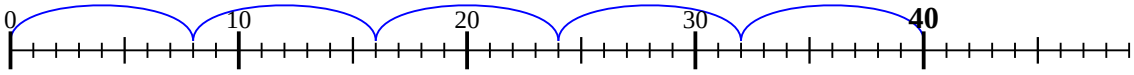


**3)** 28 ÷ 7 =

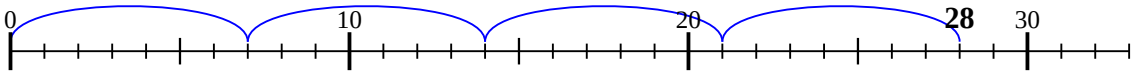


**4)** 20 ÷ 10 =

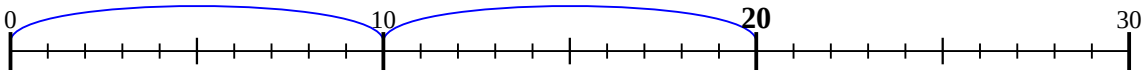


**5)** 36 ÷ 9 =

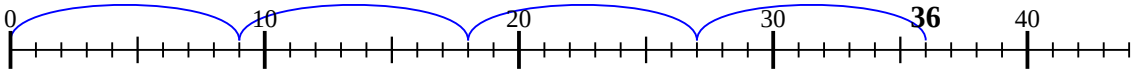


**6)** 32 ÷ 8 =

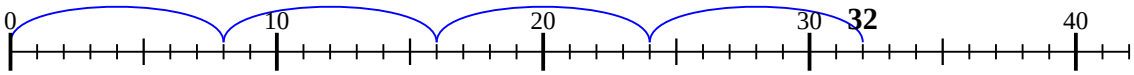


**7)** 16 ÷ 8 =

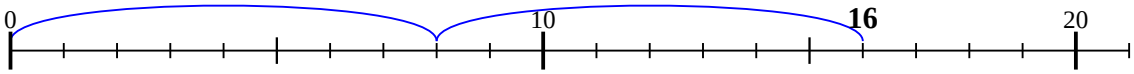


**8)** 18 ÷ 9 =

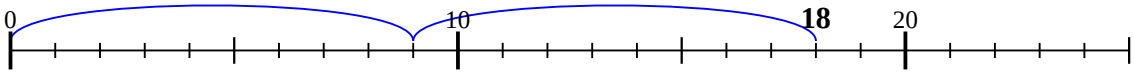


**9)** 21 ÷ 7 =

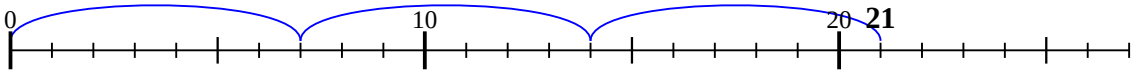


**10)** 12 ÷ 3 =

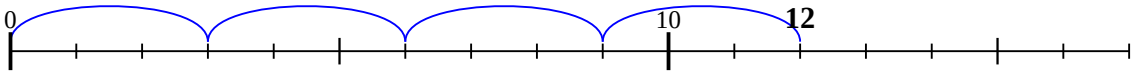


**11)** 25 ÷ 5 =

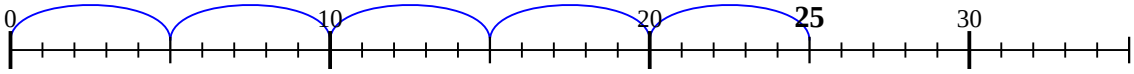


**Respuestas**

1. **5**
2. **5**
3. **4**
4. **2**
5. **4**
6. **4**
7. **2**
8. **2**
9. **3**
10. **4**
11. **5**



| | | | | | | | | | | |
|---|---|---|---|---|---|---|---|---|---|---|
| 1-10 | 91 | 82 | 73 | 64 | 55 | 45 | 36 | 27 | 18 | 9 |
| 11 | 0 | | | | | | | | | |