Dividiendo con una recta numérica

Nombre:

Usa las rectas numéricas para resolver los problemas.

1) 18 ÷ 9 =

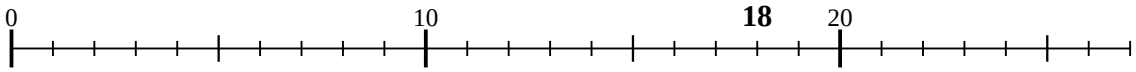

2) 4 ÷ 2 =



3) 35 ÷ 7 =

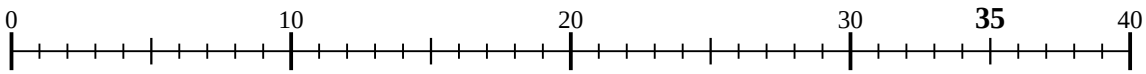

4) 25 ÷ 5 =

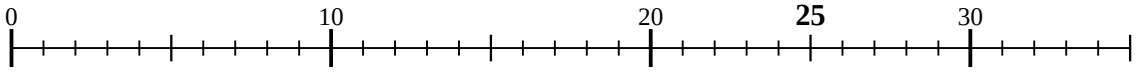

5) 6 ÷ 3 =

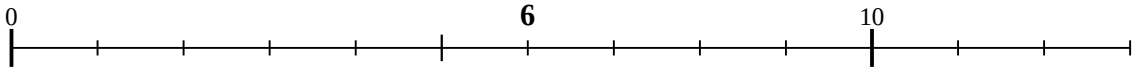

6) 30 ÷ 10 =

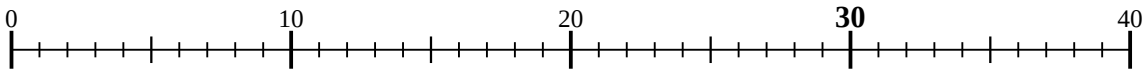

7) 40 ÷ 10 =

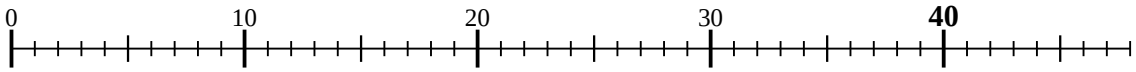

8) 10 ÷ 5 =

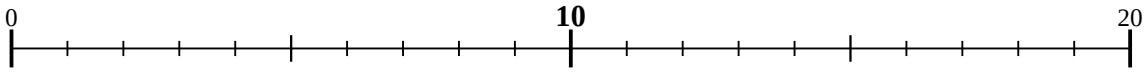

9) 8 ÷ 2 =

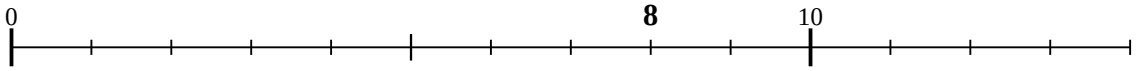

10) 36 ÷ 9 =

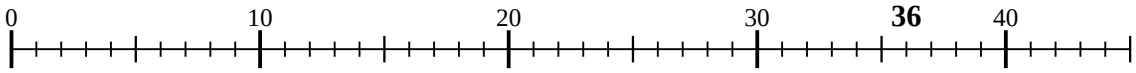

11) 10 ÷ 2 =

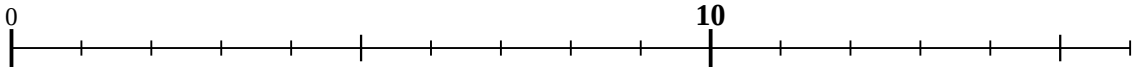

Respuestas

1. _____
2. _____
3. _____
4. _____
5. _____
6. _____
7. _____
8. _____
9. _____
10. _____
11. _____

1-10	91	82	73	64	55	45	36	27	18	9
11	0									

Usa las rectas numéricas para resolver los problemas.

1) 18 ÷ 9 =

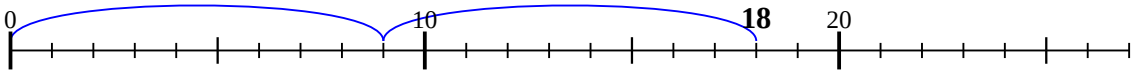

2) 4 ÷ 2 =

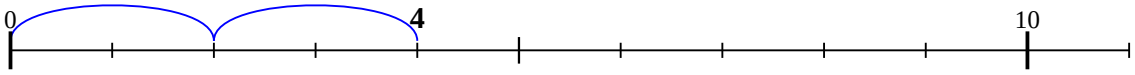

3) 35 ÷ 7 =

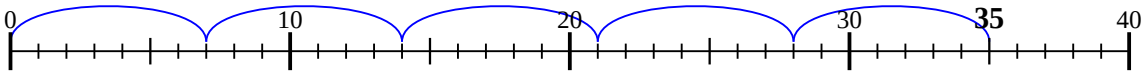

4) 25 ÷ 5 =

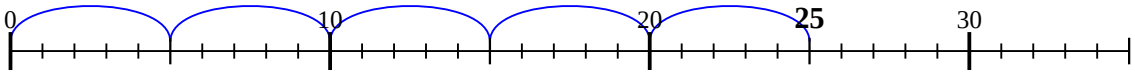

5) 6 ÷ 3 =



6) 30 ÷ 10 =

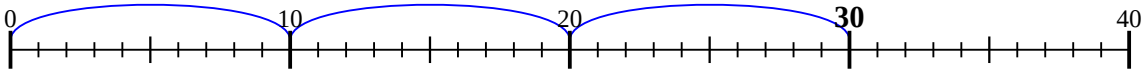

7) 40 ÷ 10 =

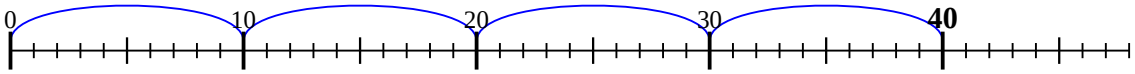

8) 10 ÷ 5 =

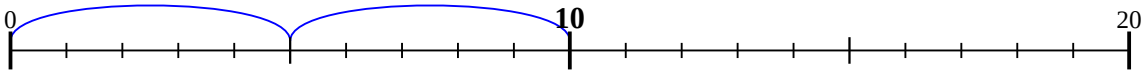

9) 8 ÷ 2 =

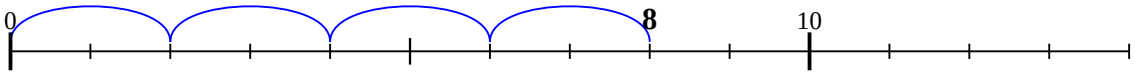

10) 36 ÷ 9 =

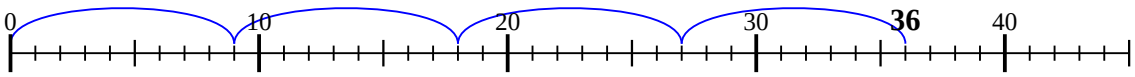

11) 10 ÷ 2 =

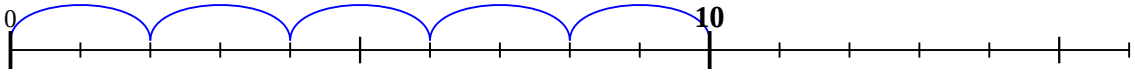

Respuestas

1. 2
2. 2
3. 5
4. 5
5. 2
6. 3
7. 4
8. 2
9. 4
10. 4
11. 5

1-10	91	82	73	64	55	45	36	27	18	9
11	0									