Dividiendo con una recta numérica

Nombre:

Usa las rectas numéricas para resolver los problemas.

1) 4 ÷ 2 =

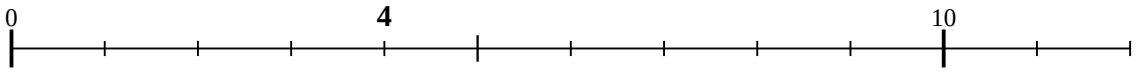

2) 18 ÷ 9 =

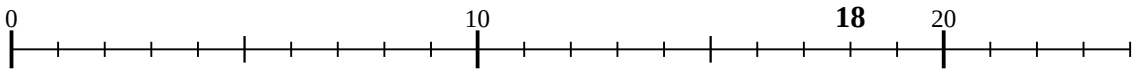

3) 12 ÷ 6 =

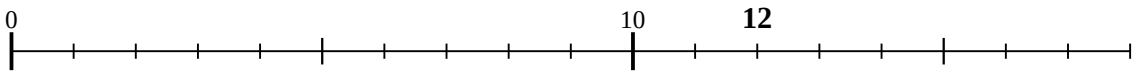

4) 28 ÷ 7 =

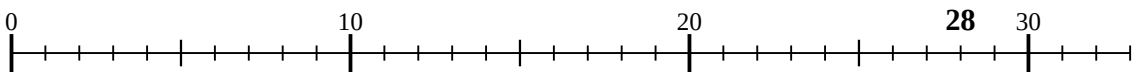

5) 10 ÷ 2 =

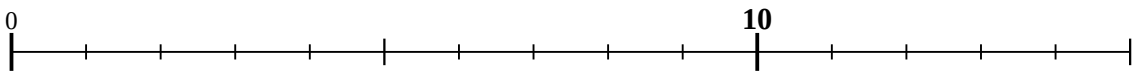

6) 16 ÷ 8 =

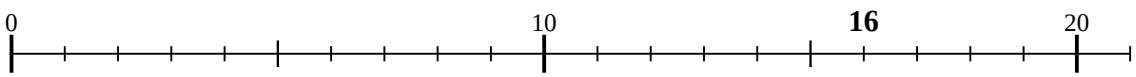

7) 35 ÷ 7 =

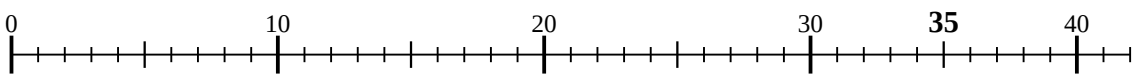

8) 8 ÷ 2 =

9) 40 ÷ 10 =

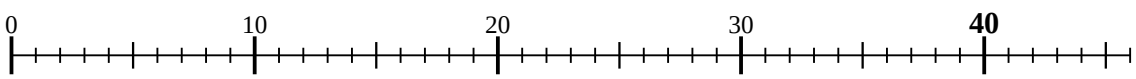

10) 30 ÷ 6 =

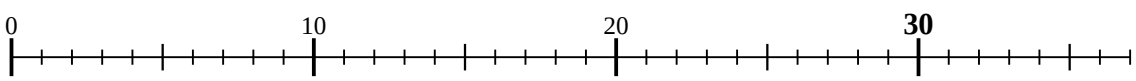

11) 30 ÷ 10 =

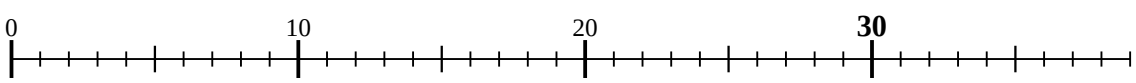

Respuestas

1. _____
2. _____
3. _____
4. _____
5. _____
6. _____
7. _____
8. _____
9. _____
10. _____
11. _____

1-10	91	82	73	64	55	45	36	27	18	9
11	0									

Dividiendo con una recta numérica

Nombre: **Clave De Respuestas**

Usa las rectas numéricas para resolver los problemas.

1) 4 ÷ 2 =

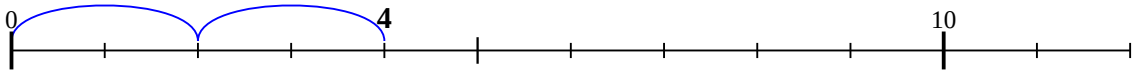

2) 18 ÷ 9 =

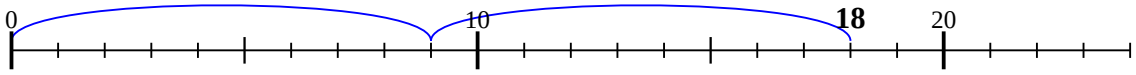

3) 12 ÷ 6 =

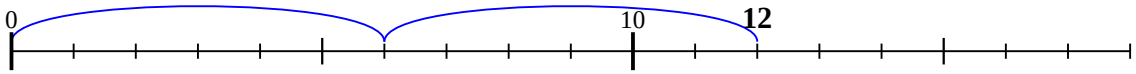

4) 28 ÷ 7 =

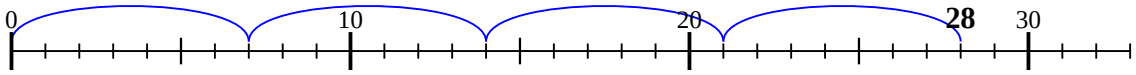

5) 10 ÷ 2 =

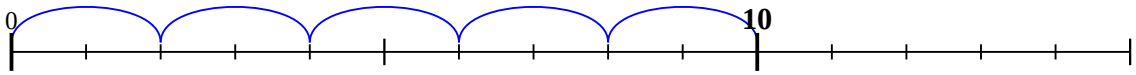

6) 16 ÷ 8 =

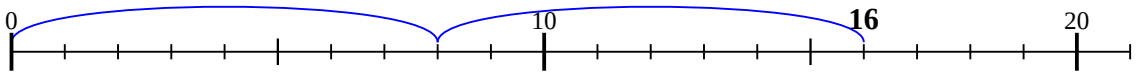

7) 35 ÷ 7 =

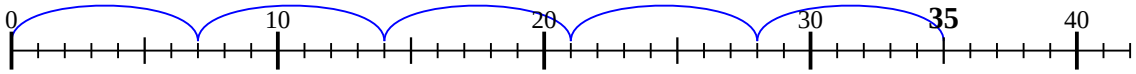

8) 8 ÷ 2 =

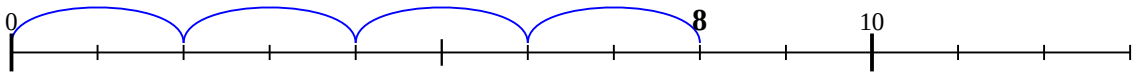

9) 40 ÷ 10 =

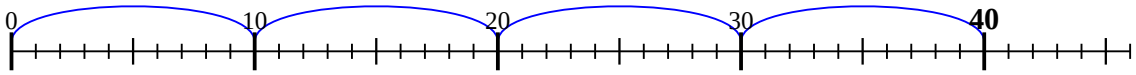

10) 30 ÷ 6 =

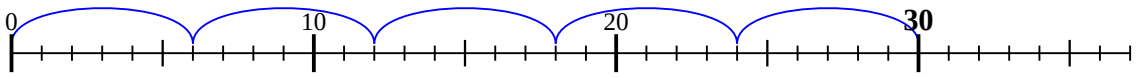

11) 30 ÷ 10 =

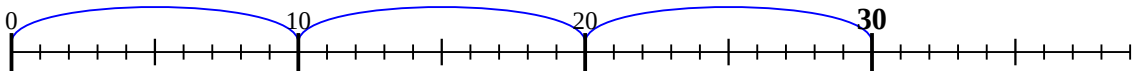

Respuestas

1. 2
2. 2
3. 2
4. 4
5. 5
6. 2
7. 5
8. 4
9. 4
10. 5
11. 3

1-10	91	82	73	64	55	45	36	27	18	9
11	0									