Dividiendo con una recta numérica

Nombre:

Usa las rectas numéricas para resolver los problemas.

1) 4 ÷ 2 =



2) 50 ÷ 10 =

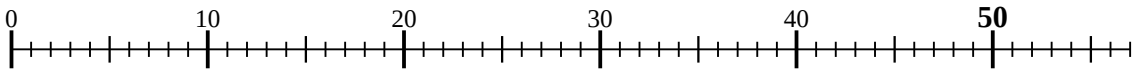

3) 9 ÷ 3 =

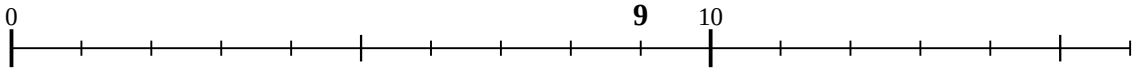

4) 18 ÷ 6 =

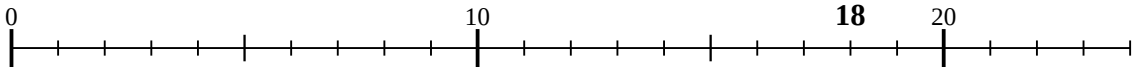

5) 20 ÷ 5 =

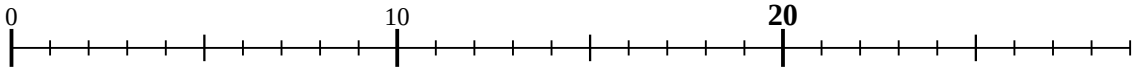

6) 15 ÷ 3 =

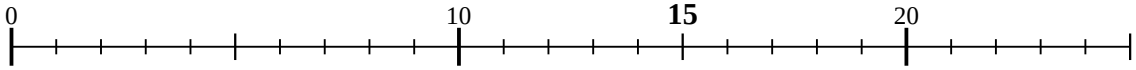

7) 21 ÷ 7 =

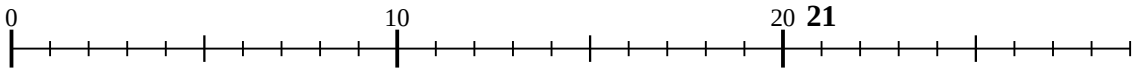

8) 28 ÷ 7 =

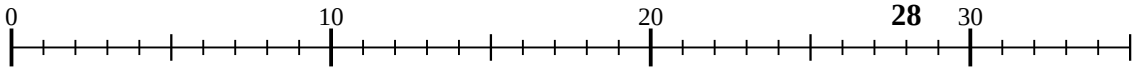

9) 24 ÷ 8 =

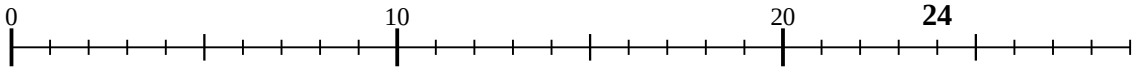

10) 6 ÷ 2 =

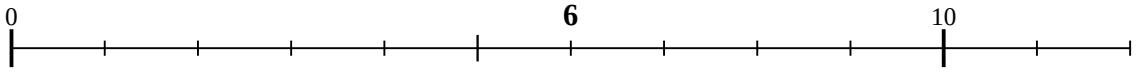

11) 8 ÷ 4 =

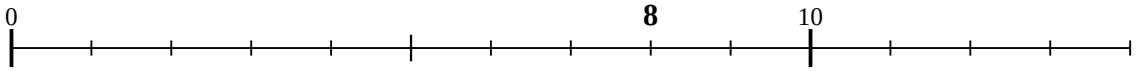

Respuestas

1. _____
2. _____
3. _____
4. _____
5. _____
6. _____
7. _____
8. _____
9. _____
10. _____
11. _____

1-10	91	82	73	64	55	45	36	27	18	9
11	0									

Dividiendo con una recta numérica

Nombre: **Clave De Respuestas**

Usa las rectas numéricas para resolver los problemas.

1) 4 ÷ 2 =



2) 50 ÷ 10 =

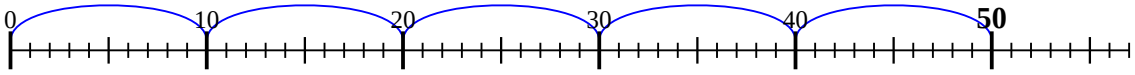

3) 9 ÷ 3 =

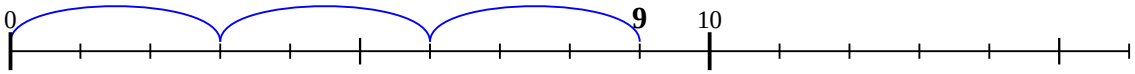

4) 18 ÷ 6 =

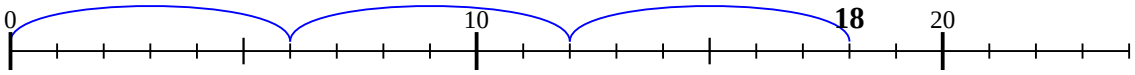

5) 20 ÷ 5 =

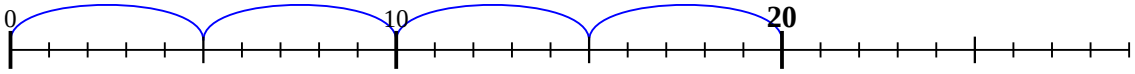

6) 15 ÷ 3 =

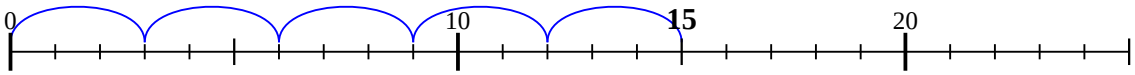

7) 21 ÷ 7 =

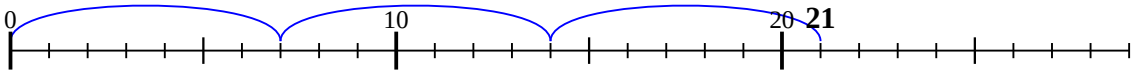

8) 28 ÷ 7 =

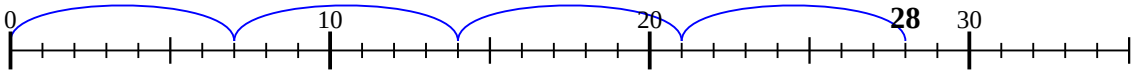

9) 24 ÷ 8 =

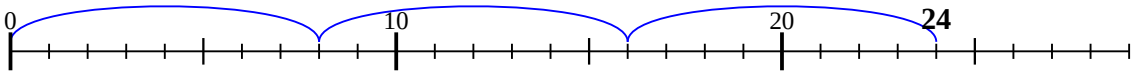

10) 6 ÷ 2 =

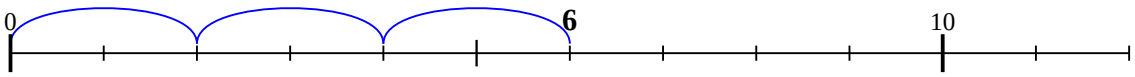

11) 8 ÷ 4 =

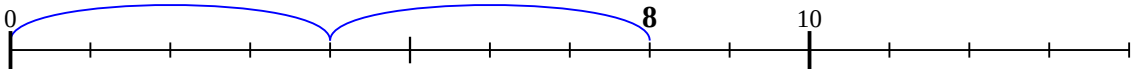

Respuestas

1. **2**
2. **5**
3. **3**
4. **3**
5. **4**
6. **5**
7. **3**
8. **4**
9. **3**
10. **3**
11. **2**

1-10	91	82	73	64	55	45	36	27	18	9
11	0									