Dividiendo con una recta numérica

Nombre:

Usa las rectas numéricas para resolver los problemas.

1) 20 ÷ 5 =

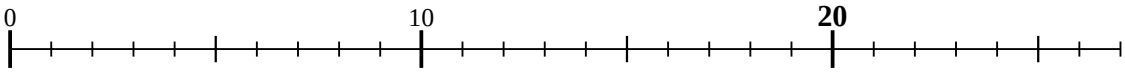

2) 25 ÷ 5 =

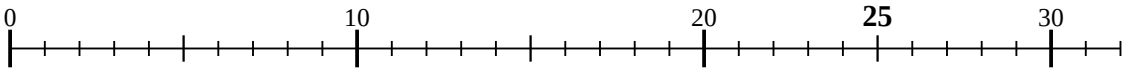

3) 16 ÷ 4 =

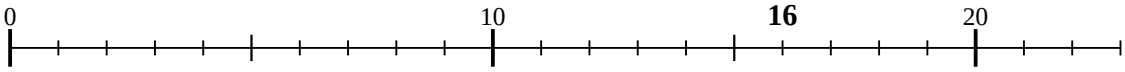

4) 6 ÷ 3 =

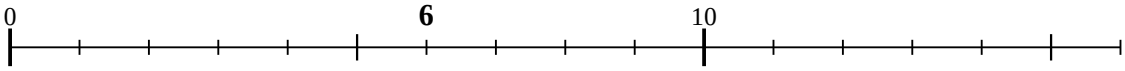

5) 32 ÷ 8 =

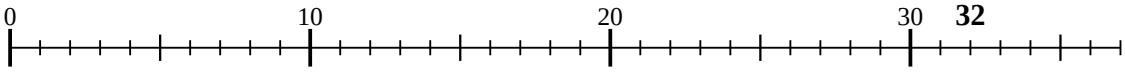

6) 24 ÷ 8 =

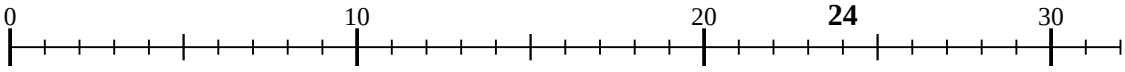

7) 10 ÷ 2 =

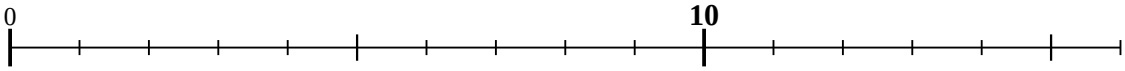

8) 20 ÷ 10 =

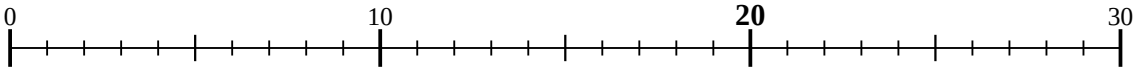

9) 6 ÷ 2 =

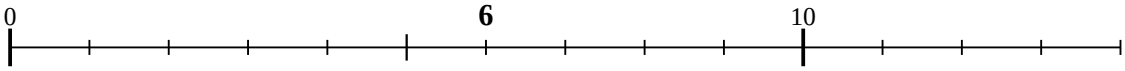

10) 35 ÷ 7 =

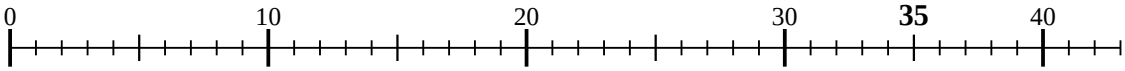

11) 36 ÷ 9 =

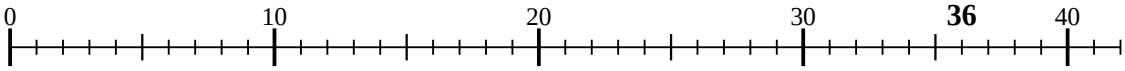

Respuestas

1. _____
2. _____
3. _____
4. _____
5. _____
6. _____
7. _____
8. _____
9. _____
10. _____
11. _____

Dividiendo con una recta numérica

Nombre: **Clave De Respuestas**

Usa las rectas numéricas para resolver los problemas.

1) 20 ÷ 5 =

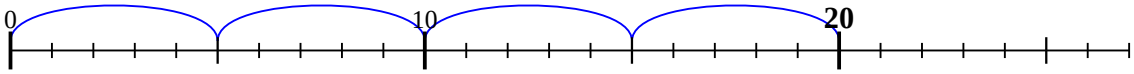

2) 25 ÷ 5 =

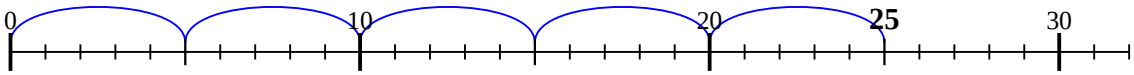

3) 16 ÷ 4 =

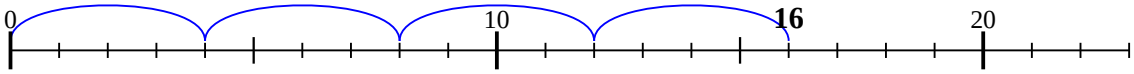

4) 6 ÷ 3 =

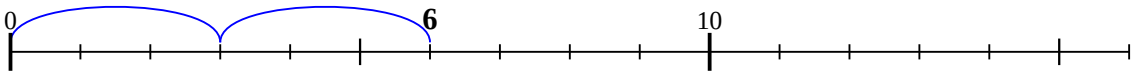

5) 32 ÷ 8 =

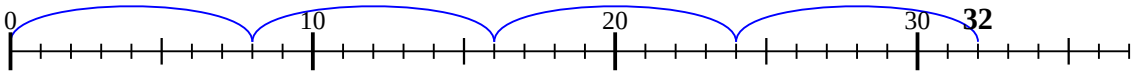

6) 24 ÷ 8 =

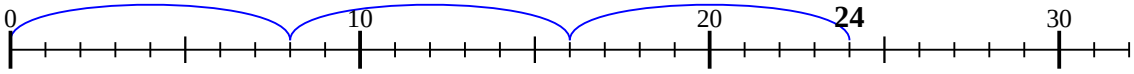

7) 10 ÷ 2 =

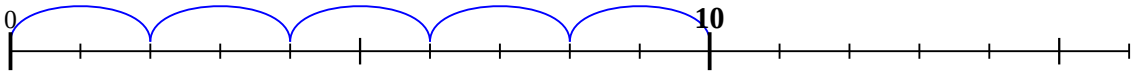

8) 20 ÷ 10 =

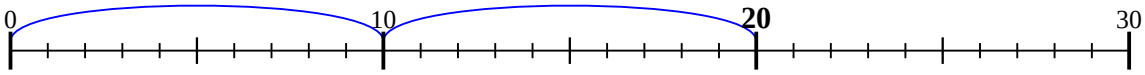

9) 6 ÷ 2 =

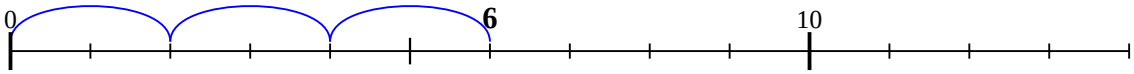

10) 35 ÷ 7 =

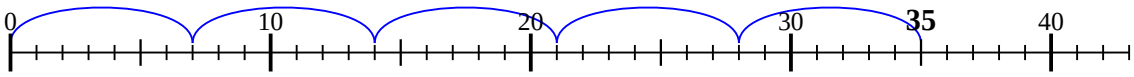

11) 36 ÷ 9 =

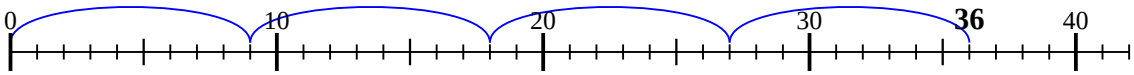

Respuestas

1. **4**
2. **5**
3. **4**
4. **2**
5. **4**
6. **3**
7. **5**
8. **2**
9. **3**
10. **5**
11. **4**