Dividiendo con una recta numérica

Nombre:

Usa las rectas numéricas para resolver los problemas.

1) 10 ÷ 2 =

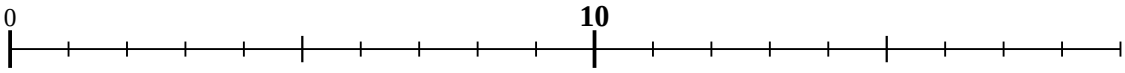

2) 25 ÷ 5 =

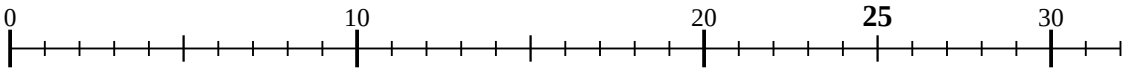

3) 20 ÷ 5 =

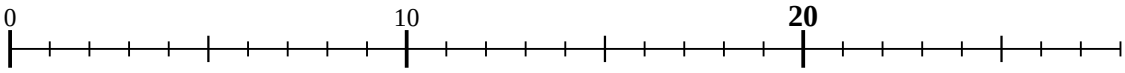

4) 40 ÷ 10 =

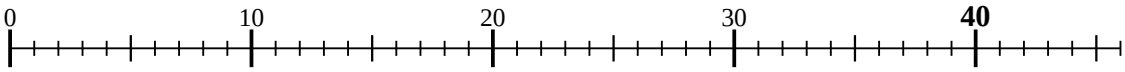

5) 8 ÷ 4 =

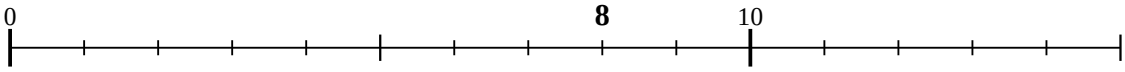

6) 12 ÷ 6 =

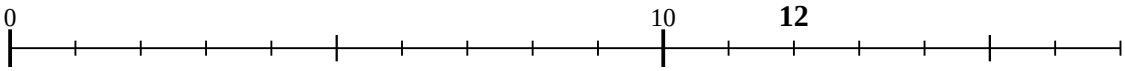

7) 15 ÷ 5 =

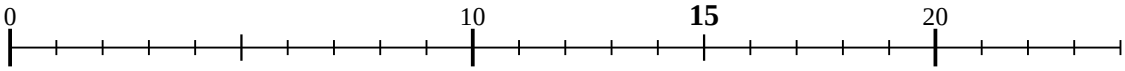

8) 20 ÷ 10 =

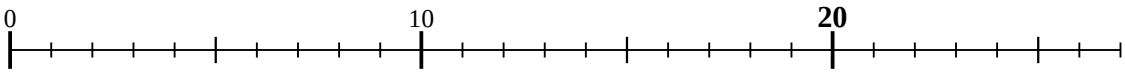

9) 24 ÷ 6 =

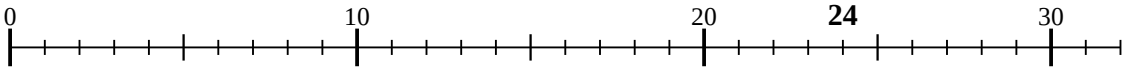

10) 6 ÷ 3 =



11) 18 ÷ 6 =

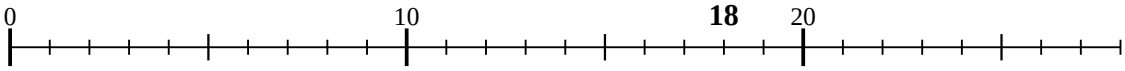

Respuestas

1. _____
2. _____
3. _____
4. _____
5. _____
6. _____
7. _____
8. _____
9. _____
10. _____
11. _____

Dividiendo con una recta numérica

Nombre: **Clave De Respuestas**

Usa las rectas numéricas para resolver los problemas.

1) 10 ÷ 2 =

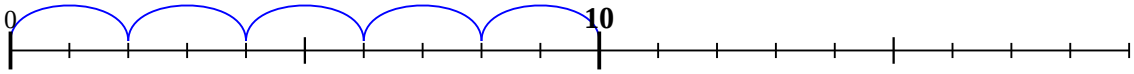

2) 25 ÷ 5 =

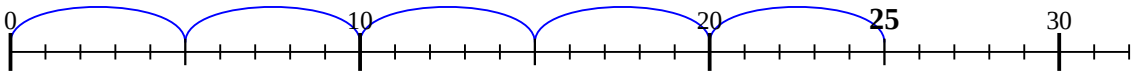

3) 20 ÷ 5 =

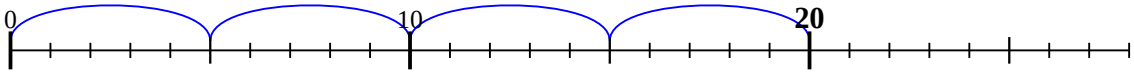

4) 40 ÷ 10 =

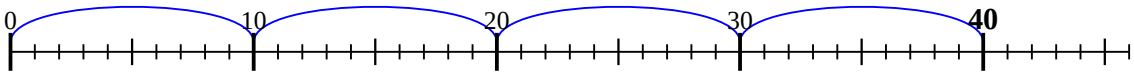

5) 8 ÷ 4 =

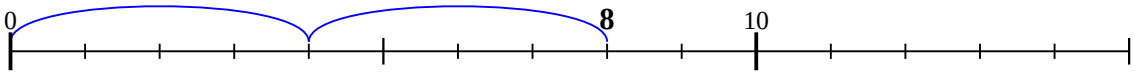

6) 12 ÷ 6 =

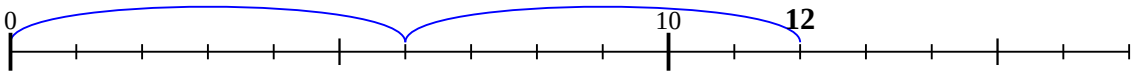

7) 15 ÷ 5 =

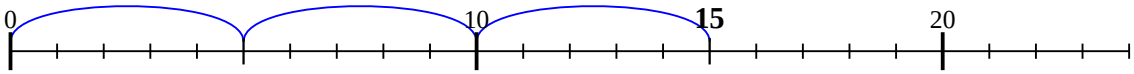

8) 20 ÷ 10 =

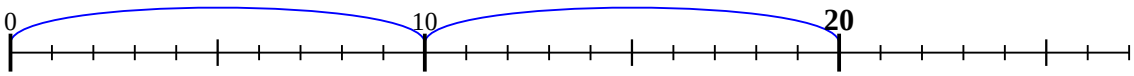

9) 24 ÷ 6 =

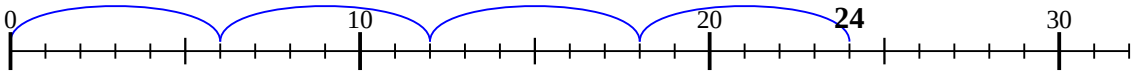

10) 6 ÷ 3 =



11) 18 ÷ 6 =

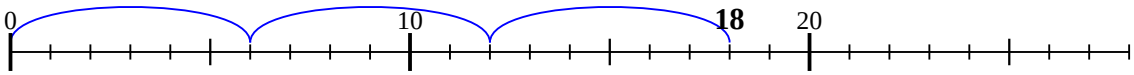

Respuestas

1. **5**
2. **5**
3. **4**
4. **4**
5. **2**
6. **2**
7. **3**
8. **2**
9. **4**
10. **2**
11. **3**