Multiplicando Fracciones (visualmente)

Nombre:

Usa la caja para mostrar un ejemplo visual de cómo multiplicar dos fracciones.

Ej) $\frac{2}{7} \times \frac{1}{2} =$

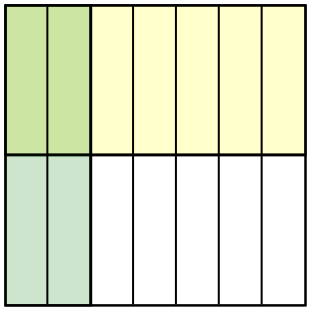

1) $\frac{1}{3} \times \frac{4}{9} =$

2) $\frac{3}{9} \times \frac{1}{4} =$

3) $\frac{2}{6} \times \frac{2}{6} =$

4) $\frac{4}{7} \times \frac{7}{9} =$

5) $\frac{3}{8} \times \frac{5}{9} =$

6) $\frac{5}{6} \times \frac{4}{7} =$

7) $\frac{2}{7} \times \frac{6}{8} =$

8) $\frac{4}{5} \times \frac{2}{5} =$

9) $\frac{7}{8} \times \frac{1}{2} =$

10) $\frac{1}{2} \times \frac{5}{8} =$

11) $\frac{1}{2} \times \frac{2}{3} =$

Respuestas

Ej. $\frac{2}{14}$

1. _____
2. _____
3. _____
4. _____
5. _____
6. _____
7. _____
8. _____
9. _____
10. _____
11. _____

1-10	91	82	73	64	55	45	36	27	18	9
11	0									

Multiplicando Fracciones (visualmente) Nombre: **Clave De Respuestas**

Usa la caja para mostrar un ejemplo visual de cómo multiplicar dos fracciones.

Ej) $\frac{2}{7} \times \frac{1}{2} =$

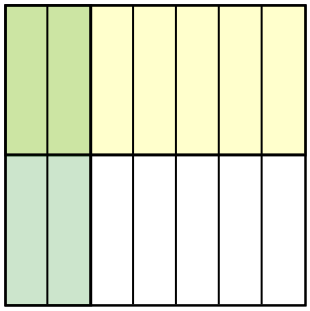

1) $\frac{1}{3} \times \frac{4}{9} =$

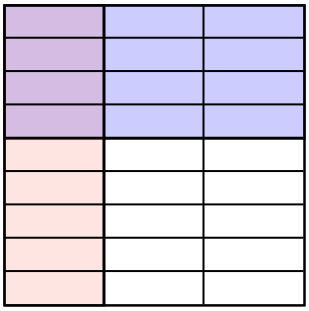

2) $\frac{3}{9} \times \frac{1}{4} =$

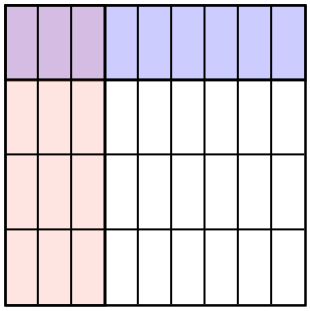

3) $\frac{2}{6} \times \frac{2}{6} =$

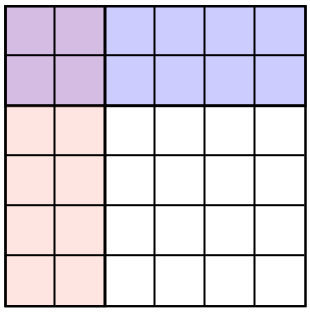

4) $\frac{4}{7} \times \frac{7}{9} =$

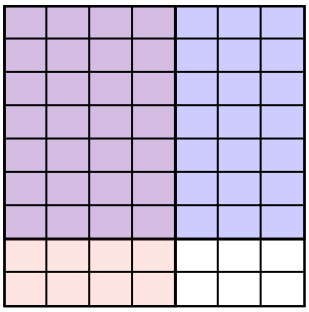

5) $\frac{3}{8} \times \frac{5}{9} =$

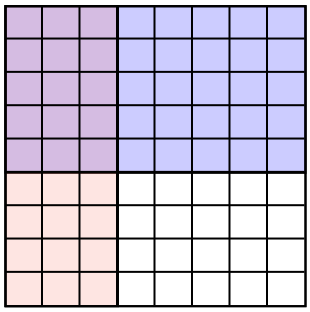

6) $\frac{5}{6} \times \frac{4}{7} =$

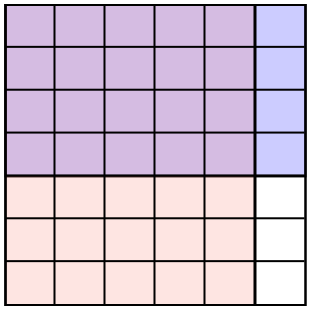

7) $\frac{2}{7} \times \frac{6}{8} =$

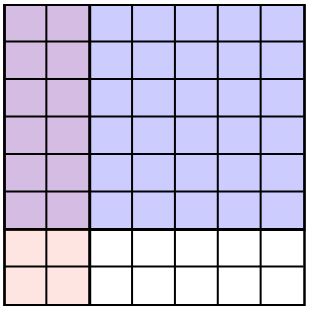

8) $\frac{4}{5} \times \frac{2}{5} =$

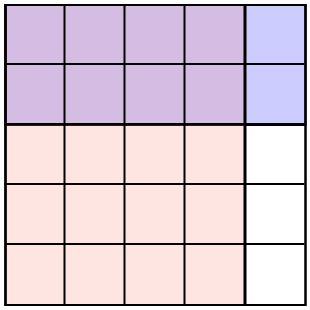

9) $\frac{7}{8} \times \frac{1}{2} =$

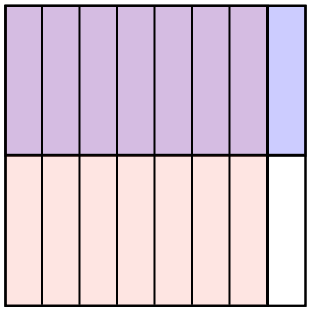

10) $\frac{1}{2} \times \frac{5}{8} =$

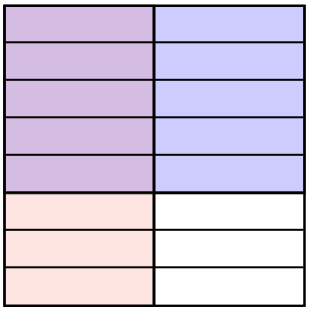

11) $\frac{1}{2} \times \frac{2}{3} =$



Respuestas

Ej. $\frac{2}{14}$

1. $\frac{4}{27}$
2. $\frac{3}{36}$
3. $\frac{4}{36}$
4. $\frac{28}{63}$
5. $\frac{15}{72}$
6. $\frac{20}{42}$
7. $\frac{12}{56}$
8. $\frac{8}{25}$
9. $\frac{7}{16}$
10. $\frac{5}{16}$
11. $\frac{2}{6}$

1-10	91	82	73	64	55	45	36	27	18	9
11	0									