Multiplicando Fracciones (visualmente) Nombre:

Usa la caja para mostrar un ejemplo visual de cómo multiplicar dos fracciones.

Ej) $\frac{6}{7} \times \frac{1}{9} =$

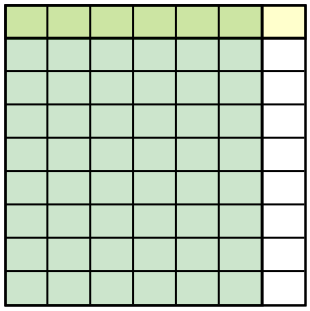

1) $\frac{3}{9} \times \frac{1}{3} =$

2) $\frac{4}{5} \times \frac{3}{4} =$

3) $\frac{4}{7} \times \frac{4}{8} =$

4) $\frac{3}{4} \times \frac{1}{8} =$

5) $\frac{1}{2} \times \frac{5}{9} =$

6) $\frac{1}{3} \times \frac{1}{3} =$

7) $\frac{2}{7} \times \frac{2}{4} =$

8) $\frac{5}{8} \times \frac{3}{4} =$

9) $\frac{2}{4} \times \frac{1}{7} =$

10) $\frac{7}{8} \times \frac{1}{7} =$

11) $\frac{5}{9} \times \frac{7}{9} =$

Respuestas

Ej. $\frac{6}{63}$

1. _____
2. _____
3. _____
4. _____
5. _____
6. _____
7. _____
8. _____
9. _____
10. _____
11. _____

1-10	91	82	73	64	55	45	36	27	18	9
11	0									

Usa la caja para mostrar un ejemplo visual de cómo multiplicar dos fracciones.

Ej) $\frac{6}{7} \times \frac{1}{9} =$

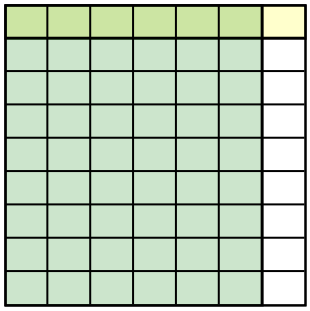

1) $\frac{3}{9} \times \frac{1}{3} =$

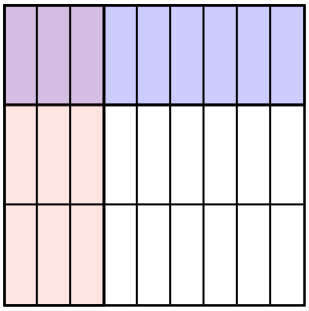

2) $\frac{4}{5} \times \frac{3}{4} =$

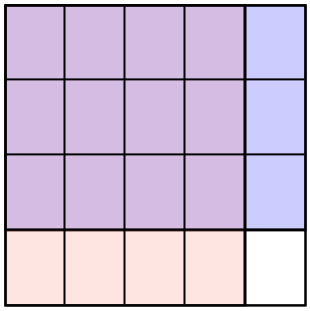

3) $\frac{4}{7} \times \frac{4}{8} =$

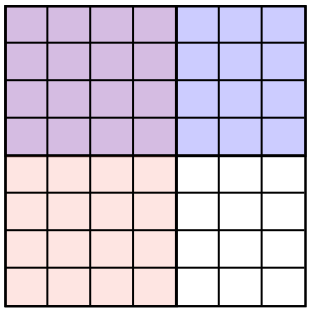

4) $\frac{3}{4} \times \frac{1}{8} =$

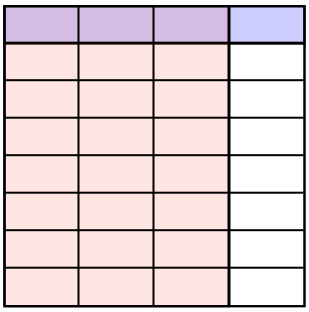

5) $\frac{1}{2} \times \frac{5}{9} =$

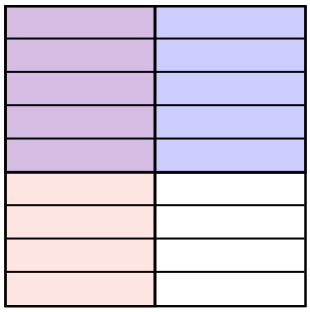

6) $\frac{1}{3} \times \frac{1}{3} =$



7) $\frac{2}{7} \times \frac{2}{4} =$

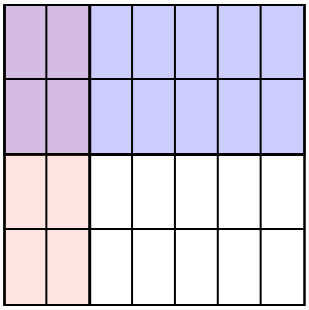

8) $\frac{5}{8} \times \frac{3}{4} =$

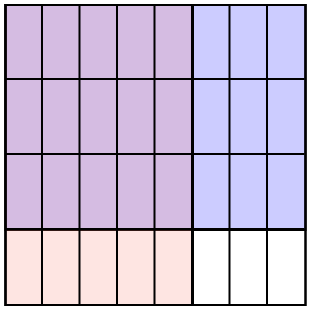

9) $\frac{2}{4} \times \frac{1}{7} =$



10) $\frac{7}{8} \times \frac{1}{7} =$

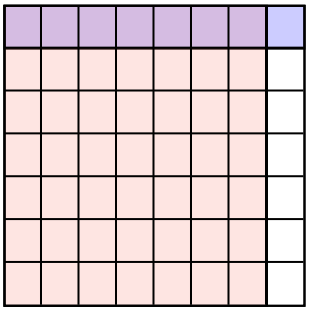

11) $\frac{5}{9} \times \frac{7}{9} =$

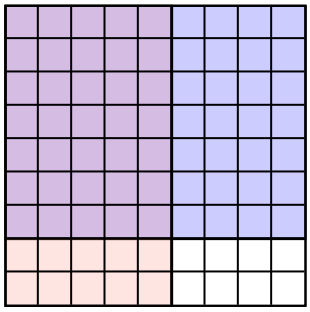

Respuestas

Ej. $\frac{6}{63}$

1. $\frac{3}{27}$
2. $\frac{12}{20}$
3. $\frac{16}{56}$
4. $\frac{3}{32}$
5. $\frac{5}{18}$
6. $\frac{1}{9}$
7. $\frac{4}{28}$
8. $\frac{15}{32}$
9. $\frac{2}{28}$
10. $\frac{7}{56}$
11. $\frac{35}{81}$

1-10	91	82	73	64	55	45	36	27	18	9
11	0									