Multiplicando Fracciones (visualmente)

Nombre:

Usa la caja para mostrar un ejemplo visual de cómo multiplicar dos fracciones.

Ej) $\frac{1}{5} \times \frac{1}{2} =$

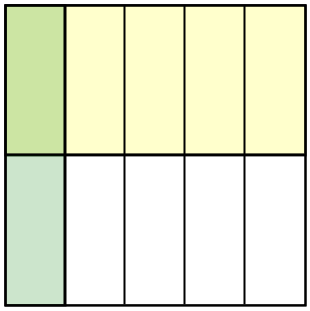

1) $\frac{4}{5} \times \frac{1}{3} =$

2) $\frac{1}{5} \times \frac{1}{5} =$

3) $\frac{3}{4} \times \frac{4}{6} =$

4) $\frac{1}{5} \times \frac{2}{7} =$

5) $\frac{1}{6} \times \frac{1}{4} =$

6) $\frac{1}{2} \times \frac{5}{6} =$

7) $\frac{8}{9} \times \frac{1}{2} =$

8) $\frac{1}{4} \times \frac{1}{9} =$

9) $\frac{1}{2} \times \frac{3}{7} =$

10) $\frac{4}{6} \times \frac{2}{5} =$

11) $\frac{4}{8} \times \frac{4}{7} =$

Respuestas

Ej. $\frac{1}{10}$

1. _____
2. _____
3. _____
4. _____
5. _____
6. _____
7. _____
8. _____
9. _____
10. _____
11. _____

1-10	91	82	73	64	55	45	36	27	18	9
11	0									

Usa la caja para mostrar un ejemplo visual de cómo multiplicar dos fracciones.

Ej) $\frac{1}{5} \times \frac{1}{2} =$

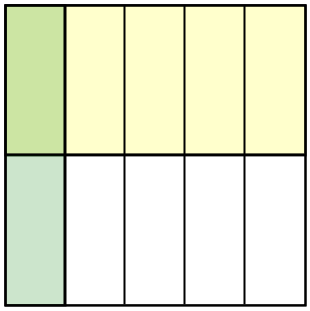

1) $\frac{4}{5} \times \frac{1}{3} =$

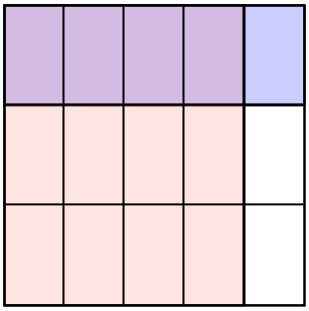

2) $\frac{1}{5} \times \frac{1}{5} =$

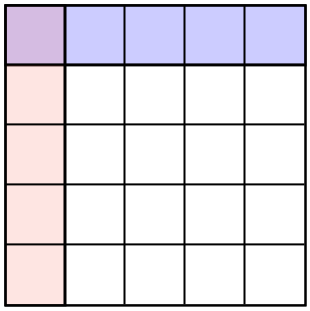

3) $\frac{3}{4} \times \frac{4}{6} =$

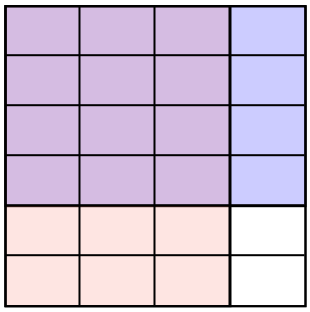

4) $\frac{1}{5} \times \frac{2}{7} =$

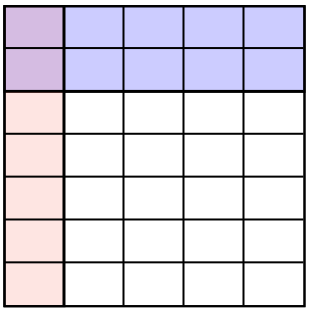

5) $\frac{1}{6} \times \frac{1}{4} =$

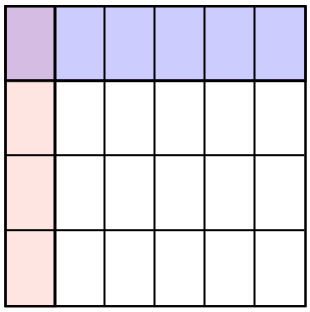

6) $\frac{1}{2} \times \frac{5}{6} =$

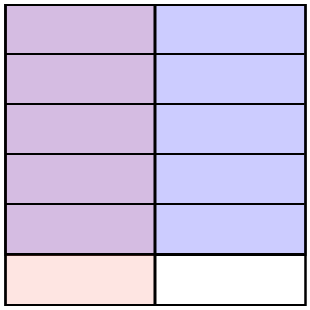

7) $\frac{8}{9} \times \frac{1}{2} =$

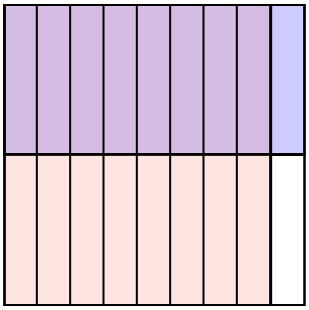

8) $\frac{1}{4} \times \frac{1}{9} =$

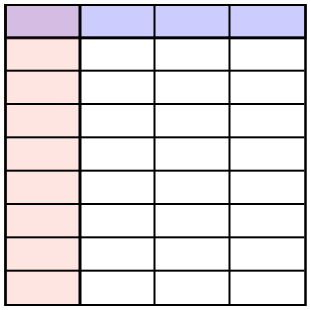

9) $\frac{1}{2} \times \frac{3}{7} =$

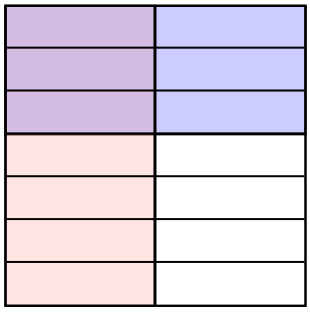

10) $\frac{4}{6} \times \frac{2}{5} =$

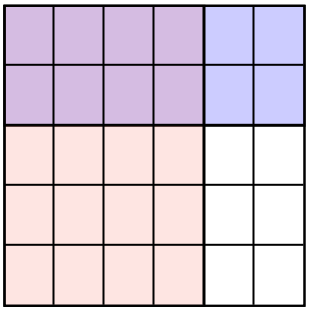

11) $\frac{4}{8} \times \frac{4}{7} =$



Respuestas

Ej. $\frac{1}{10}$

1. $\frac{4}{15}$
2. $\frac{1}{25}$
3. $\frac{12}{24}$
4. $\frac{2}{35}$
5. $\frac{1}{24}$
6. $\frac{5}{12}$
7. $\frac{8}{18}$
8. $\frac{1}{36}$
9. $\frac{3}{14}$
10. $\frac{8}{30}$
11. $\frac{16}{56}$

1-10	91	82	73	64	55	45	36	27	18	9
11	0									