Multiplicando Fracciones (visualmente) Nombre:

Usa la caja para mostrar un ejemplo visual de cómo multiplicar dos fracciones.

Ej) $\frac{2}{9} \times \frac{1}{4} =$

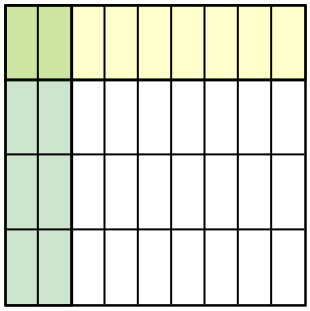

1) $\frac{6}{8} \times \frac{1}{2} =$

2) $\frac{4}{9} \times \frac{8}{9} =$

3) $\frac{1}{6} \times \frac{4}{6} =$

4) $\frac{2}{7} \times \frac{1}{2} =$

5) $\frac{3}{4} \times \frac{1}{2} =$

6) $\frac{2}{8} \times \frac{1}{7} =$

7) $\frac{1}{2} \times \frac{1}{5} =$

8) $\frac{1}{3} \times \frac{1}{5} =$

9) $\frac{1}{4} \times \frac{2}{4} =$

10) $\frac{5}{6} \times \frac{1}{2} =$

11) $\frac{4}{9} \times \frac{4}{5} =$

Respuestas

Ej. $\frac{2}{36}$

1. _____
2. _____
3. _____
4. _____
5. _____
6. _____
7. _____
8. _____
9. _____
10. _____
11. _____

1-10	91	82	73	64	55	45	36	27	18	9
11	0									

Usa la caja para mostrar un ejemplo visual de cómo multiplicar dos fracciones.

Ej) $\frac{2}{9} \times \frac{1}{4} =$

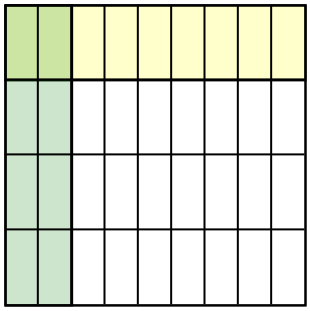

1) $\frac{6}{8} \times \frac{1}{2} =$

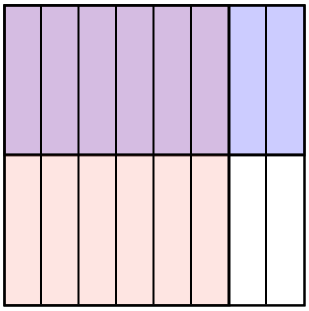

2) $\frac{4}{9} \times \frac{8}{9} =$

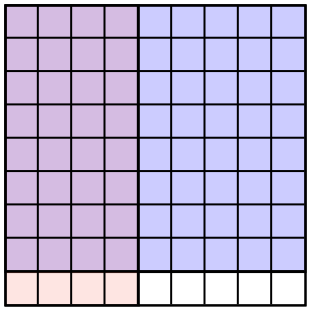

3) $\frac{1}{6} \times \frac{4}{6} =$

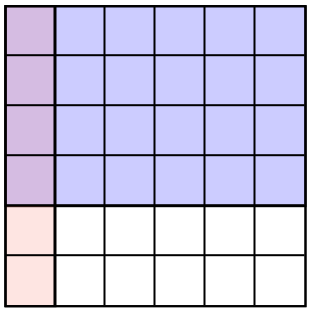

4) $\frac{2}{7} \times \frac{1}{2} =$

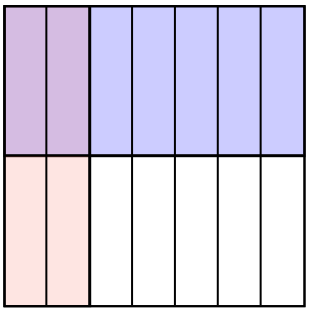

5) $\frac{3}{4} \times \frac{1}{2} =$



6) $\frac{2}{8} \times \frac{1}{7} =$

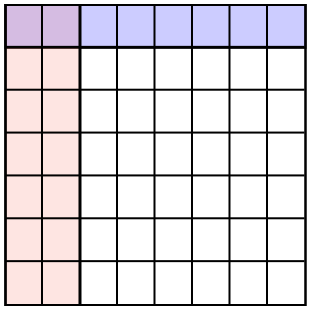

7) $\frac{1}{2} \times \frac{1}{5} =$

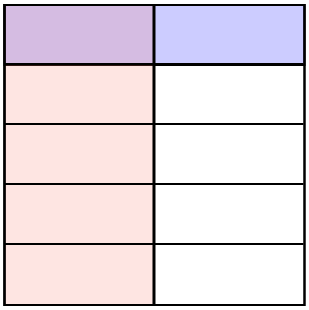

8) $\frac{1}{3} \times \frac{1}{5} =$



9) $\frac{1}{4} \times \frac{2}{4} =$



10) $\frac{5}{6} \times \frac{1}{2} =$

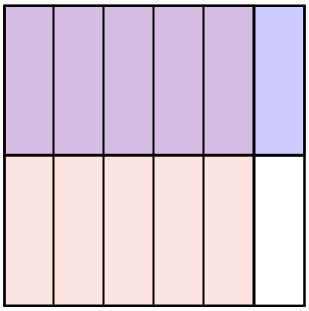

11) $\frac{4}{9} \times \frac{4}{5} =$

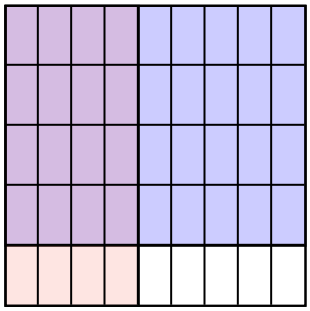

Respuestas

Ej. $\frac{2}{36}$

1. $\frac{6}{16}$
2. $\frac{32}{81}$
3. $\frac{4}{36}$
4. $\frac{2}{14}$
5. $\frac{3}{8}$
6. $\frac{2}{56}$
7. $\frac{1}{10}$
8. $\frac{1}{15}$
9. $\frac{2}{16}$
10. $\frac{5}{12}$
11. $\frac{16}{45}$

1-10	91	82	73	64	55	45	36	27	18	9
11	0									