Multiplicando Fracciones (visualmente) Nombre:

Usa la caja para mostrar un ejemplo visual de cómo multiplicar dos fracciones.

Ej) $\frac{6}{9} \times \frac{3}{5} =$

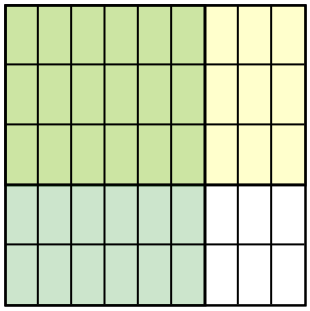

1) $\frac{7}{8} \times \frac{2}{3} =$

2) $\frac{6}{7} \times \frac{5}{9} =$

3) $\frac{1}{3} \times \frac{1}{5} =$

4) $\frac{2}{8} \times \frac{1}{8} =$

5) $\frac{1}{5} \times \frac{4}{6} =$

6) $\frac{3}{4} \times \frac{5}{8} =$

7) $\frac{2}{3} \times \frac{1}{3} =$

8) $\frac{5}{6} \times \frac{2}{8} =$

9) $\frac{3}{4} \times \frac{1}{2} =$

10) $\frac{3}{7} \times \frac{2}{4} =$

11) $\frac{3}{6} \times \frac{1}{2} =$

Respuestas

Ej. 18/45

1. _____
2. _____
3. _____
4. _____
5. _____
6. _____
7. _____
8. _____
9. _____
10. _____
11. _____

1-10	91	82	73	64	55	45	36	27	18	9
11	0									

Usa la caja para mostrar un ejemplo visual de cómo multiplicar dos fracciones.

Ej) $\frac{6}{9} \times \frac{3}{5} =$

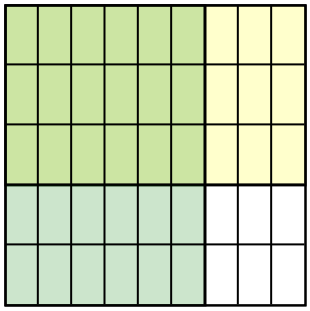

1) $\frac{7}{8} \times \frac{2}{3} =$

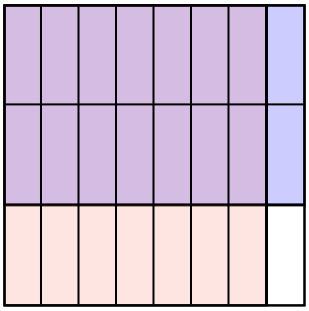

2) $\frac{6}{7} \times \frac{5}{9} =$

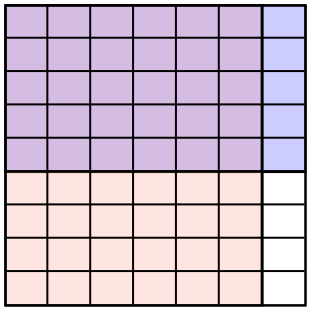

3) $\frac{1}{3} \times \frac{1}{5} =$

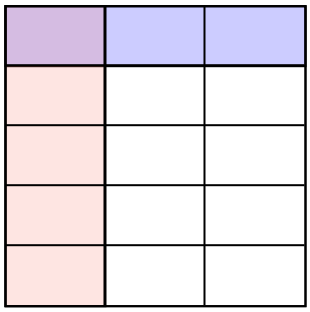

4) $\frac{2}{8} \times \frac{1}{8} =$

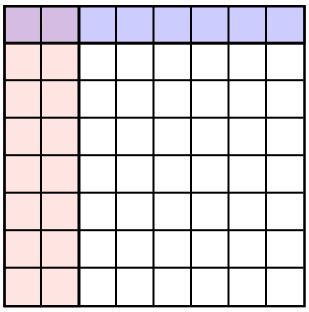

5) $\frac{1}{5} \times \frac{4}{6} =$

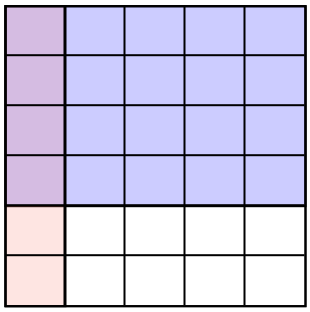

6) $\frac{3}{4} \times \frac{5}{8} =$

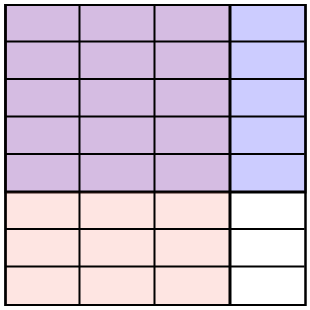

7) $\frac{2}{3} \times \frac{1}{3} =$



8) $\frac{5}{6} \times \frac{2}{8} =$

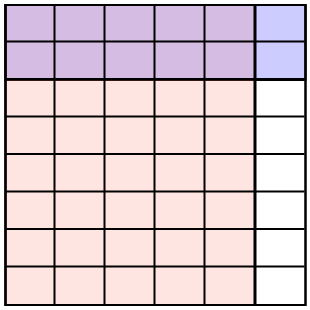

9) $\frac{3}{4} \times \frac{1}{2} =$



10) $\frac{3}{7} \times \frac{2}{4} =$

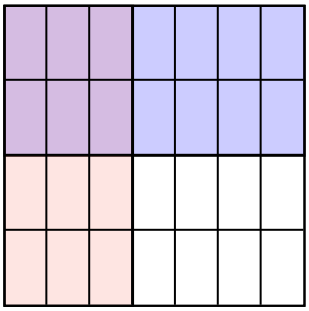

11) $\frac{3}{6} \times \frac{1}{2} =$

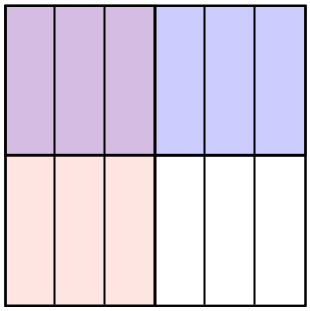

Respuestas

Ej.	18/45
1.	14/24
2.	30/63
3.	1/15
4.	2/64
5.	4/30
6.	15/32
7.	2/9
8.	10/48
9.	3/8
10.	6/28
11.	3/12

1-10	91	82	73	64	55	45	36	27	18	9
11	0									