Multiplicando Fracciones (visualmente) Nombre:

Usa la caja para mostrar un ejemplo visual de cómo multiplicar dos fracciones.

Ej) $\frac{2}{6} \times \frac{2}{4} =$

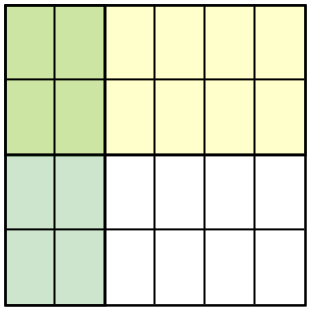

1) $\frac{2}{3} \times \frac{1}{4} =$

2) $\frac{6}{9} \times \frac{1}{3} =$

3) $\frac{5}{9} \times \frac{5}{6} =$

4) $\frac{2}{3} \times \frac{2}{6} =$

5) $\frac{5}{7} \times \frac{3}{8} =$

6) $\frac{5}{8} \times \frac{1}{4} =$

7) $\frac{1}{4} \times \frac{1}{8} =$

8) $\frac{5}{7} \times \frac{3}{4} =$

9) $\frac{3}{6} \times \frac{4}{5} =$

10) $\frac{3}{5} \times \frac{2}{3} =$

11) $\frac{1}{3} \times \frac{2}{3} =$

Respuestas

Ej. $\frac{4}{24}$

1. _____
2. _____
3. _____
4. _____
5. _____
6. _____
7. _____
8. _____
9. _____
10. _____
11. _____

1-10	91	82	73	64	55	45	36	27	18	9
11	0									

Usa la caja para mostrar un ejemplo visual de cómo multiplicar dos fracciones.

Ej) $\frac{2}{6} \times \frac{2}{4} =$

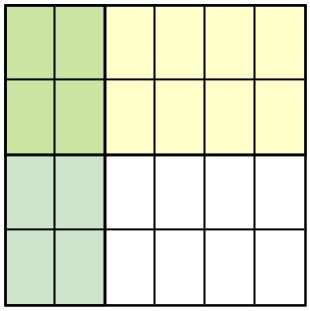

1) $\frac{2}{3} \times \frac{1}{4} =$



2) $\frac{6}{9} \times \frac{1}{3} =$

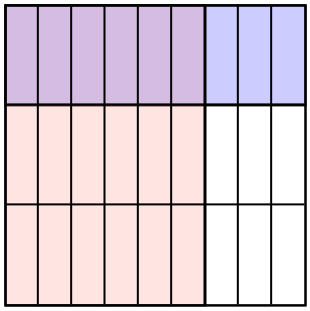

3) $\frac{5}{9} \times \frac{5}{6} =$

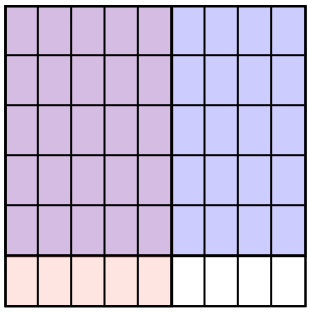

4) $\frac{2}{3} \times \frac{2}{6} =$

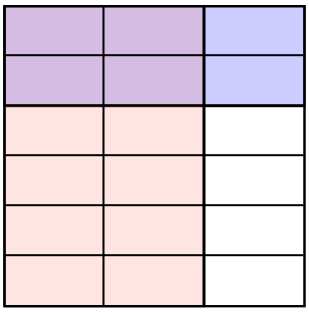

5) $\frac{5}{7} \times \frac{3}{8} =$

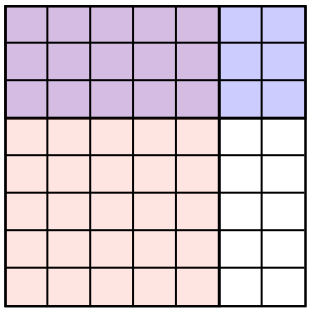

6) $\frac{5}{8} \times \frac{1}{4} =$

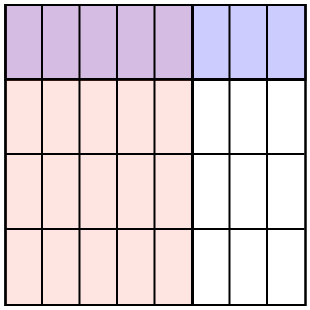

7) $\frac{1}{4} \times \frac{1}{8} =$

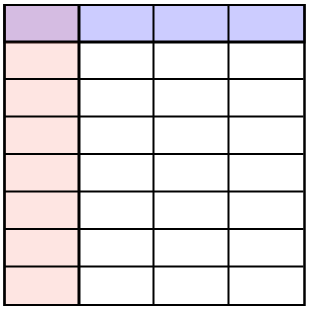

8) $\frac{5}{7} \times \frac{3}{4} =$

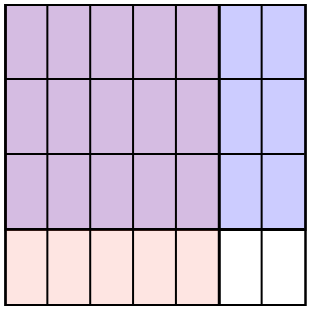

9) $\frac{3}{6} \times \frac{4}{5} =$

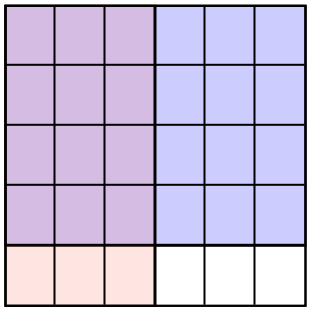

10) $\frac{3}{5} \times \frac{2}{3} =$

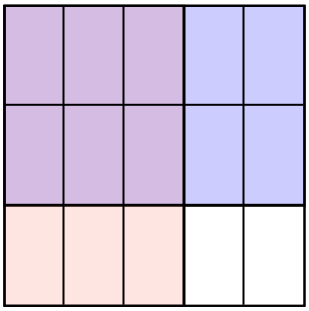

11) $\frac{1}{3} \times \frac{2}{3} =$



Respuestas

Ej. $\frac{4}{24}$

1. $\frac{2}{12}$
2. $\frac{6}{27}$
3. $\frac{25}{54}$
4. $\frac{4}{18}$
5. $\frac{15}{56}$
6. $\frac{5}{32}$
7. $\frac{1}{32}$
8. $\frac{15}{28}$
9. $\frac{12}{30}$
10. $\frac{6}{15}$
11. $\frac{2}{9}$

1-10	91	82	73	64	55	45	36	27	18	9
11	0									