Encontrando la distancia en una cuadrícula

Nombre:

Encuentra la distancia entre puntos. Redondea tu respuesta al decimal más cercano.

Ej)

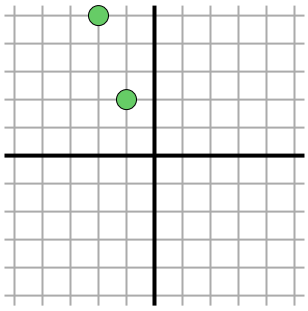

$\sqrt{(-1--2)^2 + (2-5)^2}$

$\sqrt{(1) + (9)}$

1)

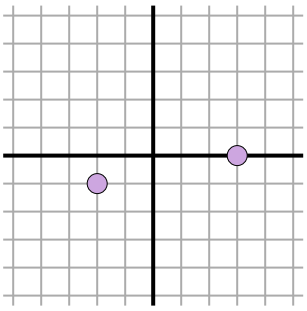

2)

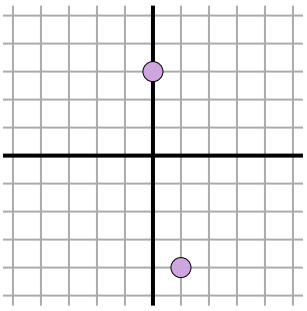

3)

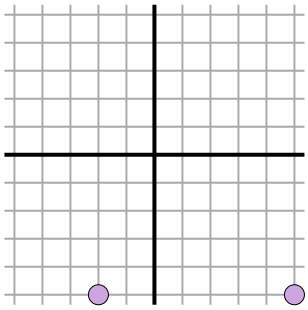

4)

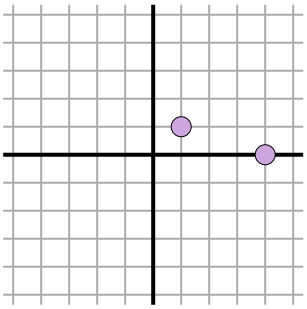

5)

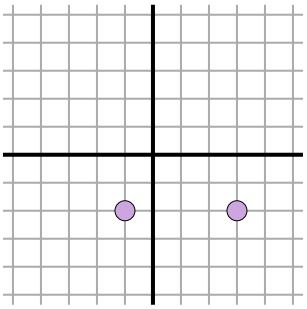

6)

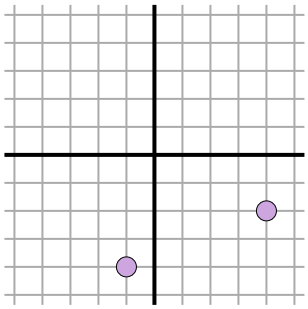

7)

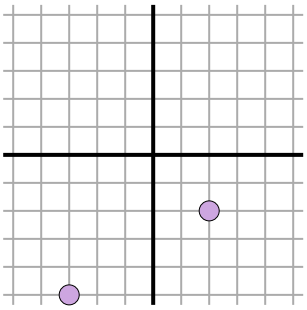

8)

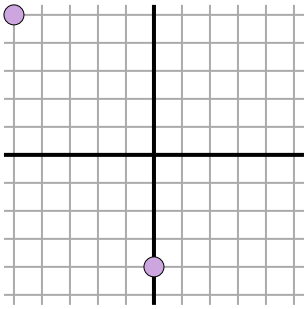

9)

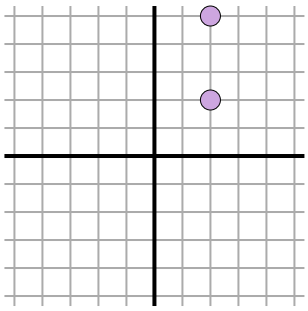

10)

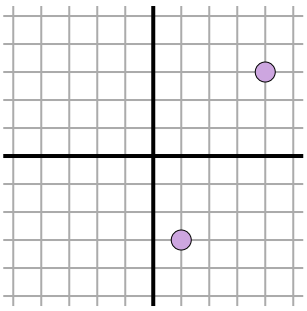

11)

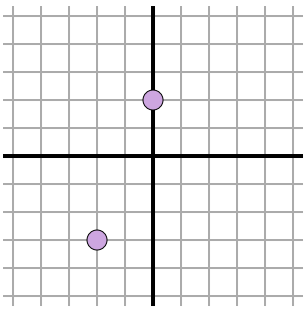

Respuestas

Ej. 3.2

1. _____
2. _____
3. _____
4. _____
5. _____
6. _____
7. _____
8. _____
9. _____
10. _____
11. _____

1-10	91	82	73	64	55	45	36	27	18	9
11	0									

Encontrando la distancia en una cuadrícula

Nombre: **Clave De Respuestas**

Encuentra la distancia entre puntos. Redondea tu respuesta al decimal más cercano.

Ej)

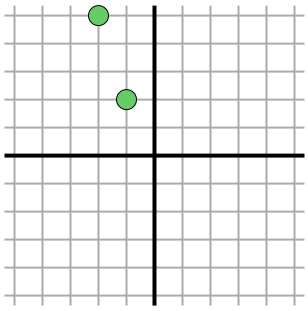

$\sqrt{(-1--2)^2 + (2-5)^2}$

$\sqrt{(1) + (9)}$

1)

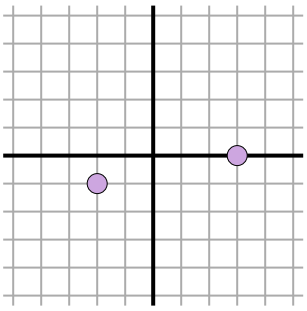

$\sqrt{(3--2)^2 + (0--1)^2}$

$\sqrt{(25) + (1)}$

2)

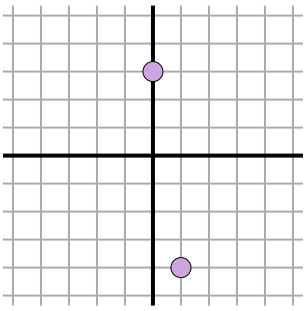

$\sqrt{(0-1)^2 + (3--4)^2}$

$\sqrt{(1) + (49)}$

3)

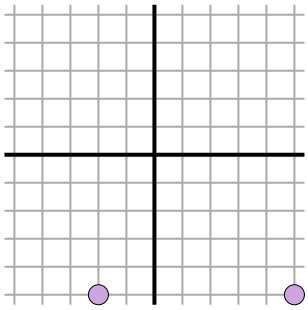

$\sqrt{(-2-5)^2 + (-5--5)^2}$

$\sqrt{(49) + (0)}$

4)

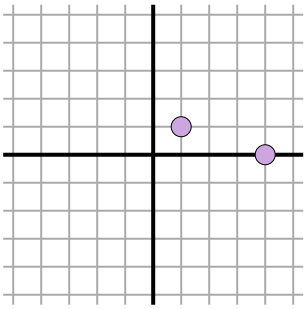

$\sqrt{(4-1)^2 + (0-1)^2}$

$\sqrt{(9) + (1)}$

5)

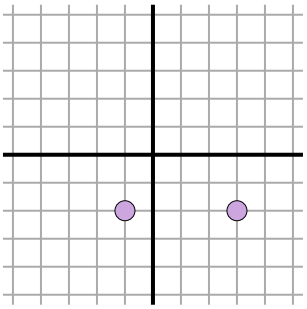

$\sqrt{(3--1)^2 + (-2--2)^2}$

$\sqrt{(16) + (0)}$

6)

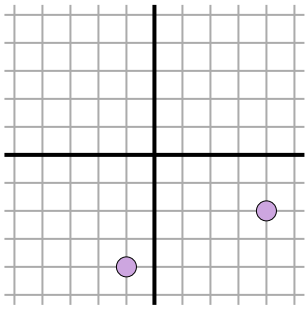

$\sqrt{(4--1)^2 + (-2--4)^2}$

$\sqrt{(25) + (4)}$

7)

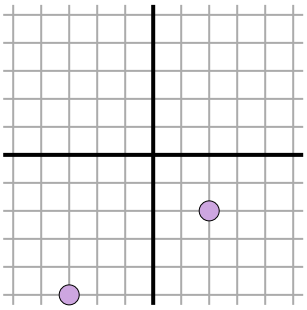

$\sqrt{(2--3)^2 + (-2--5)^2}$

$\sqrt{(25) + (9)}$

8)

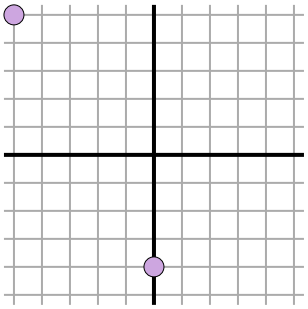

$\sqrt{(-5-0)^2 + (5--4)^2}$

$\sqrt{(25) + (81)}$

9)

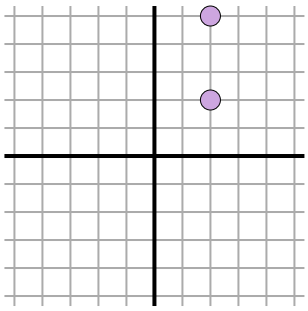

$\sqrt{(2-2)^2 + (5-2)^2}$

$\sqrt{(0) + (9)}$

10)

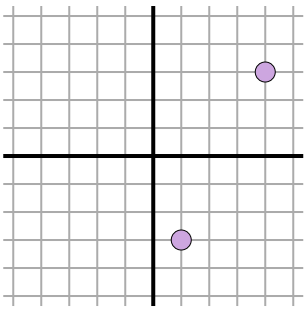

$\sqrt{(1-4)^2 + (-3-3)^2}$

$\sqrt{(9) + (36)}$

11)

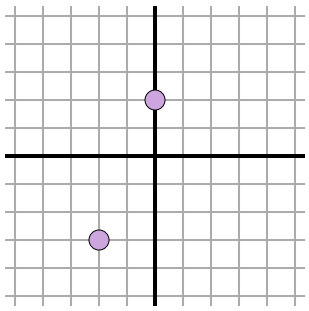

$\sqrt{(-2-0)^2 + (-3-2)^2}$

$\sqrt{(4) + (25)}$

Respuestas

Ej.	3.2
1.	5.1
2.	7.1
3.	7
4.	3.2
5.	4
6.	5.4
7.	5.8
8.	10.3
9.	3
10.	6.7
11.	5.4

1-10	91	82	73	64	55	45	36	27	18	9
11	0									