Encontrando la distancia en una cuadrícula Nombre:

Encuentra la distancia entre puntos. Redondea tu respuesta al decimal más cercano.

Ej)

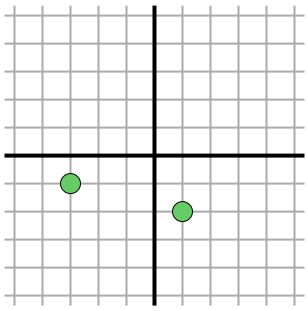

$\sqrt{(-3-1)^2 + (-1--2)^2}$

$\sqrt{(16) + (1)}$

1)

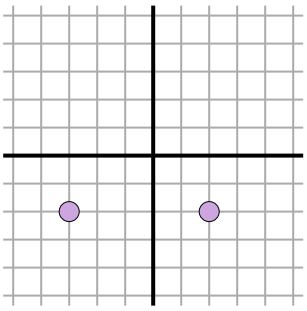

2)

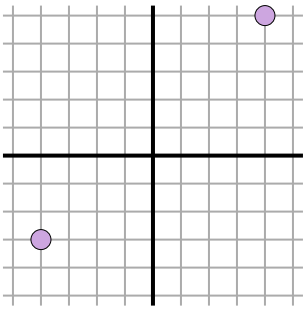

3)

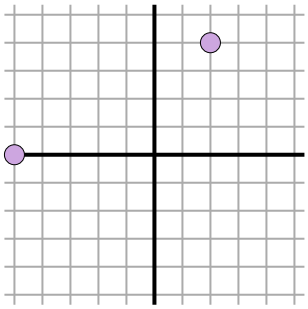

4)

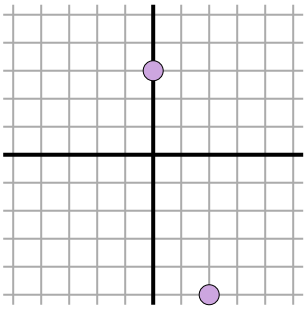

5)

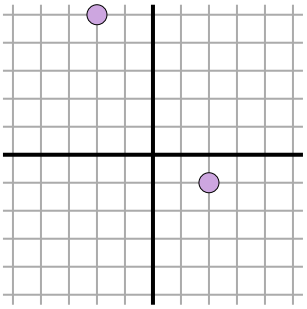

6)

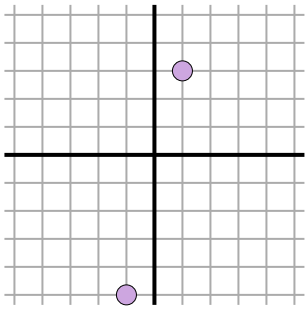

7)

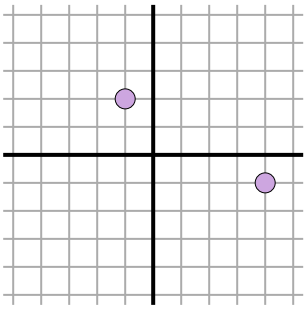

8)

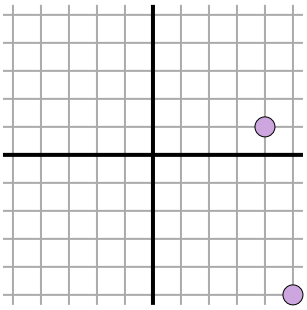

9)

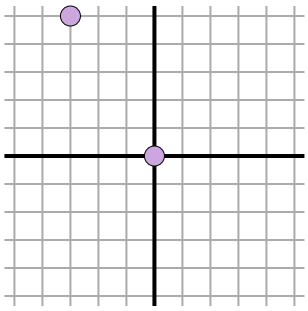

10)

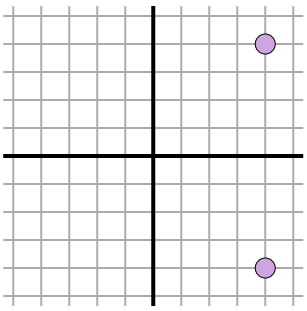

11)

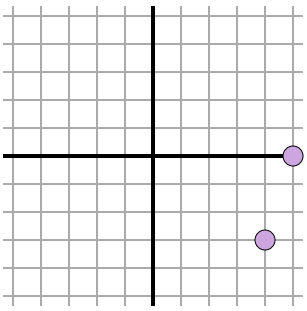

Respuestas

Ej. 4.1

1. _____
2. _____
3. _____
4. _____
5. _____
6. _____
7. _____
8. _____
9. _____
10. _____
11. _____

1-10	91	82	73	64	55	45	36	27	18	9
11	0									

Encontrando la distancia en una cuadrícula

Nombre: **Clave De Respuestas**

Encuentra la distancia entre puntos. Redondea tu respuesta al decimal más cercano.

Ej)

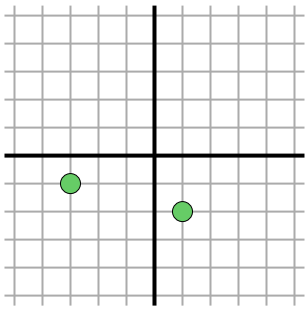

$\sqrt{(-3-1)^2 + (-1--2)^2}$

$\sqrt{(16) + (1)}$

1)

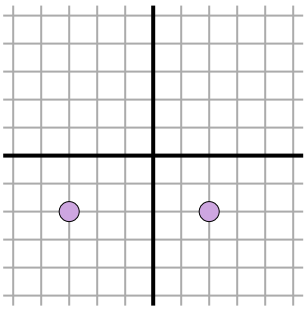

$\sqrt{(2--3)^2 + (-2--2)^2}$

$\sqrt{(25) + (0)}$

2)

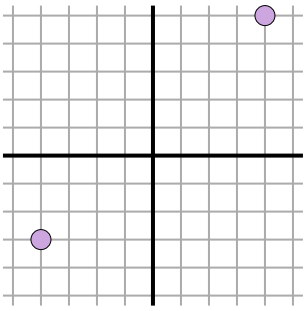

$\sqrt{(4--4)^2 + (5--3)^2}$

$\sqrt{(64) + (64)}$

3)

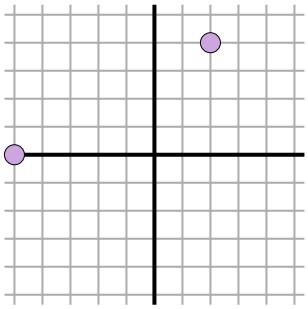

$\sqrt{(-5-2)^2 + (0-4)^2}$

$\sqrt{(49) + (16)}$

4)

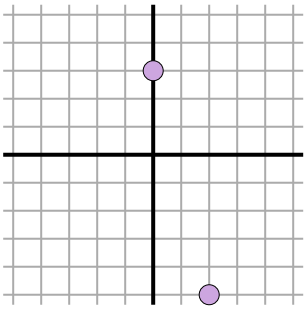

$\sqrt{(0-2)^2 + (3--5)^2}$

$\sqrt{(4) + (64)}$

5)

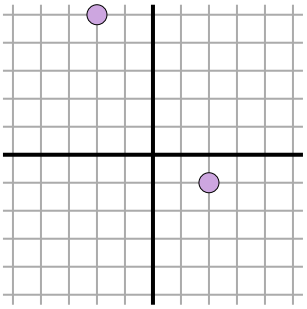

$\sqrt{(2--2)^2 + (-1-5)^2}$

$\sqrt{(16) + (36)}$

6)

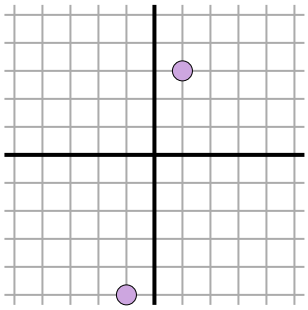

$\sqrt{(1--1)^2 + (3--5)^2}$

$\sqrt{(4) + (64)}$

7)

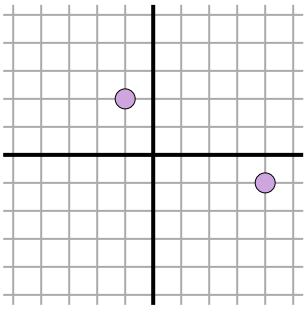

$\sqrt{(-1-4)^2 + (2--1)^2}$

$\sqrt{(25) + (9)}$

8)

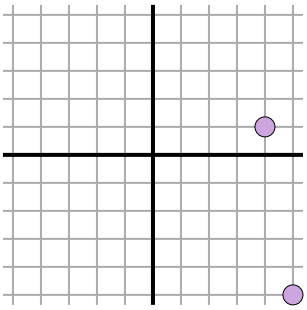

$\sqrt{(4-5)^2 + (1--5)^2}$

$\sqrt{(1) + (36)}$

9)

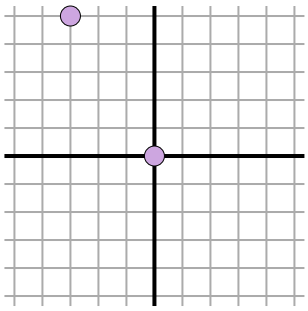

$\sqrt{(-3-0)^2 + (5-0)^2}$

$\sqrt{(9) + (25)}$

10)

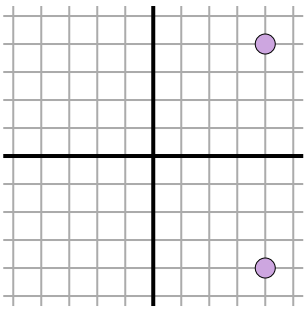

$\sqrt{(4-4)^2 + (-4-4)^2}$

$\sqrt{(0) + (64)}$

11)

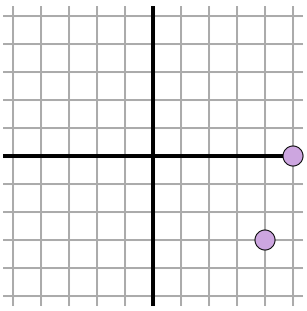

$\sqrt{(4-5)^2 + (-3-0)^2}$

$\sqrt{(1) + (9)}$

Respuestas

Ej.	4.1
1.	5
2.	11.3
3.	8.1
4.	8.2
5.	7.2
6.	8.2
7.	5.8
8.	6.1
9.	5.8
10.	8
11.	3.2

1-10	91	82	73	64	55	45	36	27	18	9
11	0									