Encontrando la distancia en una cuadrícula

Nombre:

Encuentra la distancia entre puntos. Redondea tu respuesta al decimal más cercano.

Ej)

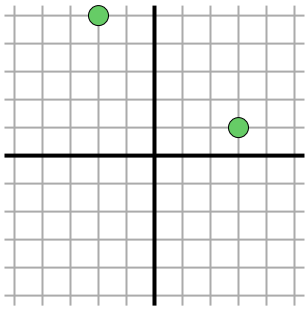

$\sqrt{(-2-3)^2 + (5-1)^2}$

$\sqrt{(25) + (16)}$

1)

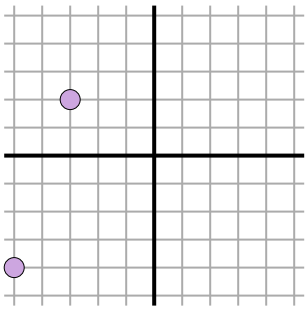

2)

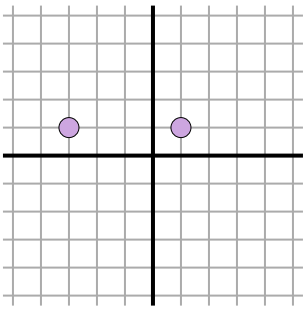

3)

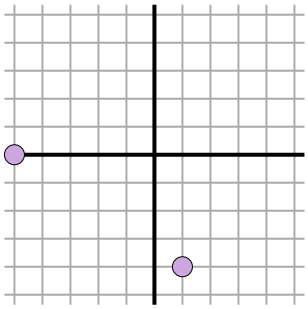

4)

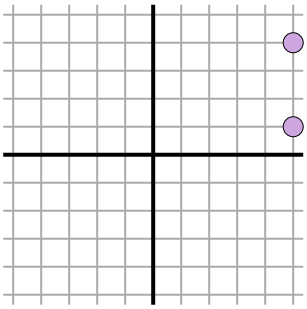

5)

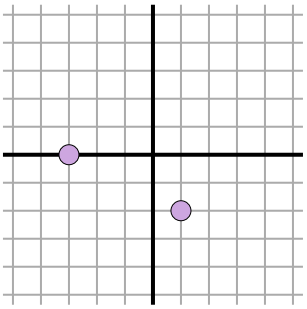

6)

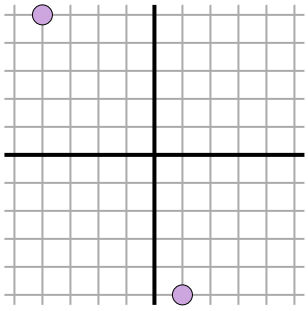

7)

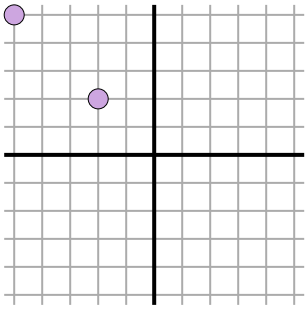

8)

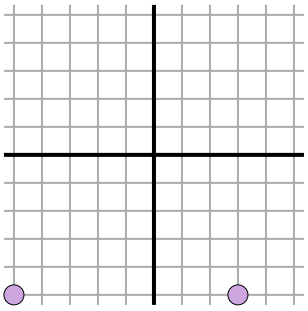

9)

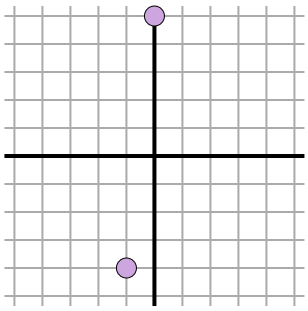

10)

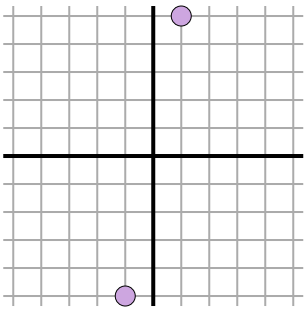

11)

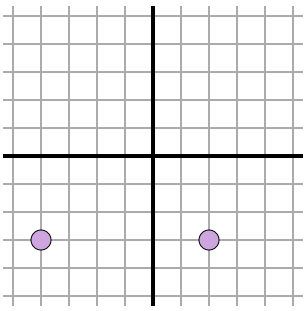

Respuestas

Ej. 6.4

1. _____
2. _____
3. _____
4. _____
5. _____
6. _____
7. _____
8. _____
9. _____
10. _____
11. _____

1-10	91	82	73	64	55	45	36	27	18	9
11	0									

Encuentra la distancia entre puntos. Redondea tu respuesta al decimal más cercano.

Ej)

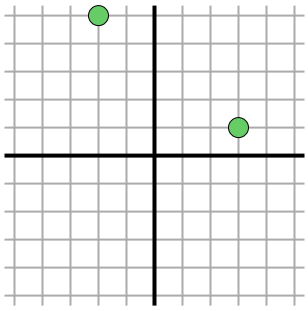

$\sqrt{(-2-3)^2 + (5-1)^2}$

$\sqrt{(25) + (16)}$

1)

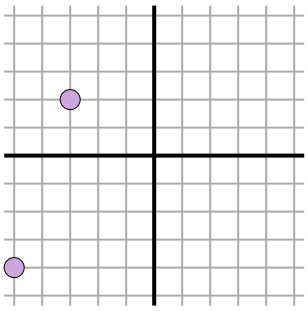

$\sqrt{(-5--3)^2 + (-4-2)^2}$

$\sqrt{(4) + (36)}$

2)

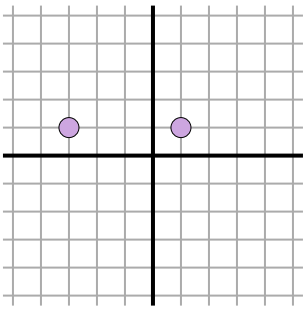

$\sqrt{(-3-1)^2 + (1-1)^2}$

$\sqrt{(16) + (0)}$

3)

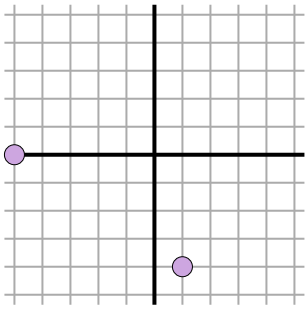

$\sqrt{(-5-1)^2 + (0--4)^2}$

$\sqrt{(36) + (16)}$

4)

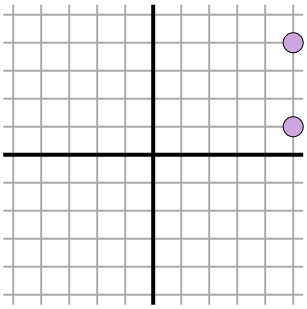

$\sqrt{(5-5)^2 + (4-1)^2}$

$\sqrt{(0) + (9)}$

5)

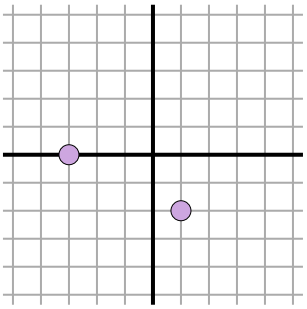

$\sqrt{(-3-1)^2 + (0--2)^2}$

$\sqrt{(16) + (4)}$

6)

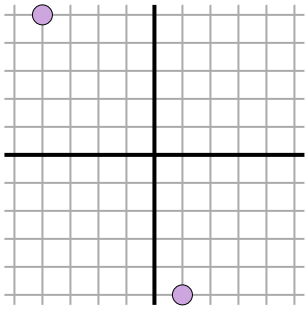

$\sqrt{(-4-1)^2 + (5--5)^2}$

$\sqrt{(25) + (100)}$

7)

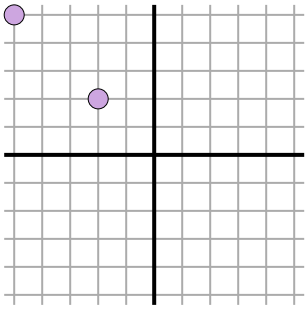

$\sqrt{(-2--5)^2 + (2-5)^2}$

$\sqrt{(9) + (9)}$

8)

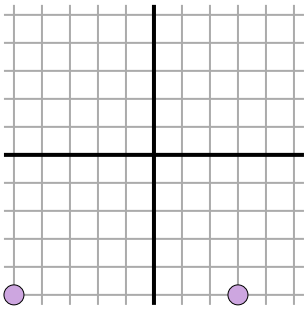

$\sqrt{(-5-3)^2 + (-5--5)^2}$

$\sqrt{(64) + (0)}$

9)

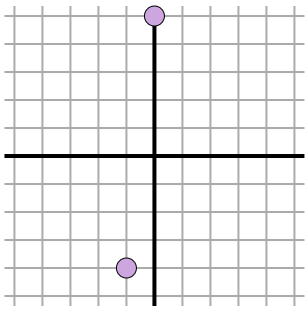

$\sqrt{(-1-0)^2 + (-4-5)^2}$

$\sqrt{(1) + (81)}$

10)

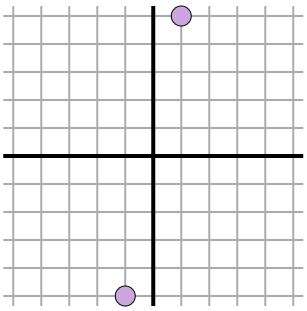

$\sqrt{(-1-1)^2 + (-5-5)^2}$

$\sqrt{(4) + (100)}$

11)

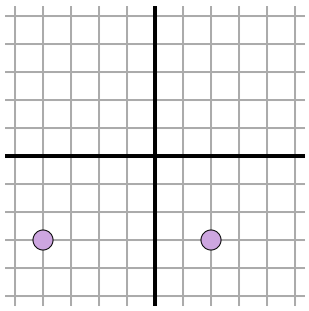

$\sqrt{(-4-2)^2 + (-3--3)^2}$

$\sqrt{(36) + (0)}$

Respuestas

Ej.	6.4
1.	6.3
2.	4
3.	7.2
4.	3
5.	4.5
6.	11.2
7.	4.2
8.	8
9.	9.1
10.	10.2
11.	6

1-10	91	82	73	64	55	45	36	27	18	9
11	0									