Encontrando la distancia en una cuadrícula Nombre:

Encuentra la distancia entre puntos. Redondea tu respuesta al decimal más cercano.

Ej)

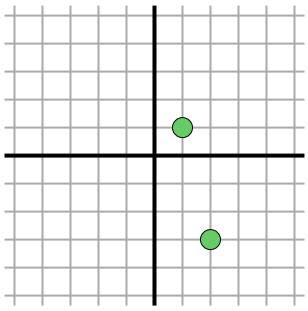

$\sqrt{(1-2)^2 + (1--3)^2}$

$\sqrt{(1) + (16)}$

1)

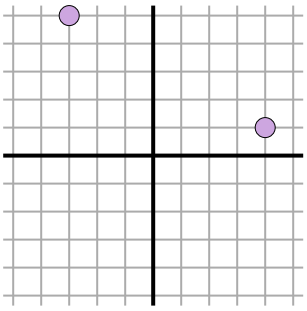

2)

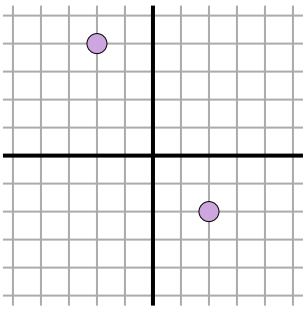

3)

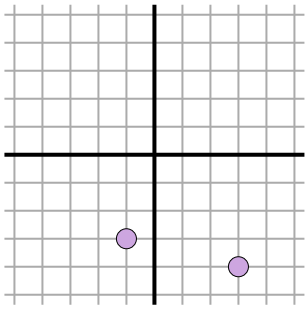

4)

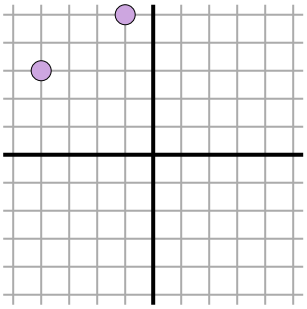

5)

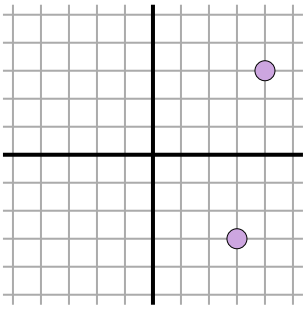

6)

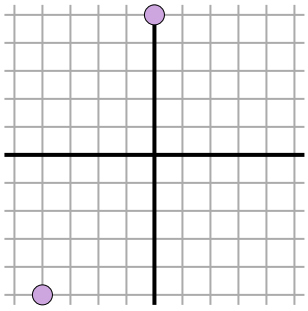

7)

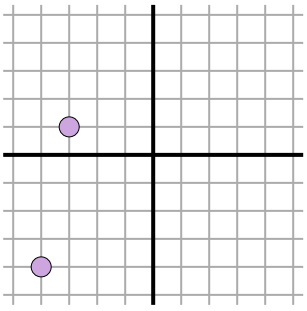

8)

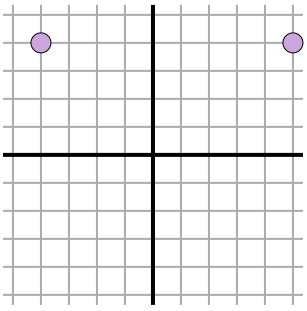

9)

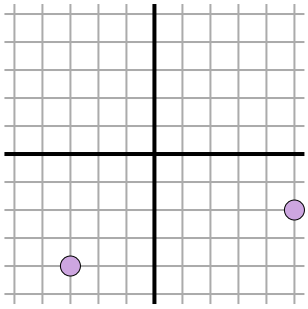

10)

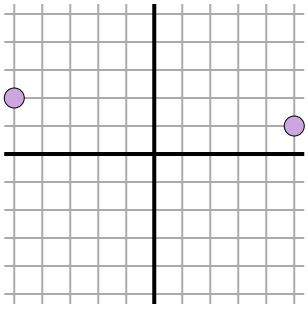

11)

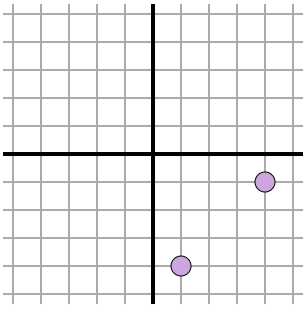

Respuestas

Ej. 4.1

1. _____
2. _____
3. _____
4. _____
5. _____
6. _____
7. _____
8. _____
9. _____
10. _____
11. _____

1-10	91	82	73	64	55	45	36	27	18	9
11	0									

Encontrando la distancia en una cuadrícula

Nombre: **Clave De Respuestas**

Encuentra la distancia entre puntos. Redondea tu respuesta al decimal más cercano.

Ej)

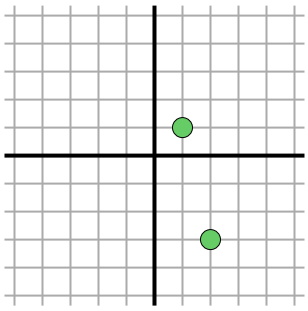

$\sqrt{(1-2)^2 + (1--3)^2}$

$\sqrt{(1) + (16)}$

1)

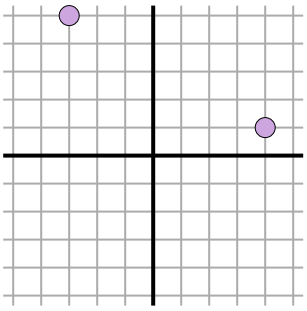

$\sqrt{(4--3)^2 + (1-5)^2}$

$\sqrt{(49) + (16)}$

2)

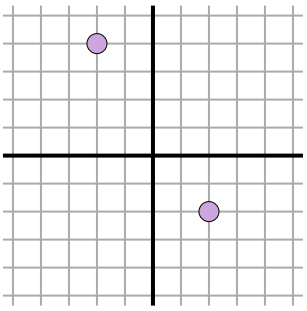

$\sqrt{(-2-2)^2 + (4--2)^2}$

$\sqrt{(16) + (36)}$

3)

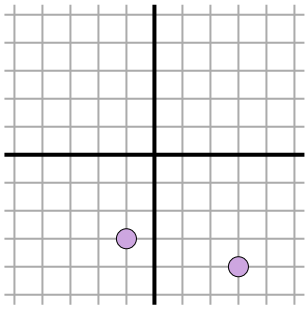

$\sqrt{(3--1)^2 + (-4--3)^2}$

$\sqrt{(16) + (1)}$

4)

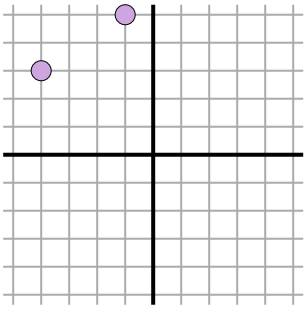

$\sqrt{(-4--1)^2 + (3-5)^2}$

$\sqrt{(9) + (4)}$

5)

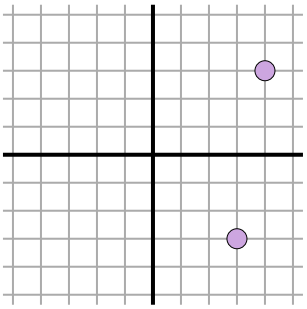

$\sqrt{(3-4)^2 + (-3-3)^2}$

$\sqrt{(1) + (36)}$

6)

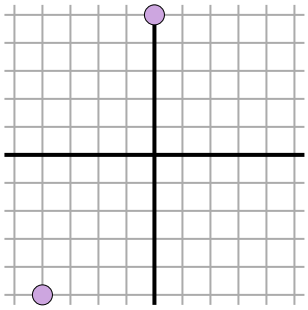

$\sqrt{(0--4)^2 + (5--5)^2}$

$\sqrt{(16) + (100)}$

7)

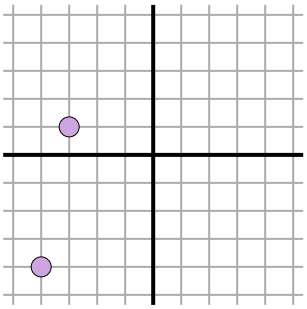

$\sqrt{(-4--3)^2 + (-4-1)^2}$

$\sqrt{(1) + (25)}$

8)

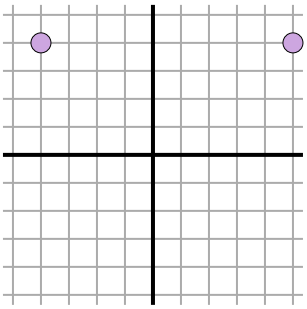

$\sqrt{(-4-5)^2 + (4-4)^2}$

$\sqrt{(81) + (0)}$

9)

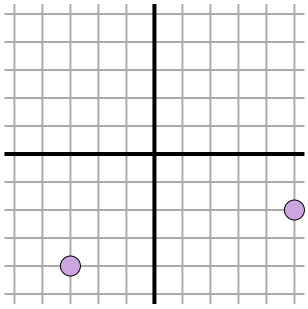

$\sqrt{(5--3)^2 + (-2--4)^2}$

$\sqrt{(64) + (4)}$

10)

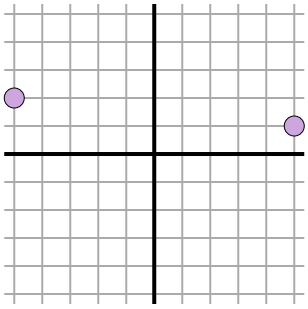

$\sqrt{(-5-5)^2 + (2-1)^2}$

$\sqrt{(100) + (1)}$

11)

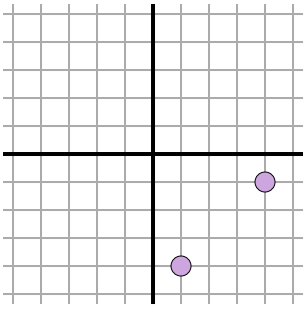

$\sqrt{(1-4)^2 + (-4--1)^2}$

$\sqrt{(9) + (9)}$

Respuestas

Ej.	4.1
1.	8.1
2.	7.2
3.	4.1
4.	3.6
5.	6.1
6.	10.8
7.	5.1
8.	9
9.	8.2
10.	10
11.	4.2

1-10	91	82	73	64	55	45	36	27	18	9
11	0									