Encontrando la distancia en una cuadrícula

Nombre:

Encuentra la distancia entre puntos. Redondea tu respuesta al decimal más cercano.

Ej)

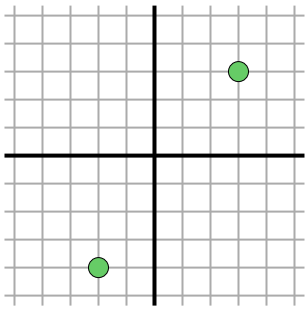

$\sqrt{(-2-3)^2 + (-4-3)^2}$

$\sqrt{(25) + (49)}$

1)

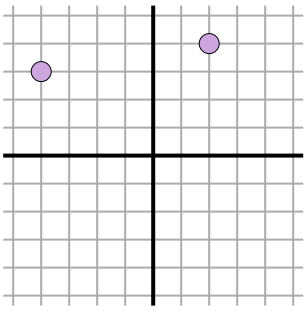

2)

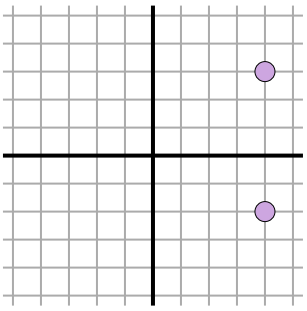

3)

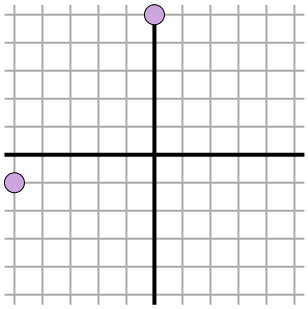

4)

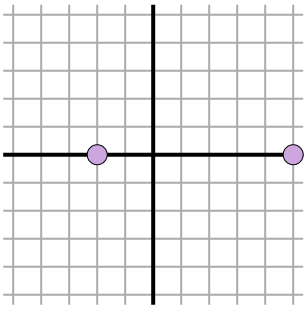

5)

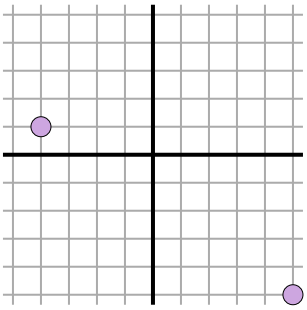

6)

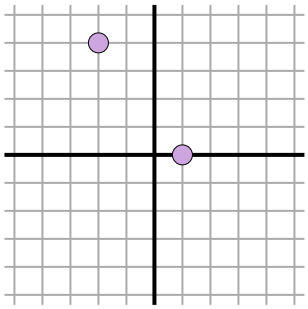

7)

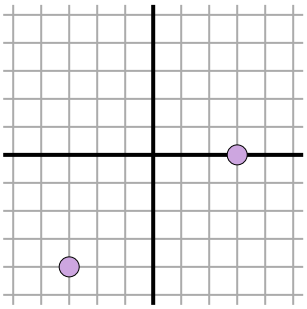

8)

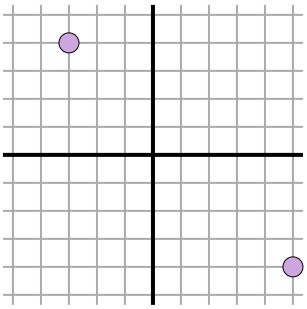

9)

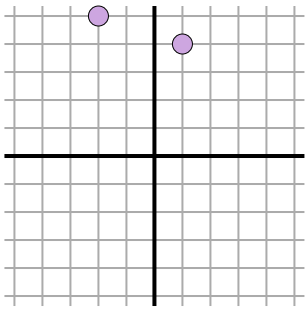

10)

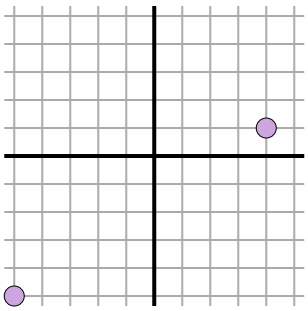

11)

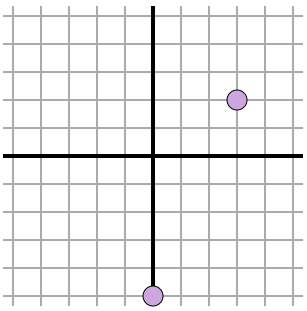

Respuestas

Ej. 8.6

1. _____
2. _____
3. _____
4. _____
5. _____
6. _____
7. _____
8. _____
9. _____
10. _____
11. _____

1-10	91	82	73	64	55	45	36	27	18	9
11	0									

Encuentra la distancia entre puntos. Redondea tu respuesta al decimal más cercano.

Ej)

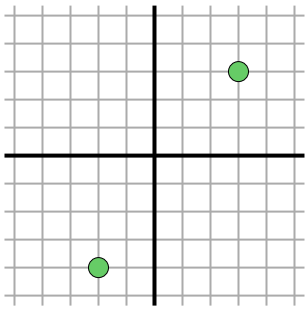

$\sqrt{(-2-3)^2 + (-4-3)^2}$

$\sqrt{(25) + (49)}$

1)

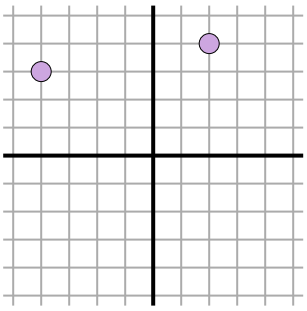

$\sqrt{(2--4)^2 + (4-3)^2}$

$\sqrt{(36) + (1)}$

2)

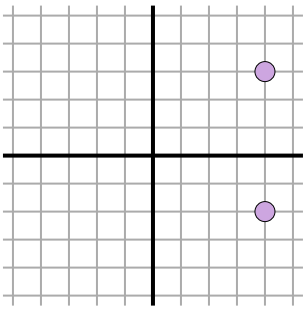

$\sqrt{(4-4)^2 + (3--2)^2}$

$\sqrt{(0) + (25)}$

3)

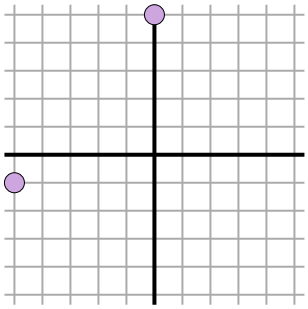

$\sqrt{(0--5)^2 + (5--1)^2}$

$\sqrt{(25) + (36)}$

4)

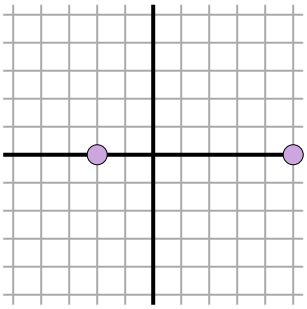

$\sqrt{(5--2)^2 + (0-0)^2}$

$\sqrt{(49) + (0)}$

5)

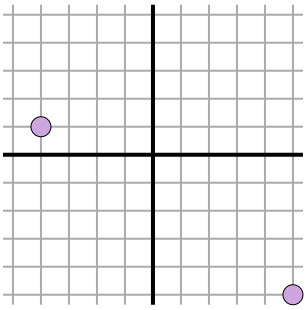

$\sqrt{(5--4)^2 + (-5-1)^2}$

$\sqrt{(81) + (36)}$

6)

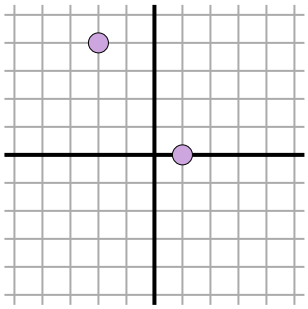

$\sqrt{(1--2)^2 + (0-4)^2}$

$\sqrt{(9) + (16)}$

7)

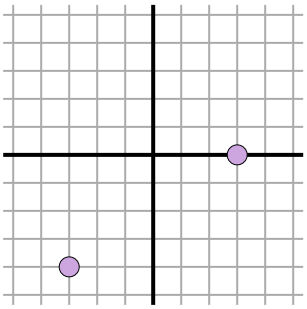

$\sqrt{(3--3)^2 + (0--4)^2}$

$\sqrt{(36) + (16)}$

8)

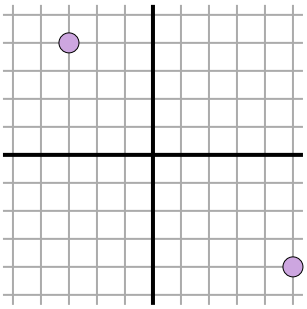

$\sqrt{(5--3)^2 + (-4-4)^2}$

$\sqrt{(64) + (64)}$

9)

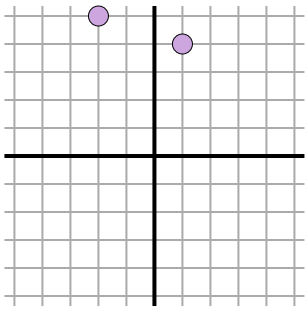

$\sqrt{(1--2)^2 + (4-5)^2}$

$\sqrt{(9) + (1)}$

10)

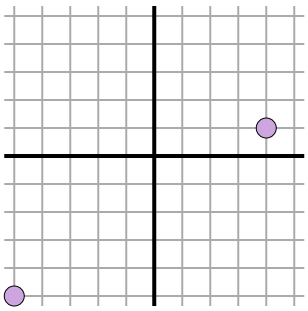

$\sqrt{(4--5)^2 + (1--5)^2}$

$\sqrt{(81) + (36)}$

11)

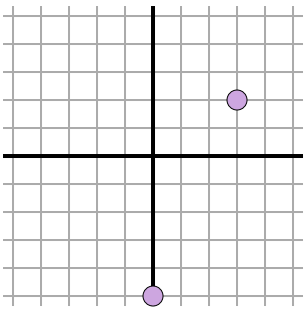

$\sqrt{(0-3)^2 + (-5-2)^2}$

$\sqrt{(9) + (49)}$

Respuestas

Ej.	8.6
1.	6.1
2.	5
3.	7.8
4.	7
5.	10.8
6.	5
7.	7.2
8.	11.3
9.	3.2
10.	10.8
11.	7.6

1-10	91	82	73	64	55	45	36	27	18	9
11	0									