Encontrando la distancia en una cuadrícula

Nombre:

Encuentra la distancia entre puntos. Redondea tu respuesta al decimal más cercano.

Ej)

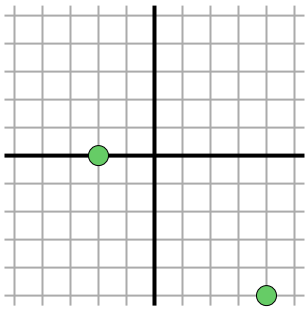

$\sqrt{(4--2)^2 + (-5-0)^2}$

$\sqrt{(36) + (25)}$

1)

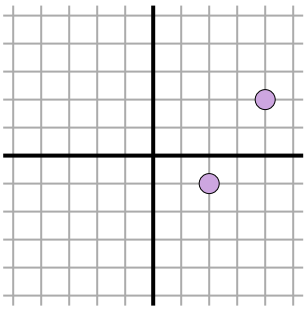

2)

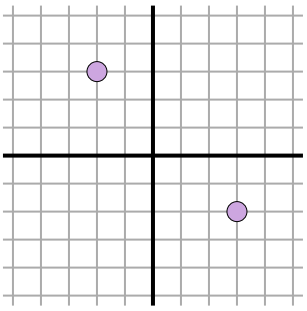

3)

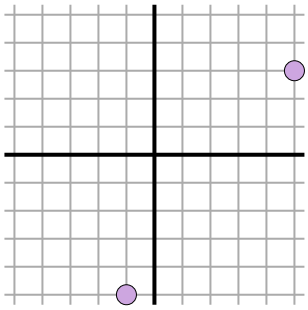

4)

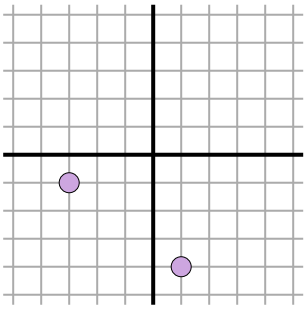

5)

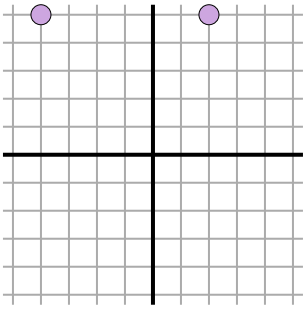

6)

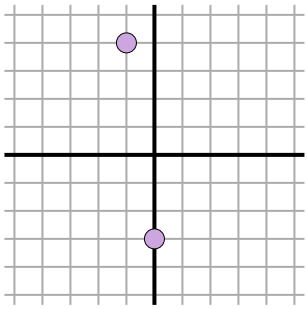

7)

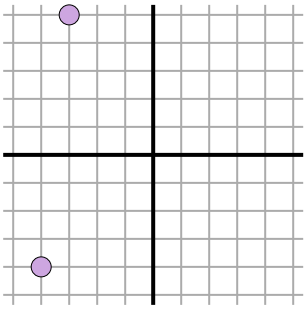

8)

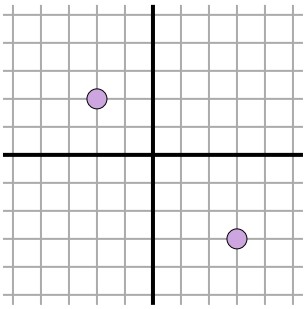

9)

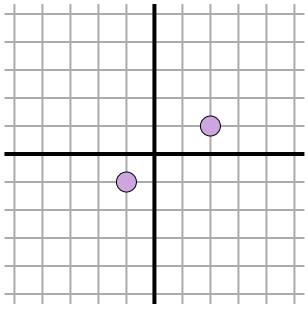

10)

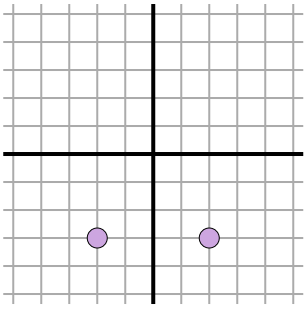

11)

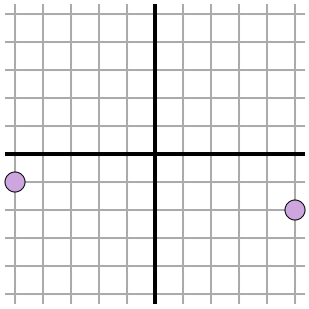

Respuestas

Ej. 7.8

1. _____
2. _____
3. _____
4. _____
5. _____
6. _____
7. _____
8. _____
9. _____
10. _____
11. _____

1-10	91	82	73	64	55	45	36	27	18	9
11	0									

Encuentra la distancia entre puntos. Redondea tu respuesta al decimal más cercano.

Ej)

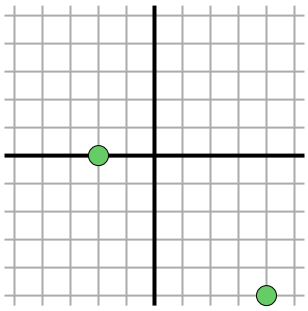

$\sqrt{(4--2)^2 + (-5-0)^2}$

$\sqrt{(36) + (25)}$

1)

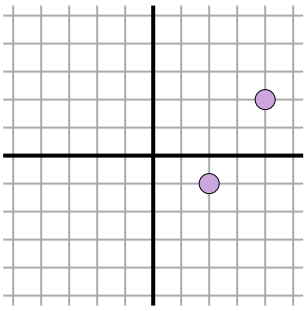

$\sqrt{(2-4)^2 + (-1-2)^2}$

$\sqrt{(4) + (9)}$

2)

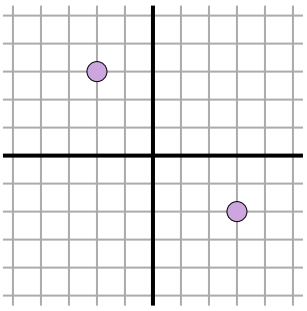

$\sqrt{(3--2)^2 + (-2-3)^2}$

$\sqrt{(25) + (25)}$

3)

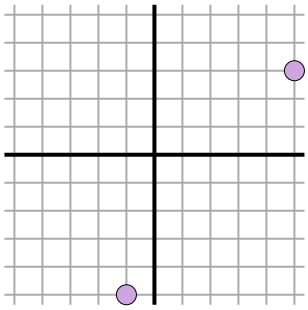

$\sqrt{(-1-5)^2 + (-5-3)^2}$

$\sqrt{(36) + (64)}$

4)

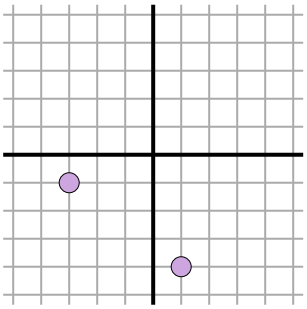

$\sqrt{(-3-1)^2 + (-1--4)^2}$

$\sqrt{(16) + (9)}$

5)

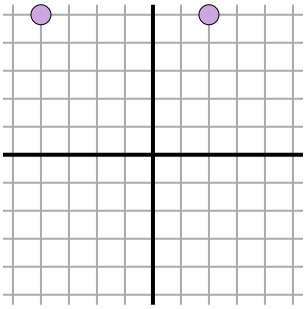

$\sqrt{(2--4)^2 + (5-5)^2}$

$\sqrt{(36) + (0)}$

6)

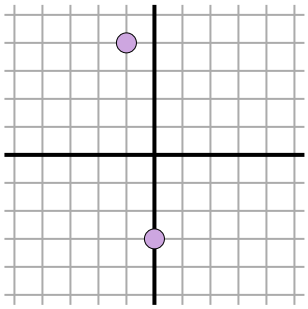

$\sqrt{(-1-0)^2 + (4--3)^2}$

$\sqrt{(1) + (49)}$

7)

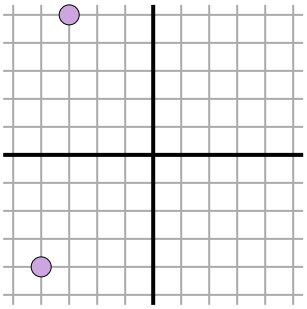

$\sqrt{(-3--4)^2 + (5--4)^2}$

$\sqrt{(1) + (81)}$

8)

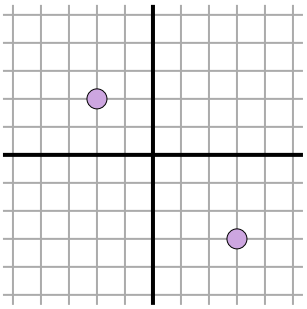

$\sqrt{(3--2)^2 + (-3-2)^2}$

$\sqrt{(25) + (25)}$

9)

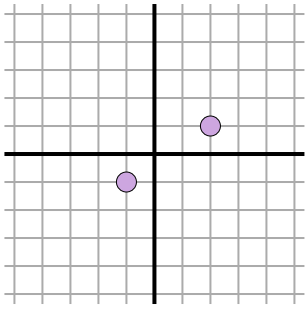

$\sqrt{(-1-2)^2 + (-1-1)^2}$

$\sqrt{(9) + (4)}$

10)

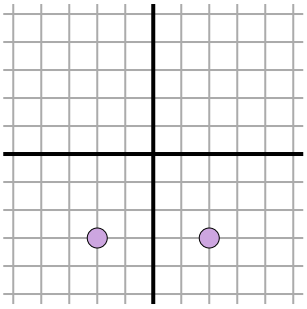

$\sqrt{(-2-2)^2 + (-3--3)^2}$

$\sqrt{(16) + (0)}$

11)

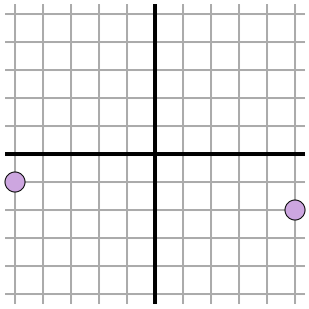

$\sqrt{(5--5)^2 + (-2--1)^2}$

$\sqrt{(100) + (1)}$

Respuestas

Ej.	7.8
1.	3.6
2.	7.1
3.	10
4.	5
5.	6
6.	7.1
7.	9.1
8.	7.1
9.	3.6
10.	4
11.	10

1-10	91	82	73	64	55	45	36	27	18	9
11	0									