Encontrando la distancia en una cuadrícula

Nombre:

Encuentra la distancia entre puntos.

Ej)

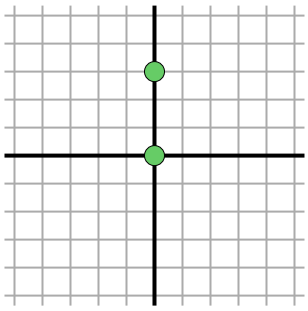

1)

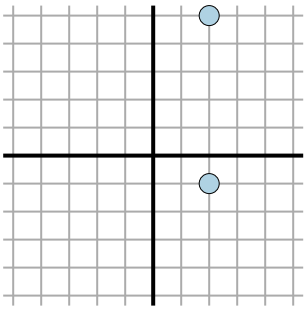

2)

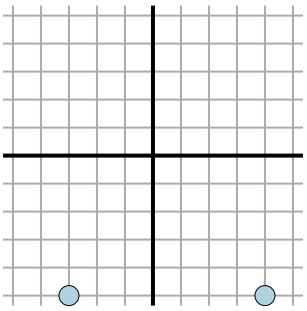

3)

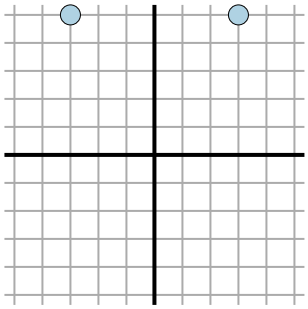

4)

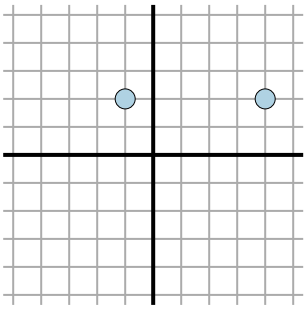

5)

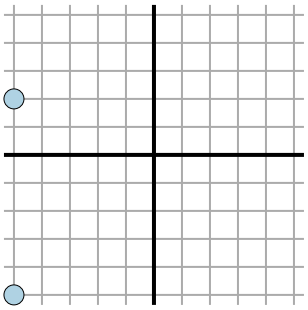

6)

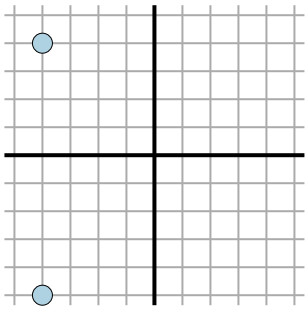

7)

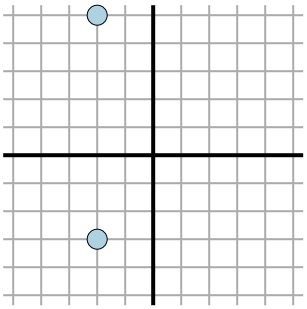

8)

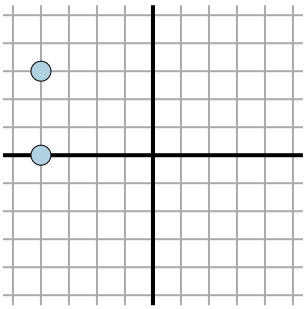

9)

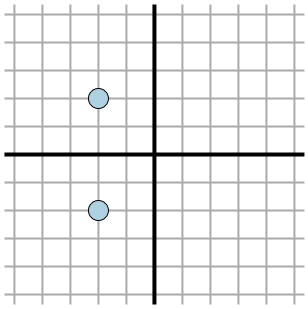

10)

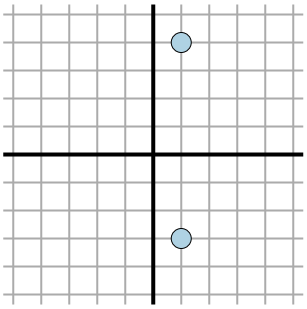

11)

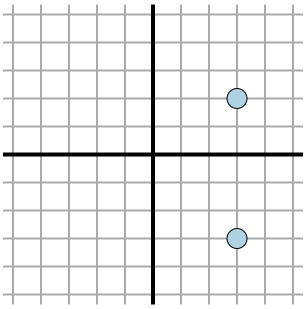

Respuestas

Ej. 3

1. _____
2. _____
3. _____
4. _____
5. _____
6. _____
7. _____
8. _____
9. _____
10. _____
11. _____

1-10	91	82	73	64	55	45	36	27	18	9
11	0									

Encontrando la distancia en una cuadrícula

Nombre: **Clave De Respuestas**

Encuentra la distancia entre puntos.

Ej)

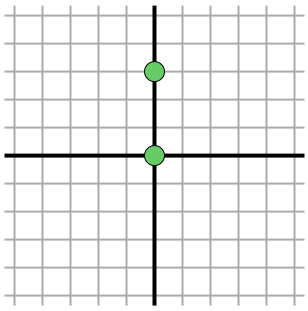

1)

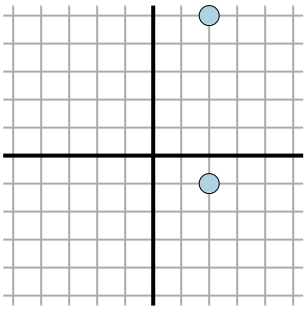

2)

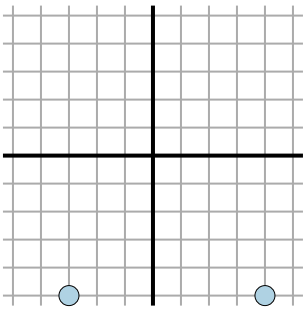

3)

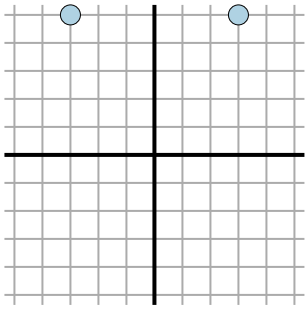

4)

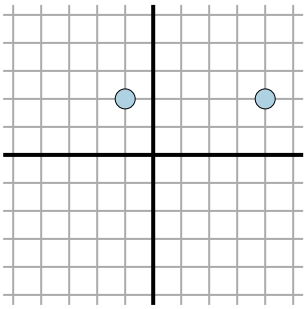

5)

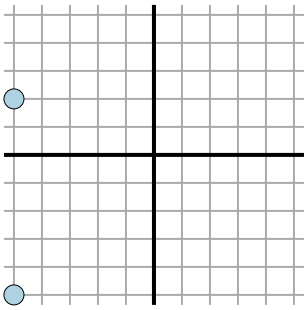

6)

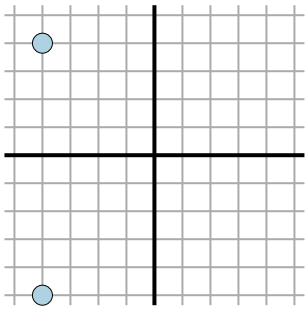

7)

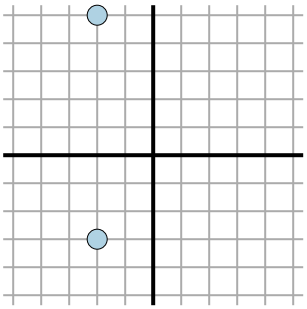

8)

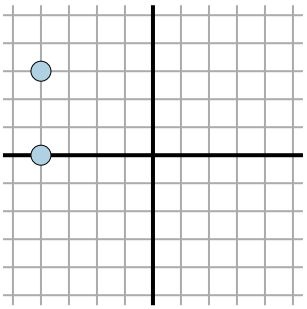

9)

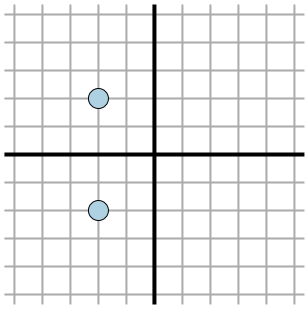

10)

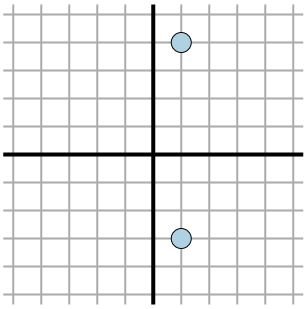

11)

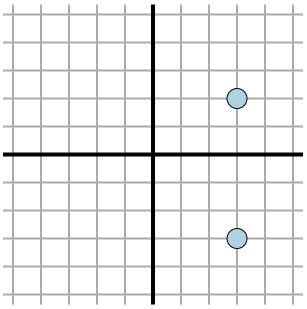

Respuestas

Ej.	3
1.	6
2.	7
3.	6
4.	5
5.	7
6.	9
7.	8
8.	3
9.	4
10.	7
11.	5

1-10	91	82	73	64	55	45	36	27	18	9
11	0									