# Encontrando la distancia en una cuadrícula

Nombre:

**Encuentra la distancia entre puntos.**

**Ej)**

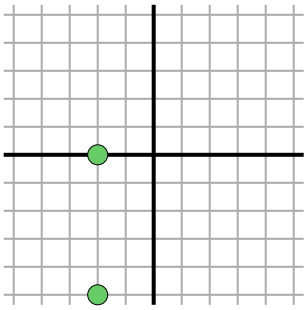

**1)**

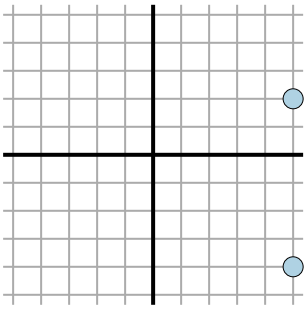

**2)**

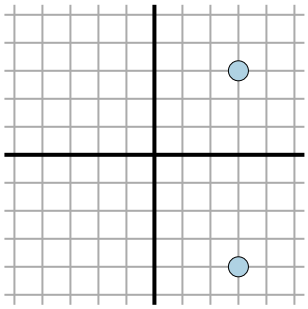

**3)**

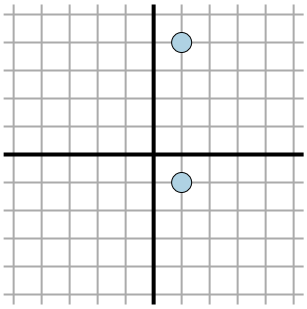

**4)**

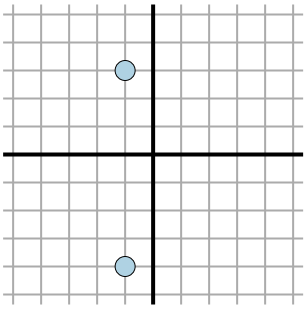

**5)**

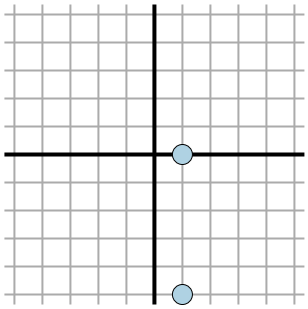

**6)**

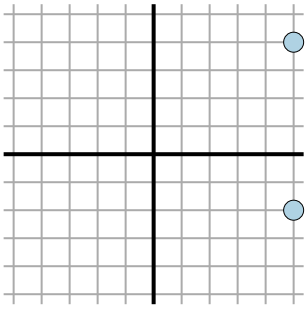

**7)**

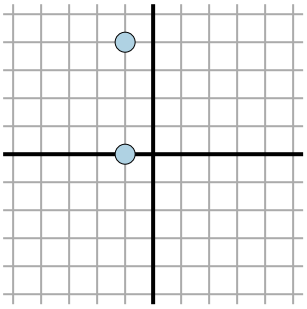

**8)**

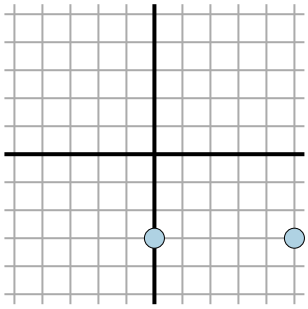

**9)**

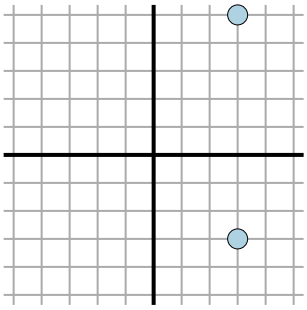

**10)**

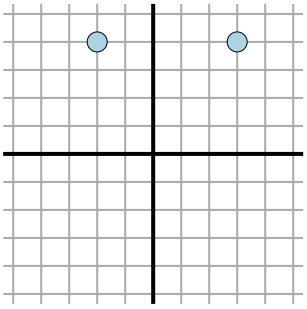

**11)**

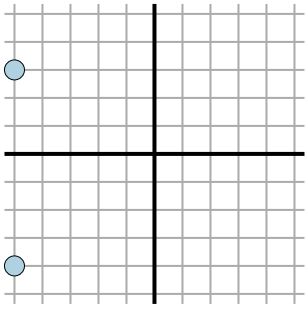

**Respuestas**

Ej. 5

1. _____
2. _____
3. _____
4. _____
5. _____
6. _____
7. _____
8. _____
9. _____
10. _____
11. _____

Encontrando la distancia en una cuadrícula

Nombre: **Clave De Respuestas**

**Encuentra la distancia entre puntos.**

**Ej)**

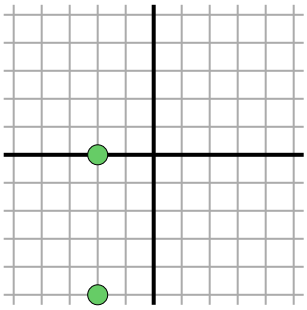

**1)**

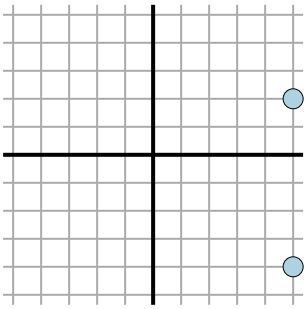

**2)**

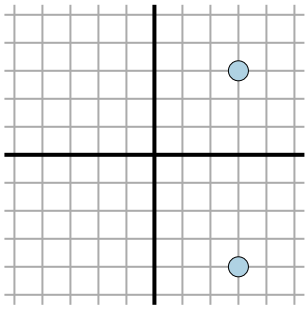

**3)**

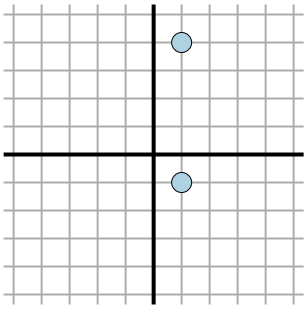

**4)**

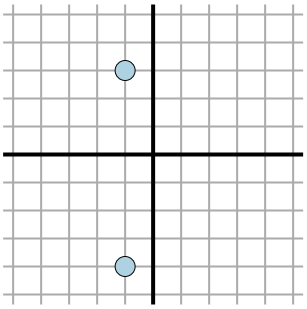

**5)**

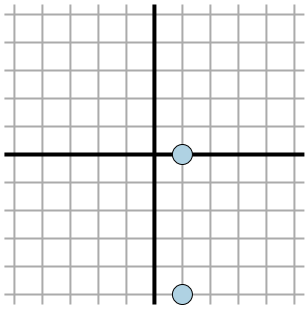

**6)**

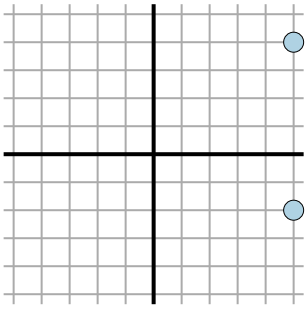

**7)**

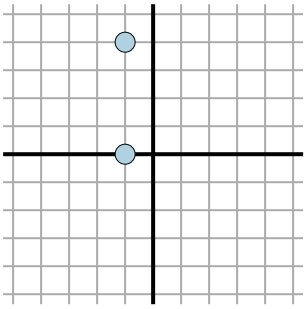

**8)**

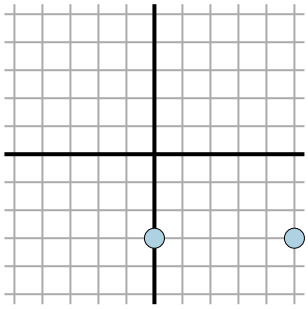

**9)**

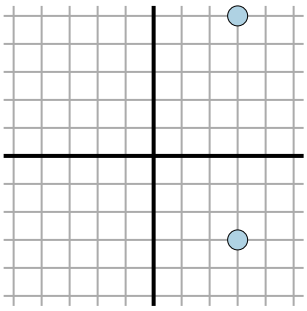

**10)**

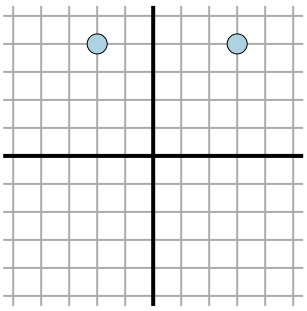

**11)**

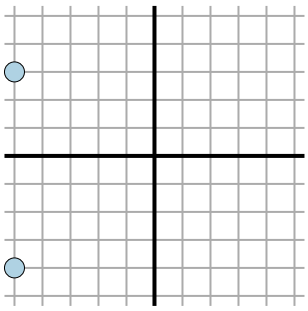

**Respuestas**

| | |
|---|---|
| Ej. | 5 |
| 1. | 6 |
| 2. | 7 |
| 3. | 5 |
| 4. | 7 |
| 5. | 5 |
| 6. | 6 |
| 7. | 4 |
| 8. | 5 |
| 9. | 8 |
| 10. | 5 |
| 11. | 7 |