# Multiplicando con una Recta Numérica

Nombre:

**Usar la recta numérica para resolver cada problema.**

**1)** 2 × 6 =
6 × 2 =

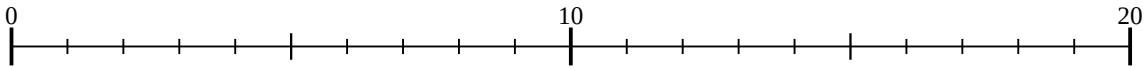


**2)** 3 × 8 =
8 × 3 =

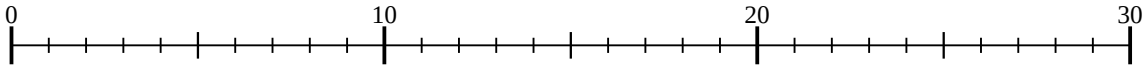


**3)** 3 × 2 =
2 × 3 =

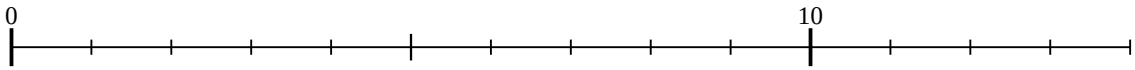


**4)** 3 × 7 =
7 × 3 =

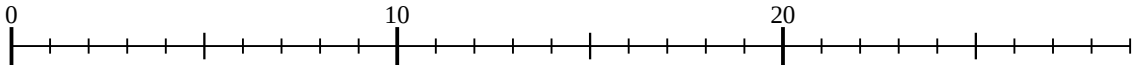


**5)** 4 × 8 =
8 × 4 =

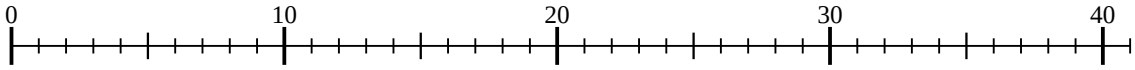


**6)** 4 × 7 =
7 × 4 =

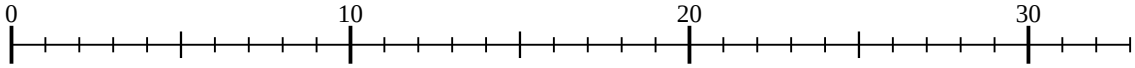


**7)** 4 × 9 =
9 × 4 =

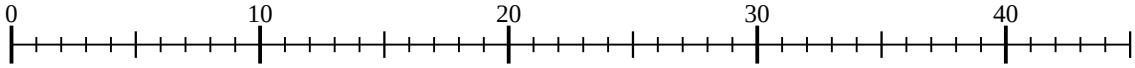


**8)** 4 × 10 =
10 × 4 =

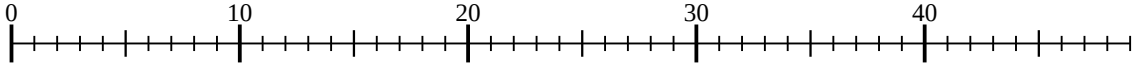


**9)** 5 × 7 =
7 × 5 =

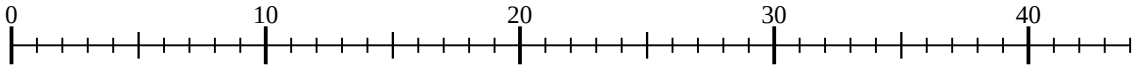


**10)** 5 × 2 =
2 × 5 =

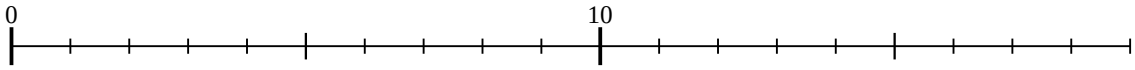


**11)** 5 × 3 =
3 × 5 =

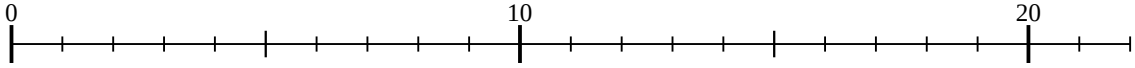


**Respuestas**

1. _____
2. _____
3. _____
4. _____
5. _____
6. _____
7. _____
8. _____
9. _____
10. _____
11. _____



| | | | | | | | | | | |
|---|---|---|---|---|---|---|---|---|---|---|
| 1-10 | 91 | 82 | 73 | 64 | 55 | 45 | 36 | 27 | 18 | 9 |
| 11 | 0 | | | | | | | | | |

Multiplicando con una Recta Numérica

Nombre: **Clave De Respuestas**

**Usar la recta numérica para resolver cada problema.**

**1)** 2 × 6 =
6 × 2 =

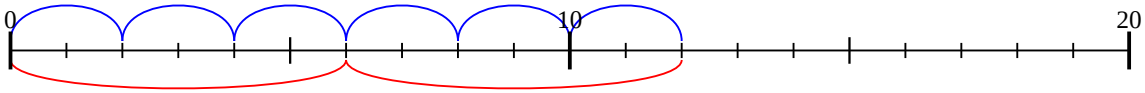


**2)** 3 × 8 =
8 × 3 =

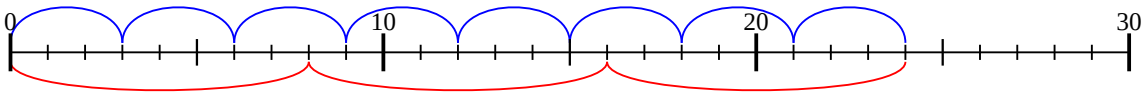


**3)** 3 × 2 =
2 × 3 =

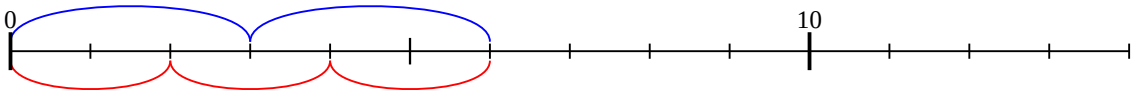


**4)** 3 × 7 =
7 × 3 =

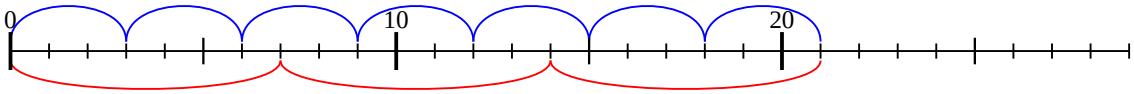


**5)** 4 × 8 =
8 × 4 =

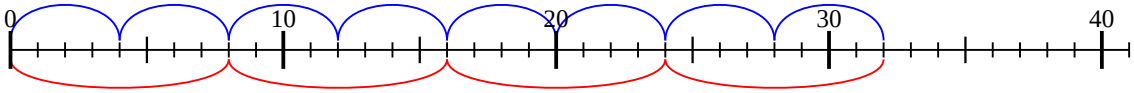


**6)** 4 × 7 =
7 × 4 =

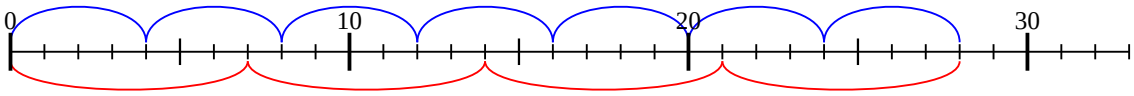


**7)** 4 × 9 =
9 × 4 =

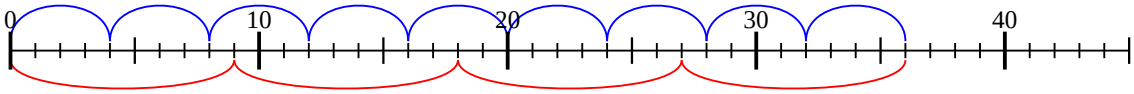


**8)** 4 × 10 =
10 × 4 =

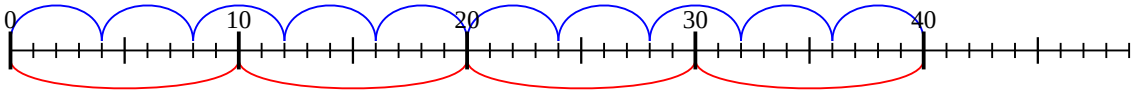


**9)** 5 × 7 =
7 × 5 =

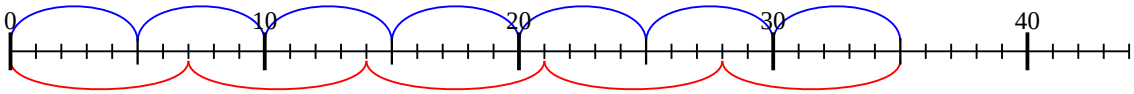


**10)** 5 × 2 =
2 × 5 =

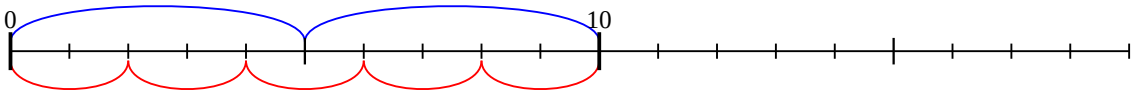


**11)** 5 × 3 =
3 × 5 =

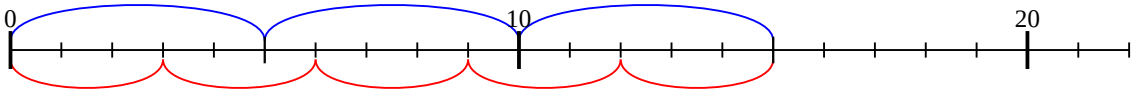


**Respuestas**

1. **12**
2. **24**
3. **6**
4. **21**
5. **32**
6. **28**
7. **36**
8. **40**
9. **35**
10. **10**
11. **15**



| | | | | | | | | | | |
|---|---|---|---|---|---|---|---|---|---|---|
| 1-10 | 91 | 82 | 73 | 64 | 55 | 45 | 36 | 27 | 18 | 9 |
| 11 | 0 | | | | | | | | | |