Multiplicando con una Recta Numérica

Nombre:

Usar la recta numérica para resolver cada problema.

1) 4 × 5 =
5 × 4 =

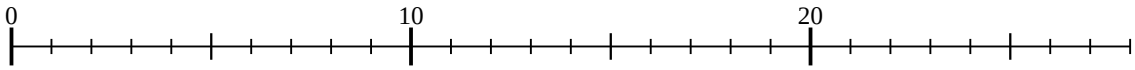

2) 2 × 5 =
5 × 2 =

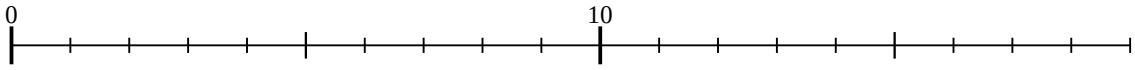

3) 5 × 4 =
4 × 5 =

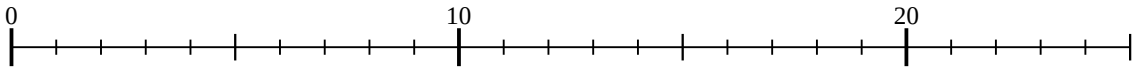

4) 4 × 3 =
3 × 4 =

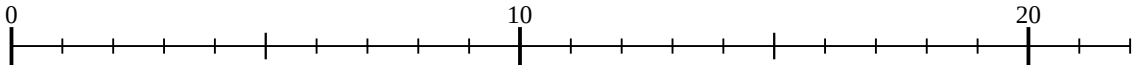

5) 3 × 9 =
9 × 3 =

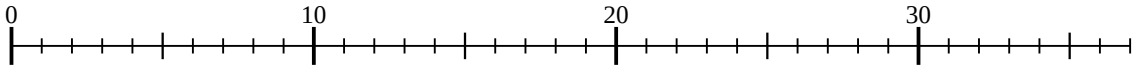

6) 4 × 10 =
10 × 4 =

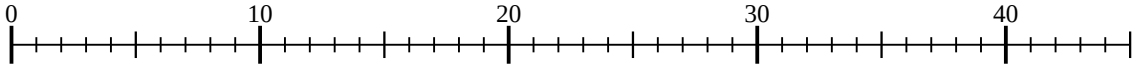

7) 5 × 3 =
3 × 5 =

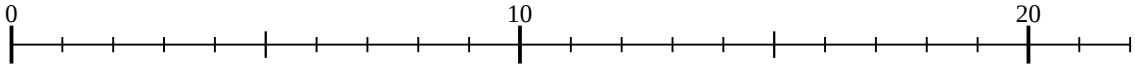

8) 4 × 6 =
6 × 4 =

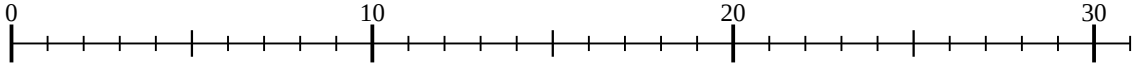

9) 4 × 8 =
8 × 4 =

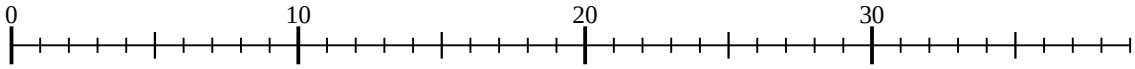

10) 2 × 4 =
4 × 2 =

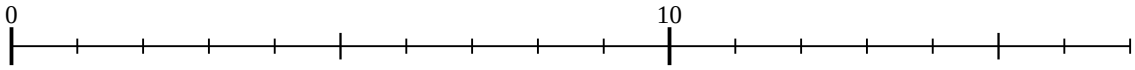

11) 2 × 7 =
7 × 2 =

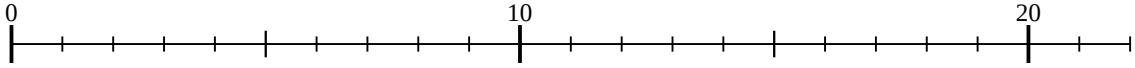

Respuestas

1. _____
2. _____
3. _____
4. _____
5. _____
6. _____
7. _____
8. _____
9. _____
10. _____
11. _____

1-10	91	82	73	64	55	45	36	27	18	9
11	0									

Nombre: **Clave De Respuestas**

Usar la recta numérica para resolver cada problema.

1) 4 × 5 =
5 × 4 =

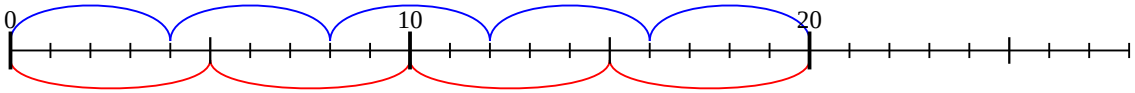

2) 2 × 5 =
5 × 2 =

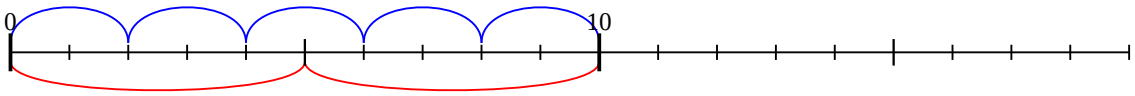

3) 5 × 4 =
4 × 5 =

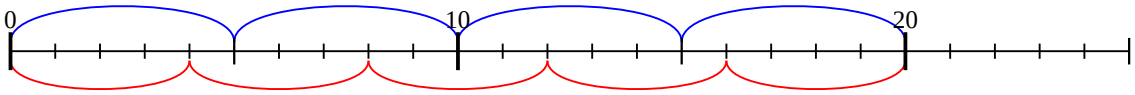

4) 4 × 3 =
3 × 4 =

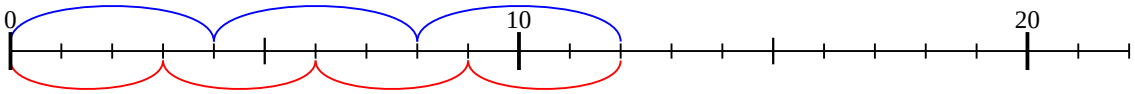

5) 3 × 9 =
9 × 3 =

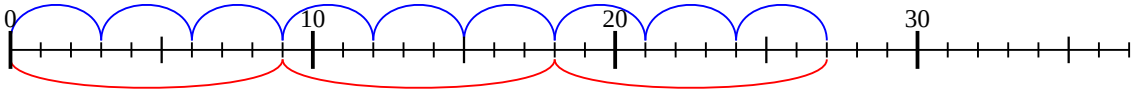

6) 4 × 10 =
10 × 4 =

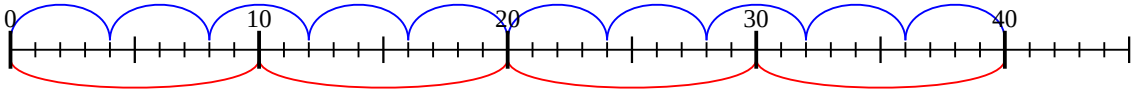

7) 5 × 3 =
3 × 5 =

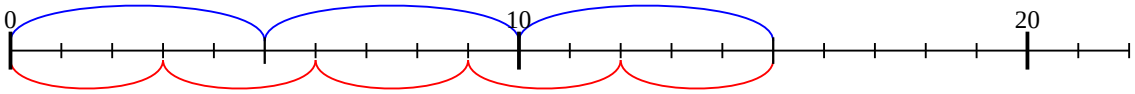

8) 4 × 6 =
6 × 4 =

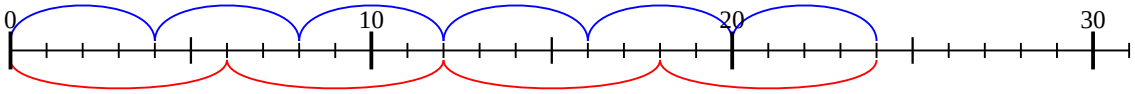

9) 4 × 8 =
8 × 4 =

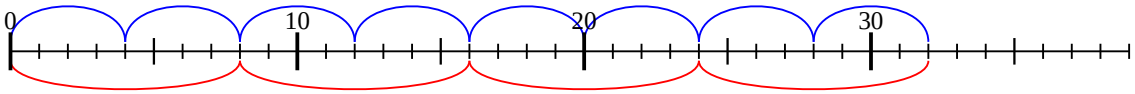

10) 2 × 4 =
4 × 2 =

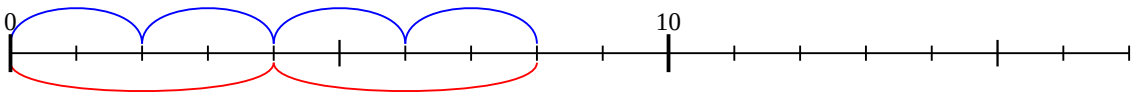

11) 2 × 7 =
7 × 2 =

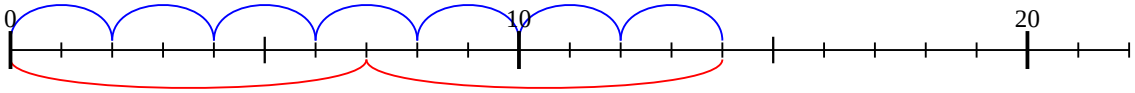

Respuestas

1. **20**
2. **10**
3. **20**
4. **12**
5. **27**
6. **40**
7. **15**
8. **24**
9. **32**
10. **8**
11. **14**

1-10	91	82	73	64	55	45	36	27	18	9
11	0									