Multiplicando con una Recta Numérica

Nombre:

Usar la recta numérica para resolver cada problema.

1) 3 × 5 =

5 × 3 =

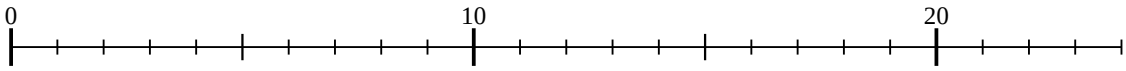

2) 2 × 3 =

3 × 2 =

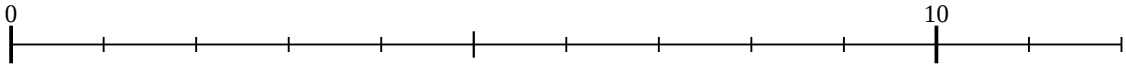

3) 5 × 3 =

3 × 5 =

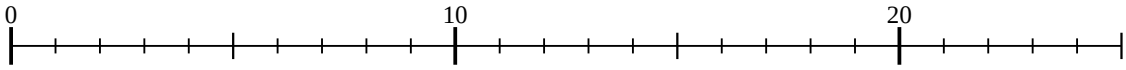

4) 3 × 9 =

9 × 3 =

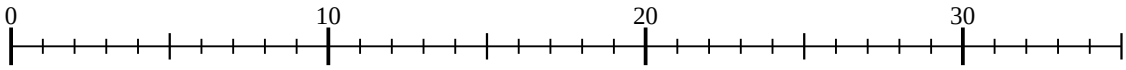

5) 3 × 2 =

2 × 3 =

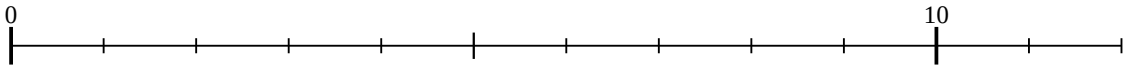

6) 3 × 4 =

4 × 3 =

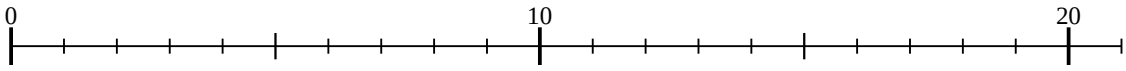

7) 3 × 7 =

7 × 3 =

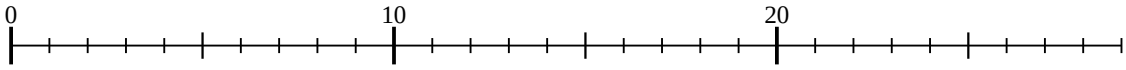

8) 5 × 6 =

6 × 5 =

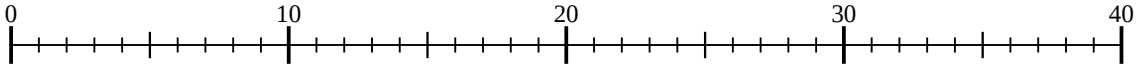

9) 2 × 2 =

2 × 2 =



10) 2 × 6 =

6 × 2 =

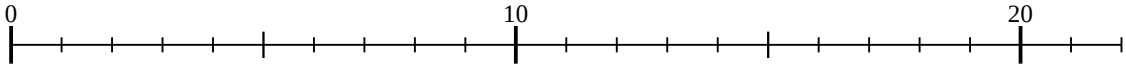

11) 4 × 8 =

8 × 4 =

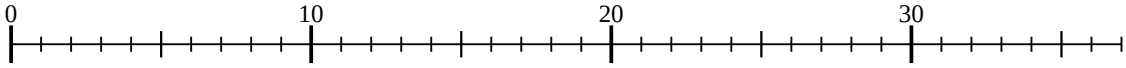

Respuestas

1. _____
2. _____
3. _____
4. _____
5. _____
6. _____
7. _____
8. _____
9. _____
10. _____
11. _____

Multiplicando con una Recta Numérica

Nombre: **Clave De Respuestas**

Usar la recta numérica para resolver cada problema.

1) 3 × 5 =
5 × 3 =

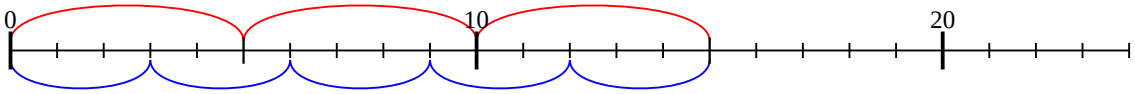

2) 2 × 3 =
3 × 2 =

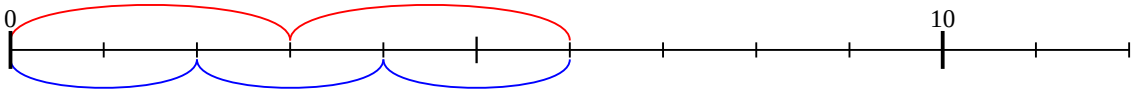

3) 5 × 3 =
3 × 5 =

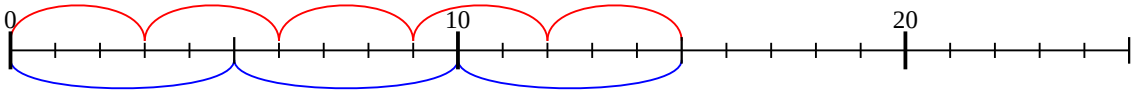

4) 3 × 9 =
9 × 3 =

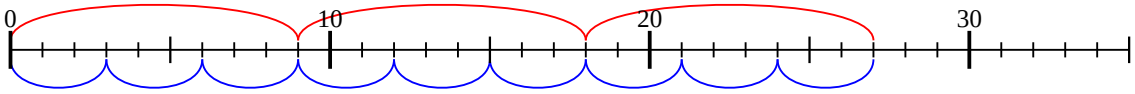

5) 3 × 2 =
2 × 3 =

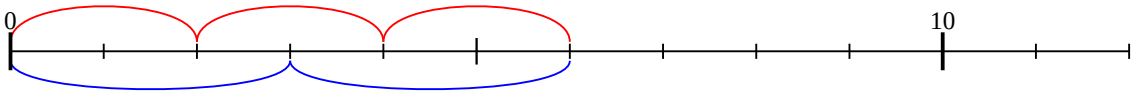

6) 3 × 4 =
4 × 3 =

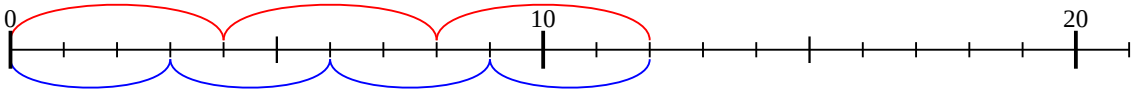

7) 3 × 7 =
7 × 3 =

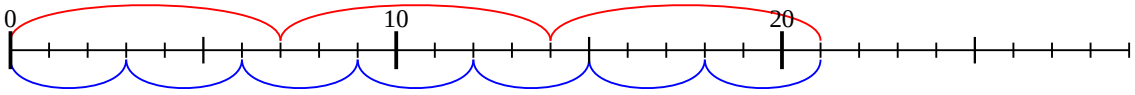

8) 5 × 6 =
6 × 5 =

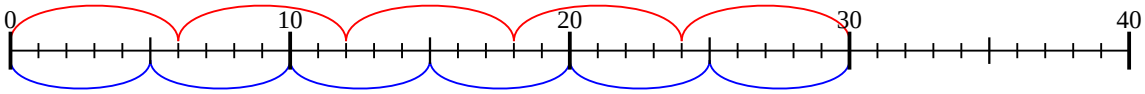

9) 2 × 2 =
2 × 2 =

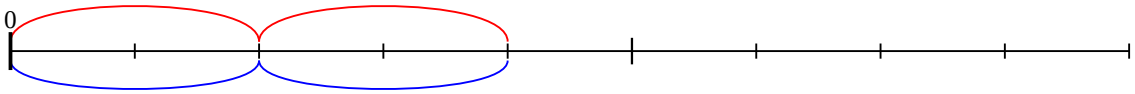

10) 2 × 6 =
6 × 2 =

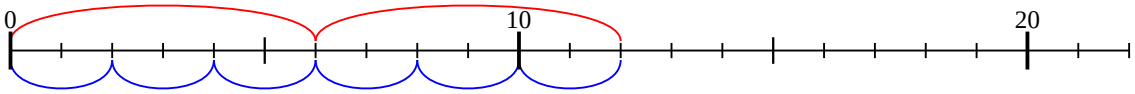

11) 4 × 8 =
8 × 4 =

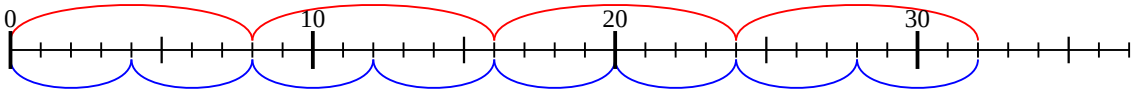

Respuestas

1. **15**
2. **6**
3. **15**
4. **27**
5. **6**
6. **12**
7. **21**
8. **30**
9. **4**
10. **12**
11. **32**