Multiplicando con una Recta Numérica

Nombre:

Usar la recta numérica para resolver cada problema.

1) 4 × 8 =
8 × 4 =

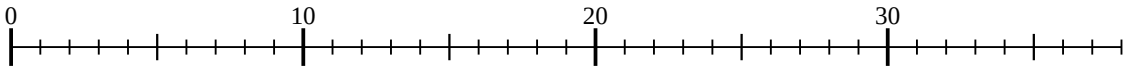

2) 2 × 8 =
8 × 2 =

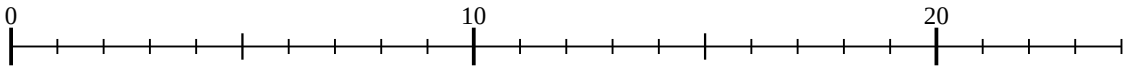

3) 3 × 7 =
7 × 3 =

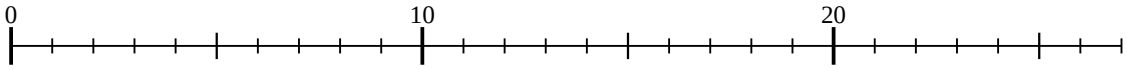

4) 5 × 2 =
2 × 5 =

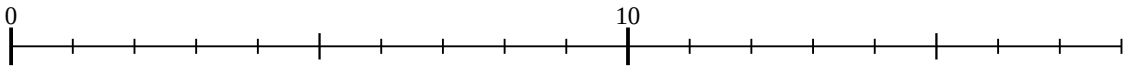

5) 2 × 7 =
7 × 2 =

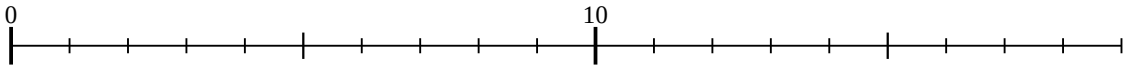

6) 4 × 3 =
3 × 4 =

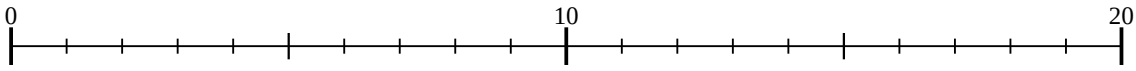

7) 5 × 5 =
5 × 5 =

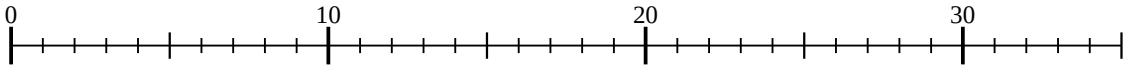

8) 2 × 5 =
5 × 2 =

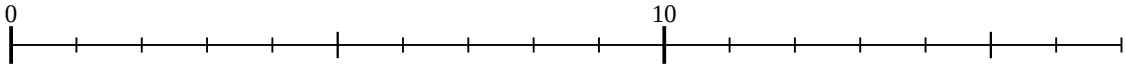

9) 4 × 4 =
4 × 4 =

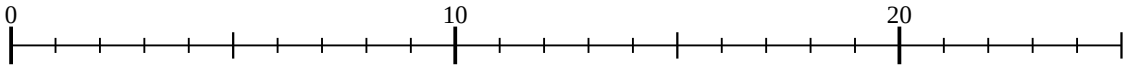

10) 5 × 7 =
7 × 5 =

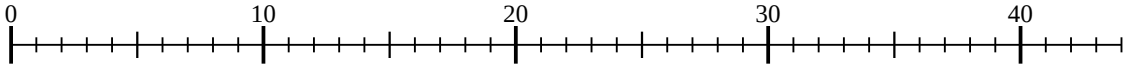

11) 3 × 5 =
5 × 3 =

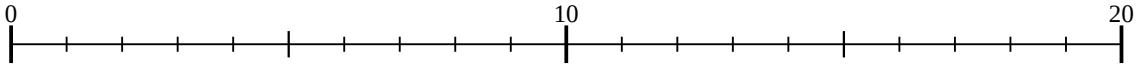

Respuestas

1. _____
2. _____
3. _____
4. _____
5. _____
6. _____
7. _____
8. _____
9. _____
10. _____
11. _____

1-10	91	82	73	64	55	45	36	27	18	9
11	0									

Multiplicando con una Recta Numérica

Nombre: **Clave De Respuestas**

Usar la recta numérica para resolver cada problema.

1) 4 × 8 =
8 × 4 =

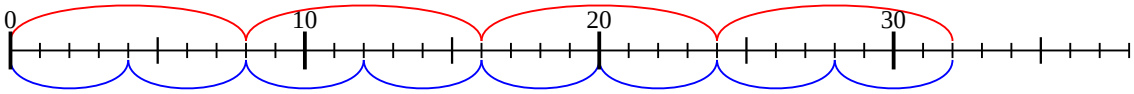

2) 2 × 8 =
8 × 2 =

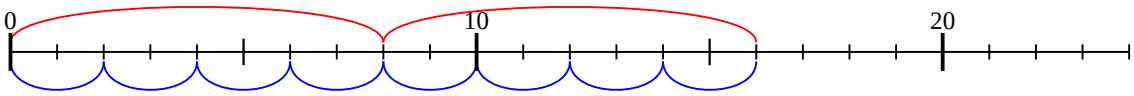

3) 3 × 7 =
7 × 3 =

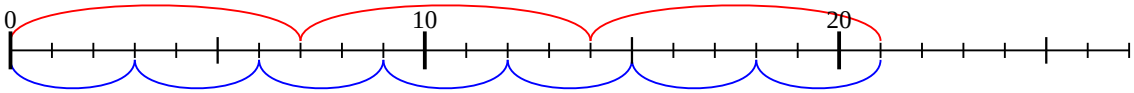

4) 5 × 2 =
2 × 5 =

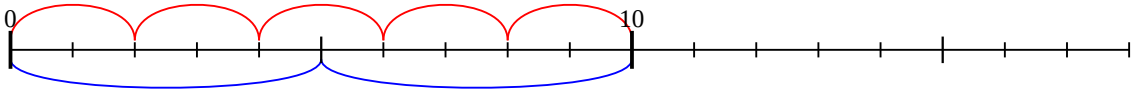

5) 2 × 7 =
7 × 2 =

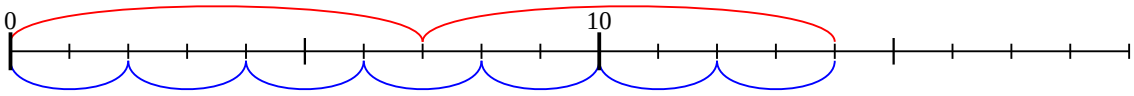

6) 4 × 3 =
3 × 4 =

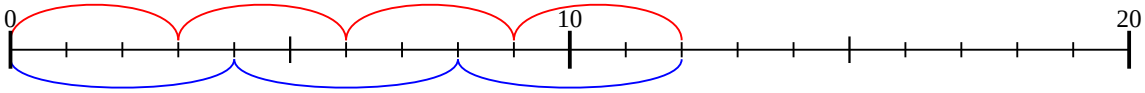

7) 5 × 5 =
5 × 5 =

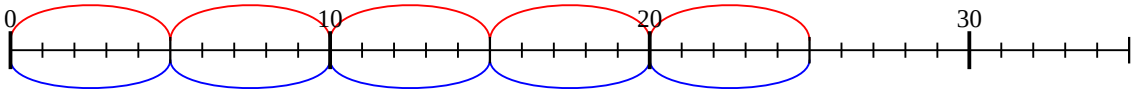

8) 2 × 5 =
5 × 2 =

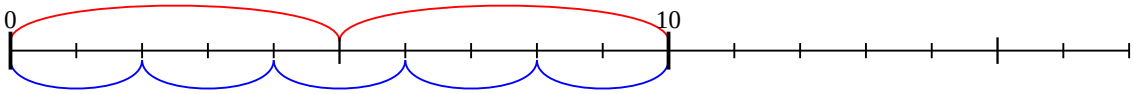

9) 4 × 4 =
4 × 4 =

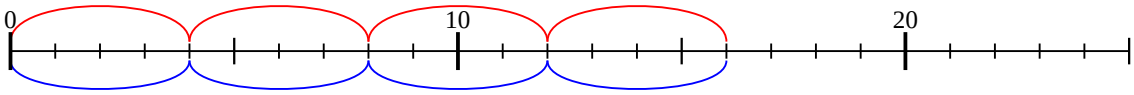

10) 5 × 7 =
7 × 5 =

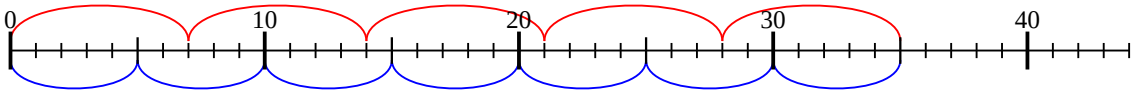

11) 3 × 5 =
5 × 3 =

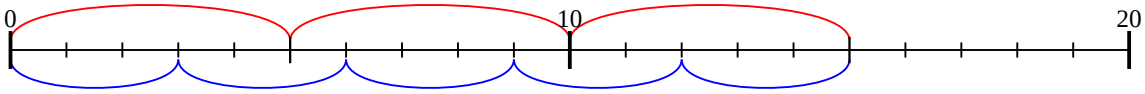

Respuestas

1. **32**
2. **16**
3. **21**
4. **10**
5. **14**
6. **12**
7. **25**
8. **10**
9. **16**
10. **35**
11. **15**

1-10	91	82	73	64	55	45	36	27	18	9
11	0									