Re-escribiendo problemas de multiplicación (Visual)

Nombre:

Escribir cada matriz como un problema de multiplicación y resolver.

Ej) 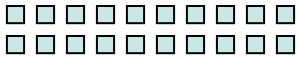

1)

2)

3) 

4)

5) 

6)

7) 

8)

9) 

10) 

11) 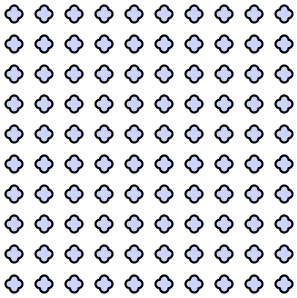

Respuestas

Ej. 2 × 10 = 20

1. _____
2. _____
3. _____
4. _____
5. _____
6. _____
7. _____
8. _____
9. _____
10. _____
11. _____

1-10	91	82	73	64	55	45	36	27	18	9
11	0									

Re-escribiendo problemas de multiplicación (Visual)

Nombre: **Clave De Respuestas**

Escribir cada matriz como un problema de multiplicación y resolver.

Ej) 

1)

2)

3) 

4)

5) 

6)

7) 

8)

9) 

10) 

11) 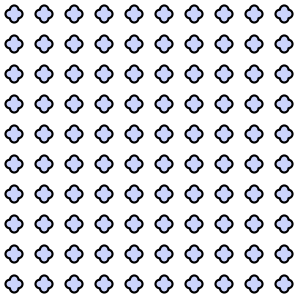

Respuestas

Ej. 2 × 10 = 20

1. 3 × 2 = 6
2. 4 × 10 = 40
3. 6 × 6 = 36
4. 8 × 2 = 16
5. 7 × 6 = 42
6. 3 × 8 = 24
7. 10 × 5 = 50
8. 10 × 3 = 30
9. 8 × 7 = 56
10. 3 × 7 = 21
11. 10 × 10 = 100

1-10	91	82	73	64	55	45	36	27	18	9
11	0									