Re-escribiendo problemas de multiplicación (Visual)

Nombre:

Escribir cada matriz como un problema de multiplicación y resolver.

Ej)



1)



2)

3)



4)



5)

6)

7)



8)

9)



10)



11)



Respuestas

Ej. 6 × 4 = 24

1. _____
2. _____
3. _____
4. _____
5. _____
6. _____
7. _____
8. _____
9. _____
10. _____
11. _____

1-10	91	82	73	64	55	45	36	27	18	9
11	0									

Re-escribiendo problemas de multiplicación (Visual)

Nombre: **Clave De Respuestas**

Escribir cada matriz como un problema de multiplicación y resolver.

Ej)



1)



2)

3)



4)



5)

6)

7)

8)

9)



10)



11)



Respuestas

Ej. 6 × 4 = 24

1. 8 × 6 = 48
2. 6 × 8 = 48
3. 6 × 5 = 30
4. 10 × 6 = 60
5. 3 × 4 = 12
6. 8 × 2 = 16
7. 5 × 4 = 20
8. 3 × 7 = 21
9. 3 × 9 = 27
10. 10 × 5 = 50
11. 7 × 6 = 42

1-10	91	82	73	64	55	45	36	27	18	9
11	0									