Re-escribiendo problemas de multiplicación (Visual)

Nombre:

Escribir cada matriz como un problema de multiplicación y resolver.

Ej) 

1) 

2) 

3) 

4)

5) 

6) 

7)

8) 

9) 

10) 

11)

Respuestas

Ej. 2 × 4 = 8

1. _____
2. _____
3. _____
4. _____
5. _____
6. _____
7. _____
8. _____
9. _____
10. _____
11. _____

1-10	91	82	73	64	55	45	36	27	18	9
11	0									

Re-escribiendo problemas de multiplicación (Visual)

Nombre: **Clave De Respuestas**

Escribir cada matriz como un problema de multiplicación y resolver.

Ej) 

1) 

2) 

3) 

4)

5) 

6) 

7)

8) 

9) 

10) 

11)

Respuestas

Ej. 2 × 4 = 8

1. 7 × 9 = 63
2. 10 × 8 = 80
3. 9 × 4 = 36
4. 2 × 10 = 20
5. 5 × 4 = 20
6. 5 × 7 = 35
7. 3 × 4 = 12
8. 8 × 5 = 40
9. 7 × 7 = 49
10. 10 × 3 = 30
11. 4 × 2 = 8

1-10	91	82	73	64	55	45	36	27	18	9
11	0									