# Re-escribiendo problemas de multiplicación (Visual)

Nombre:

**Escribir cada matriz como un problema de multiplicación y resolver.**

**Ej)** 

**1)** 

**2)**

**3)** 

**4)**

**5)** 

**6)** 

**7)**

**8)**

**9)** 

**10)** 

**11)**

## Respuestas

Ej. 5 × 4 = 20

1. _____
2. _____
3. _____
4. _____
5. _____
6. _____
7. _____
8. _____
9. _____
10. _____
11. _____



| | | | | | | | | | | |
|---|---|---|---|---|---|---|---|---|---|---|
| 1-10 | 91 | 82 | 73 | 64 | 55 | 45 | 36 | 27 | 18 | 9 |
| 11 | 0 | | | | | | | | | |

# Re-escribiendo problemas de multiplicación (Visual)

Nombre: **Clave De Respuestas**

**Escribir cada matriz como un problema de multiplicación y resolver.**

**Ej)**



**1)**



**2)**

**3)**



**4)**

**5)**



**6)**



**7)**

**8)**

**9)**



**10)**



**11)**

## Respuestas

Ej. 5 × 4 = 20

1. 8 × 8 = 64
2. 9 × 10 = 90
3. 5 × 10 = 50
4. 2 × 8 = 16
5. 9 × 7 = 63
6. 9 × 9 = 81
7. 5 × 3 = 15
8. 3 × 6 = 18
9. 5 × 2 = 10
10. 7 × 5 = 35
11. 3 × 5 = 15



| | | | | | | | | | | |
|---|---|---|---|---|---|---|---|---|---|---|
| 1-10 | 91 | 82 | 73 | 64 | 55 | 45 | 36 | 27 | 18 | 9 |
| 11 | 0 | | | | | | | | | |