Re-escribiendo problemas de multiplicación (Visual)

Nombre:

Escribir cada matriz como un problema de multiplicación y resolver.

Ej) 

1) 

2)

3) 

4)

5) 

6) 

7)

8)

9) 

10)

11)

Respuestas

Ej. 2 × 6 = 12

1. _____
2. _____
3. _____
4. _____
5. _____
6. _____
7. _____
8. _____
9. _____
10. _____
11. _____

1-10	91	82	73	64	55	45	36	27	18	9
11	0									

Re-escribiendo problemas de multiplicación (Visual) Nombre: **Clave De Respuestas**

Escribir cada matriz como un problema de multiplicación y resolver.

Ej) 

1) 

2)

3) 

4)

5) 

6) 

7)

8)

9) 

10)

11)

Respuestas

Ej. 2 × 6 = 12

1. 6 × 7 = 42
2. 3 × 4 = 12
3. 10 × 5 = 50
4. 3 × 2 = 6
5. 6 × 9 = 54
6. 7 × 10 = 70
7. 3 × 3 = 9
8. 4 × 2 = 8
9. 3 × 8 = 24
10. 5 × 5 = 25
11. 8 × 4 = 32

1-10	91	82	73	64	55	45	36	27	18	9
11	0									