Máquinas de Funciones - (Sumar y Restar) Nombre:

Determina la regla que cada máquina de función está usando.

Ej)

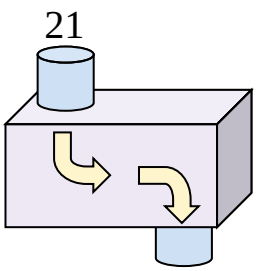

Restar 9

1)

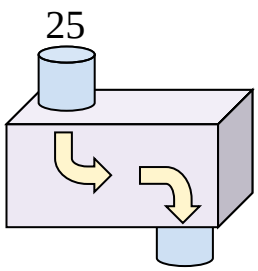

2)

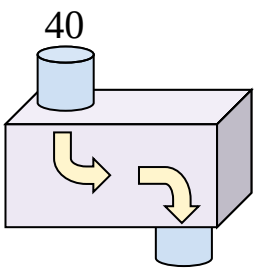

3)

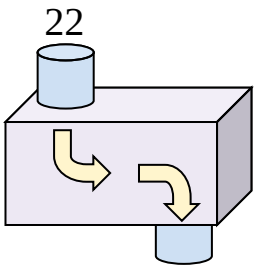

4)

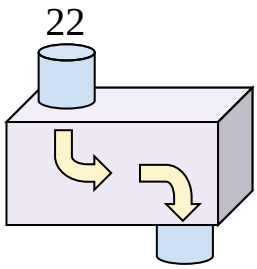

5)

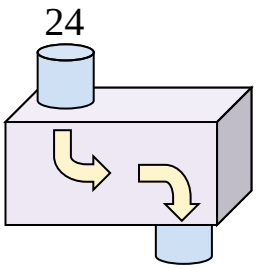

6)

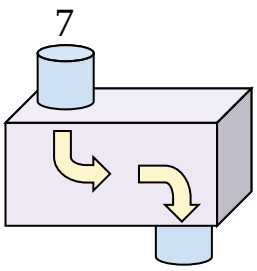

7)

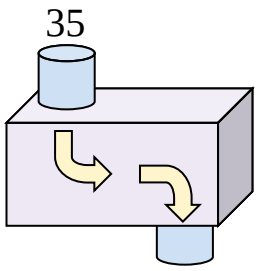

8)

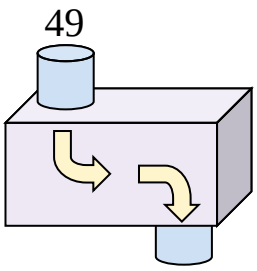

9)

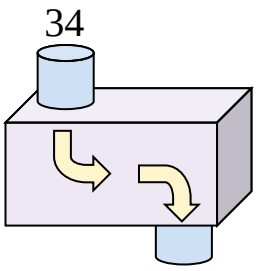

10)

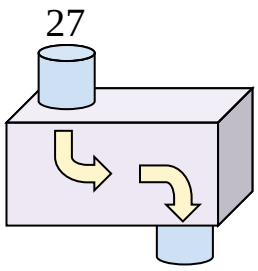

11)

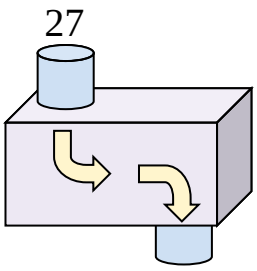

Respuestas

Ej. Restar 9

1. _____
2. _____
3. _____
4. _____
5. _____
6. _____
7. _____
8. _____
9. _____
10. _____
11. _____

1-10	91	82	73	64	55	45	36	27	18	9
11	0									

Máquinas de Funciones - (Sumar y Restar)

Nombre: **Clave De Respuestas**

Determina la regla que cada máquina de función está usando.

Ej)

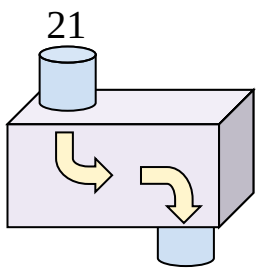

Restar 9

1)

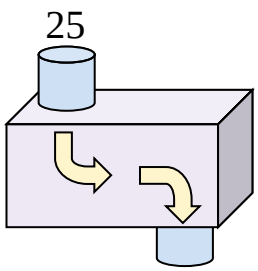

Sumar 23

2)

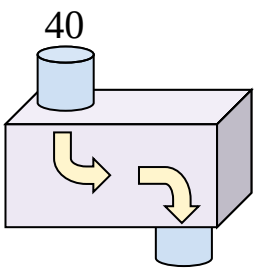

Restar 10

3)

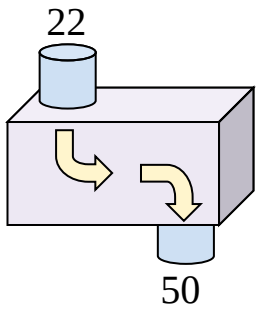

Sumar 28

4)

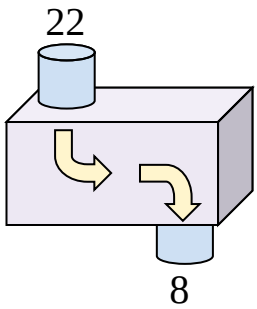

Restar 14

5)

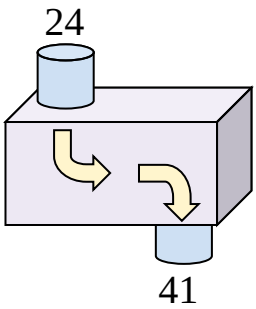

Sumar 17

6)

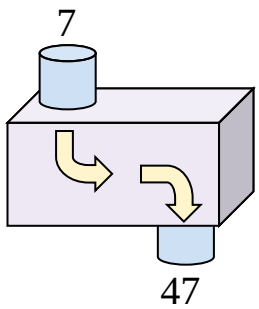

Sumar 40

7)

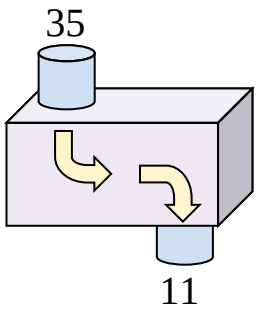

Restar 24

8)

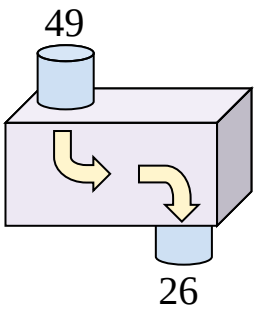

Restar 23

9)

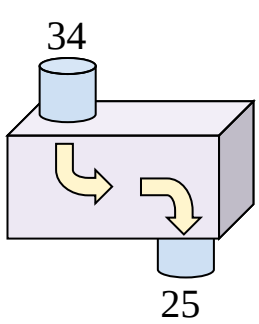

Restar 9

10)

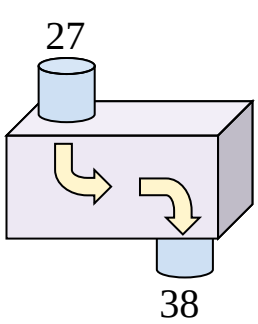

Sumar 11

11)

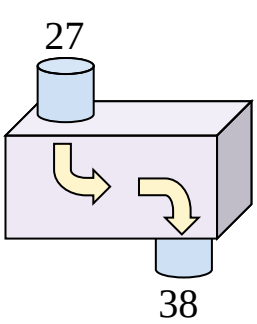

Sumar 11

Respuestas

Ej.	Restar 9
1.	Sumar 23
2.	Restar 10
3.	Sumar 28
4.	Restar 14
5.	Sumar 17
6.	Sumar 40
7.	Restar 24
8.	Restar 23
9.	Restar 9
10.	Sumar 11
11.	Sumar 11

1-10	91	82	73	64	55	45	36	27	18	9
11	0									