Máquinas de Funciones - (Sumar y Restar) Nombre:

Determina la regla que cada máquina de función está usando.

Ej)

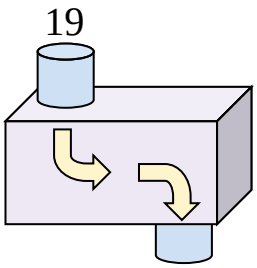

Restar 6

1)

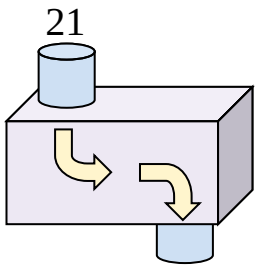

2)

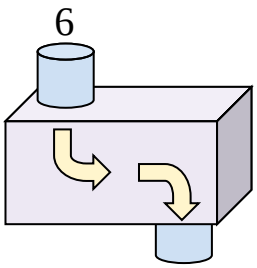

3)

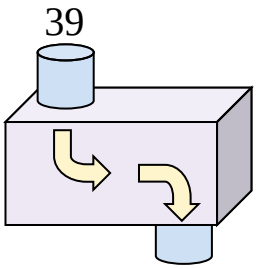

4)

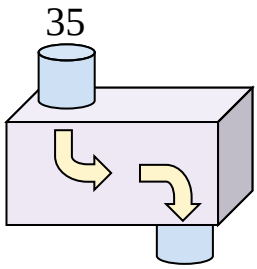

5)

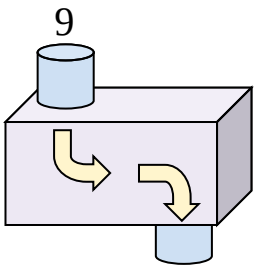

6)

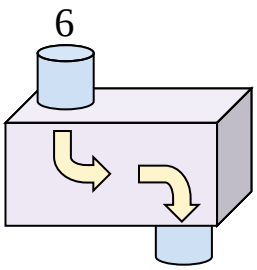

7)

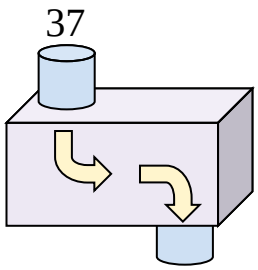

8)

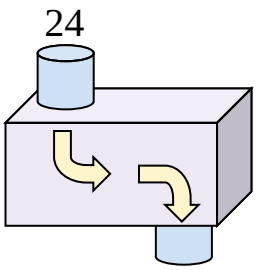

9)

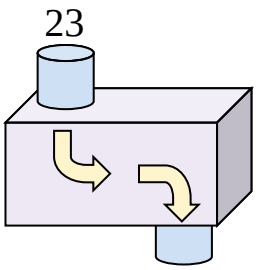

10)

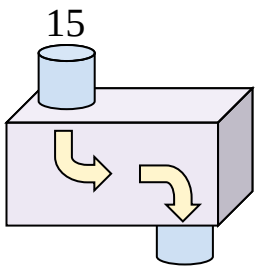

11)

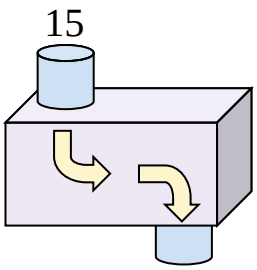

Respuestas

Ej. Restar 6

1. _____
2. _____
3. _____
4. _____
5. _____
6. _____
7. _____
8. _____
9. _____
10. _____
11. _____

1-10	91	82	73	64	55	45	36	27	18	9
11	0									

Determina la regla que cada máquina de función está usando.

Ej)

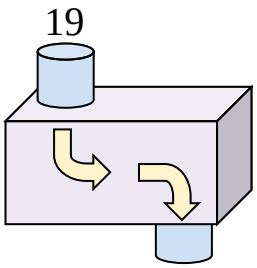

Restar 6

1)

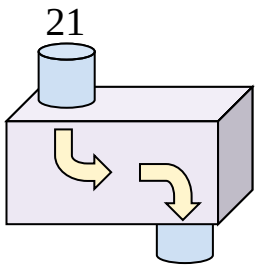

Restar 8

2)

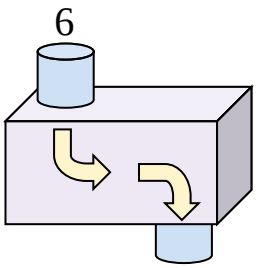

Sumar 42

3)

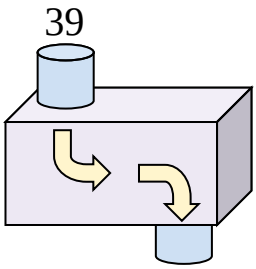

Restar 10

4)

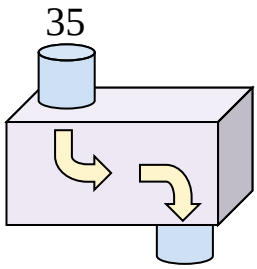

Restar 22

5)

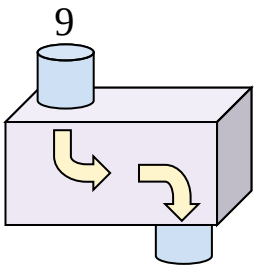

Sumar 15

6)

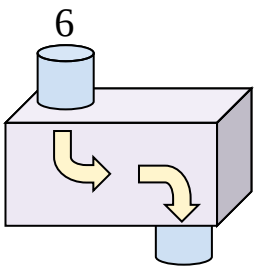

Sumar 20

7)

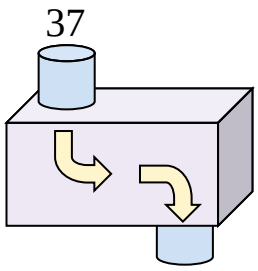

Restar 15

8)

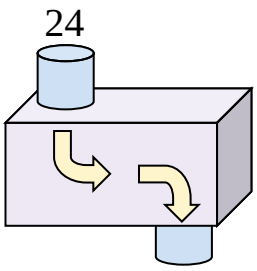

Sumar 19

9)

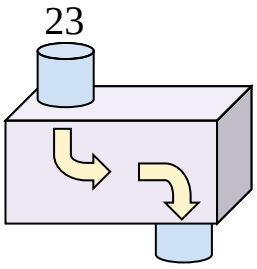

Sumar 18

10)

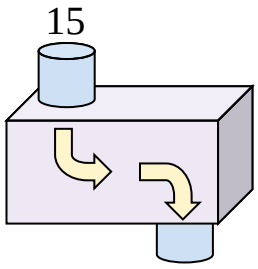

Sumar 32

11)

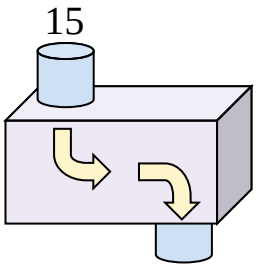

Sumar 32

Respuestas

Ej. Restar 6

1. Restar 8
2. Sumar 42
3. Restar 10
4. Restar 22
5. Sumar 15
6. Sumar 20
7. Restar 15
8. Sumar 19
9. Sumar 18
10. Sumar 32
11. Sumar 32

1-10	91	82	73	64	55	45	36	27	18	9
11	0									