Determina la regla que cada máquina de función está usando.

Ej)

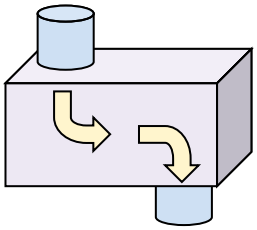

Sumar 25

1)

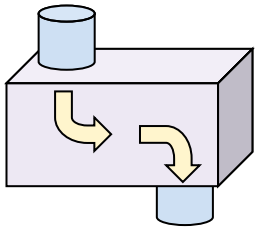

2)

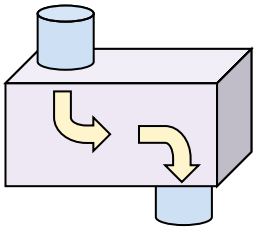

3)

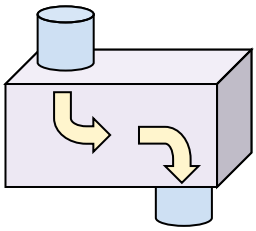

4)

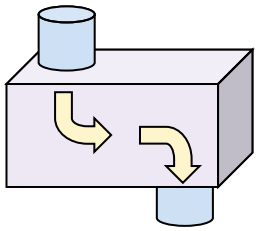

5)

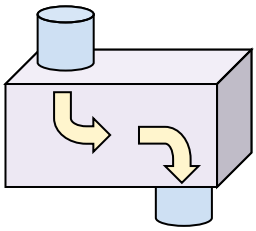

6)

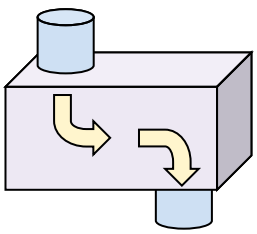

7)

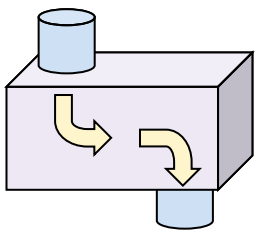

8)

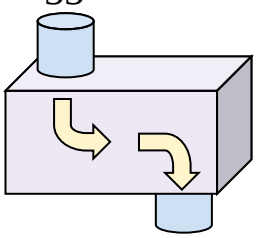

9)

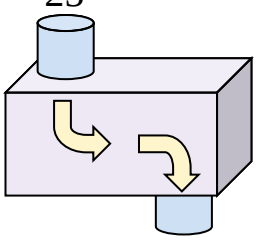

10)

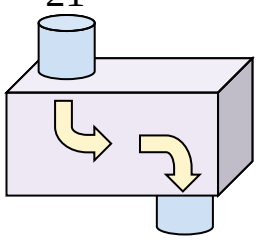

11)

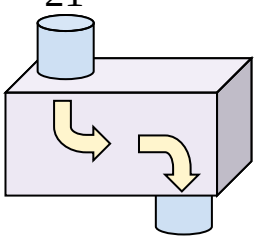

Respuestas

Ej. Sumar 25

1. _____
2. _____
3. _____
4. _____
5. _____
6. _____
7. _____
8. _____
9. _____
10. _____
11. _____

1-10	91	82	73	64	55	45	36	27	18	9
11	0									

Nombre: **Clave De Respuestas**

Determina la regla que cada máquina de función está usando.

Ej)

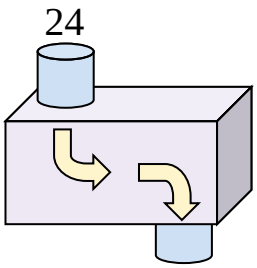

Sumar 25

1)

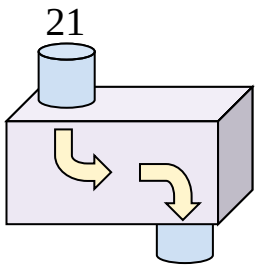

Restar 15

2)

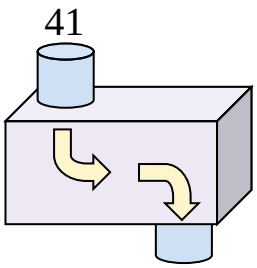

Restar 11

3)

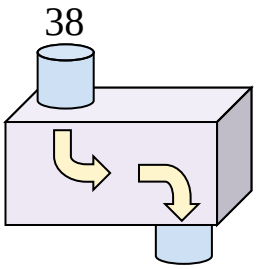

Restar 18

4)

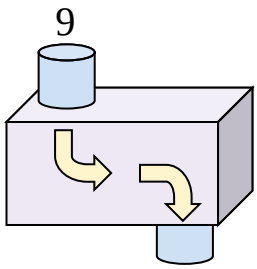

Sumar 12

5)

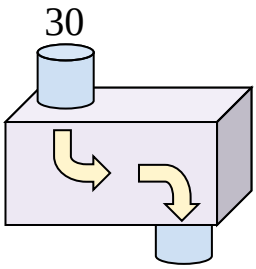

Sumar 10

6)

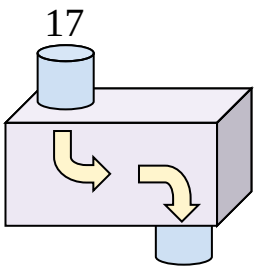

Sumar 27

7)

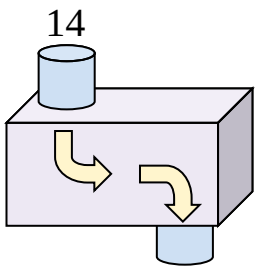

Sumar 5

8)

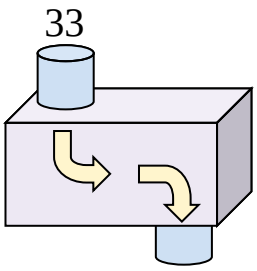

Restar 6

9)

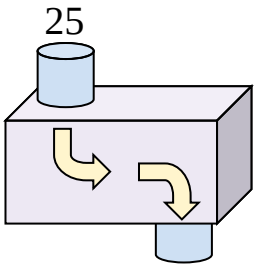

Restar 13

10)

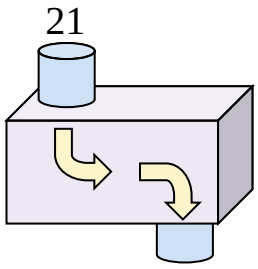

Sumar 20

11)

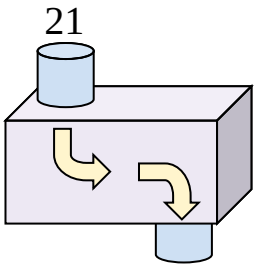

Sumar 20

Respuestas

Ej.	Sumar 25
1.	Restar 15
2.	Restar 11
3.	Restar 18
4.	Sumar 12
5.	Sumar 10
6.	Sumar 27
7.	Sumar 5
8.	Restar 6
9.	Restar 13
10.	Sumar 20
11.	Sumar 20

1-10	91	82	73	64	55	45	36	27	18	9
11	0									