# Valor posicional visual (Menos de 20)

Nombre:

**Rellenar los espacions para encontrar las cantidades.**

**Ej)**

0 decenas 4 unidades

**1)** 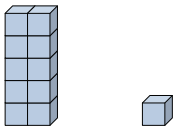

_____ decenas _____ unidades

**2)** 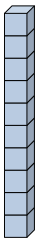

_____ decenas _____ unidades

**3)** 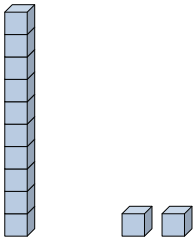

_____ decenas _____ unidades

**4)**

_____ decenas _____ unidades

**5)** 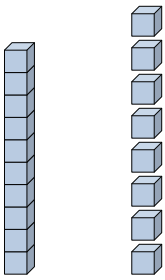

_____ decenas _____ unidades

**6)** 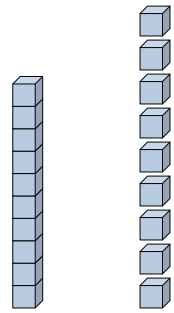

_____ decenas _____ unidades

**7)** 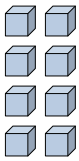

_____ decenas _____ unidades

**8)** 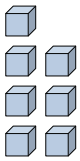

_____ decenas _____ unidades

**9)** 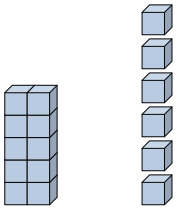

_____ decenas _____ unidades

**10)**

_____ decenas _____ unidades

**11)** 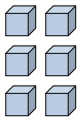

_____ decenas _____ unidades

## Respuestas

Ej. 4

1. _____
2. _____
3. _____
4. _____
5. _____
6. _____
7. _____
8. _____
9. _____
10. _____
11. _____

Valor posicional visual (Menos de 20) Nombre: **Clave De Respuestas**

**Rellenar los espacions para encontrar las cantidades.**

**Ej)**
0 decenas, 4 unidades

**1)** 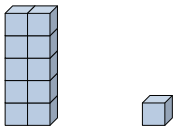
1 decenas, 1 unidades

**2)** 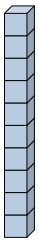
1 decenas, 0 unidades

**3)** 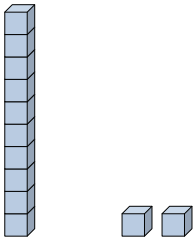
1 decenas, 2 unidades

**4)**
0 decenas, 3 unidades

**5)** 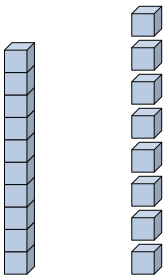
1 decenas, 8 unidades

**6)** 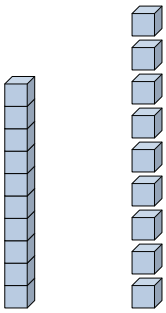
1 decenas, 9 unidades

**7)** 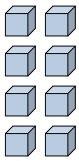
0 decenas, 8 unidades

**8)** 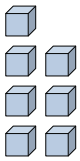
0 decenas, 7 unidades

**9)** 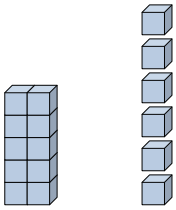
1 decenas, 6 unidades

**10)**
0 decenas, 2 unidades

**11)** 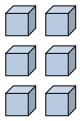
0 decenas, 6 unidades

**Respuestas**

| | |
|---|---|
| Ej. | 4 |
| 1. | 11 |
| 2. | 10 |
| 3. | 12 |
| 4. | 3 |
| 5. | 18 |
| 6. | 19 |
| 7. | 8 |
| 8. | 7 |
| 9. | 16 |
| 10. | 2 |
| 11. | 6 |



| | | | | | | | | | | |
|---|---|---|---|---|---|---|---|---|---|---|
| 1-10 | 91 | 82 | 73 | 64 | 55 | 45 | 36 | 27 | 18 | 9 |
| 11 | 0 | | | | | | | | | |