Crear de triángulos Nombre:

Utiliza un transportador para crear un triángulo a partir de la figura que se muestra. Responde con los ángulos que faltan. Las respuestas variarán.

1)

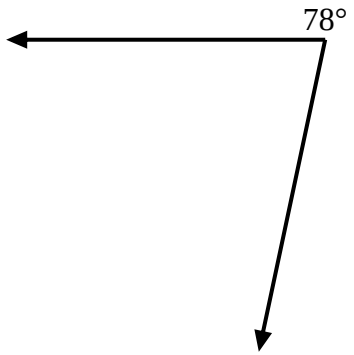

2)

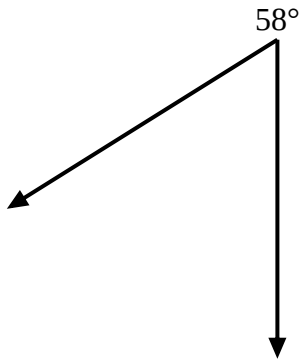

3)

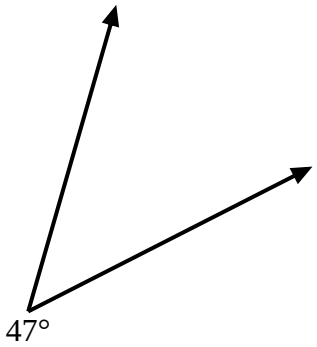

4)

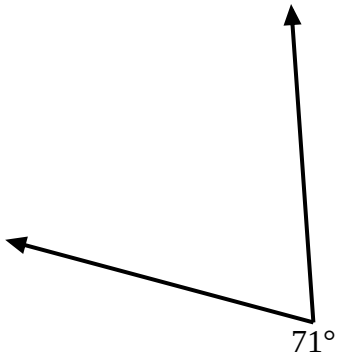

5)

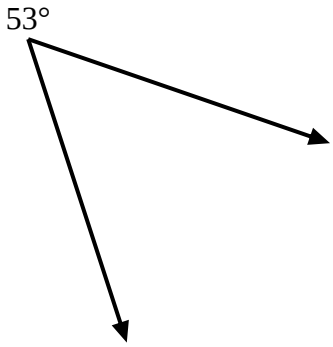

6)

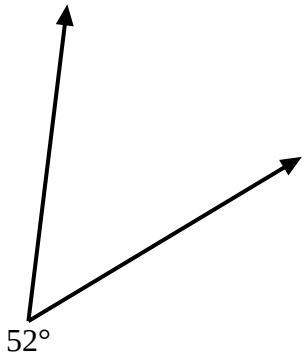

7)

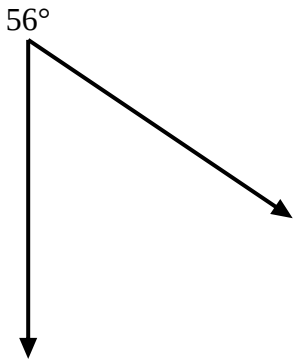

8)

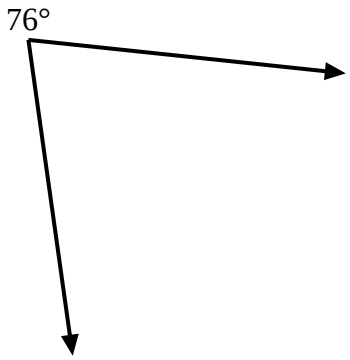

Respuestas

1. _____
2. _____
3. _____
4. _____
5. _____
6. _____
7. _____
8. _____

1-8	88	75	63	50	38	25	13	0

Utiliza un transportador para crear un triángulo a partir de la figura que se muestra. Responde con los ángulos que faltan. Las respuestas variarán.

1)

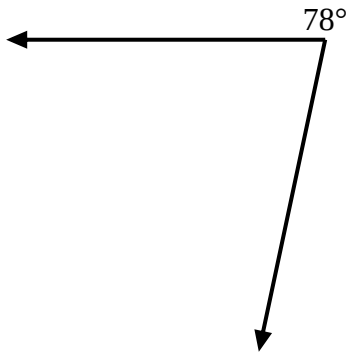

2)

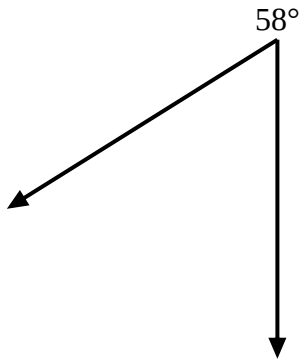

3)

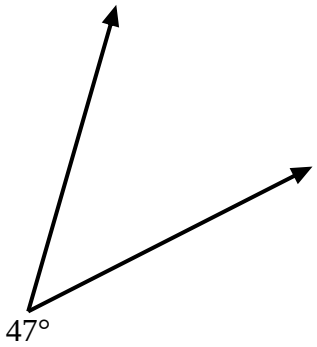

4)

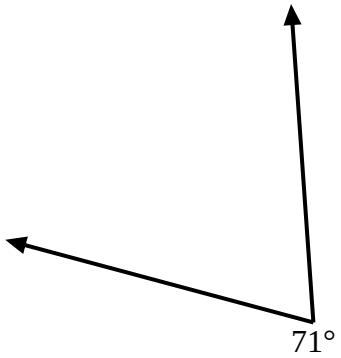

5)

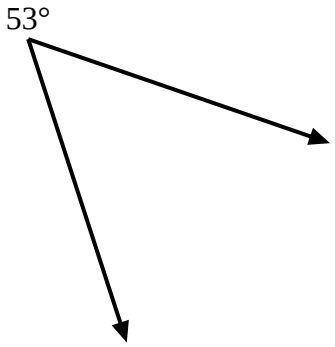

6)

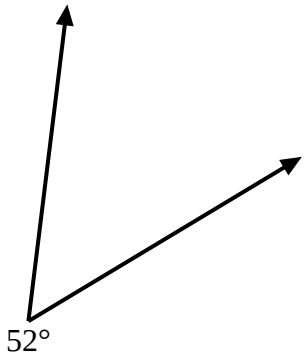

7)

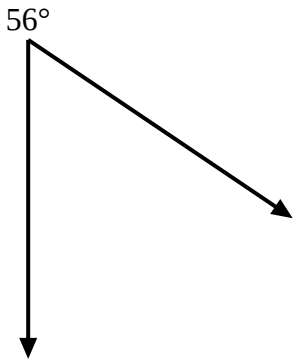

8)

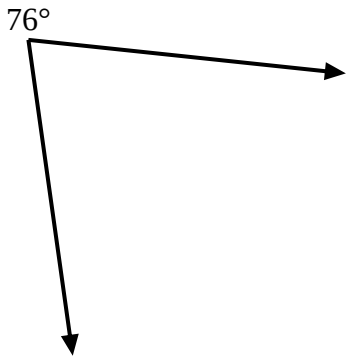

Respuestas

1. =102
2. =122
3. =133
4. =109
5. =127
6. =128
7. =124
8. =104

1-8	88	75	63	50	38	25	13	0