Encontrando el ángulo faltante

Nombre:

Determina el valor de 'A'.

1)

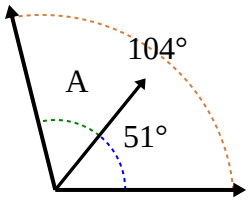

2)

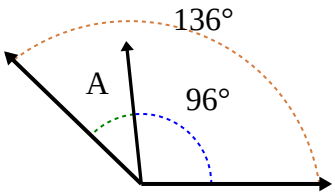

3)

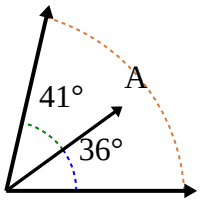

4)

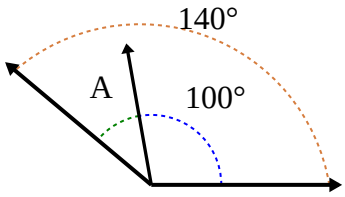

5)

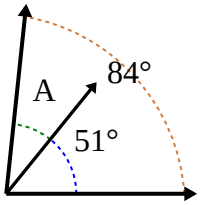

6)

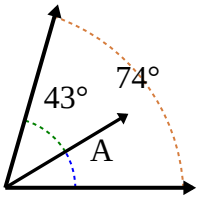

7)

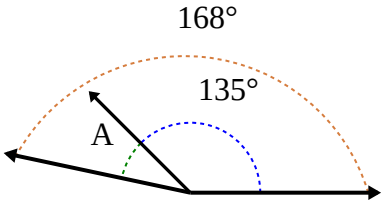

8)

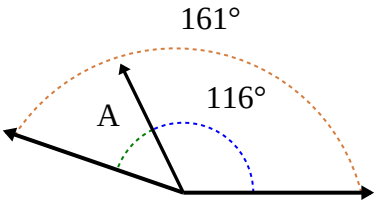

9)

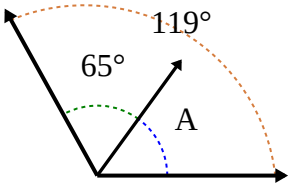

10)

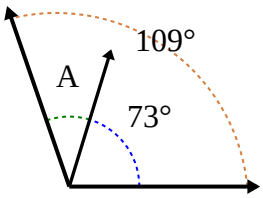

11)

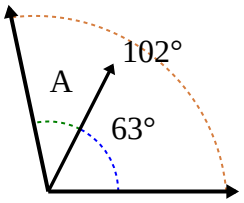

12)

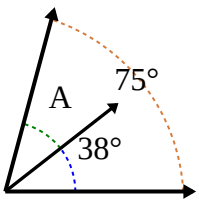

Respuestas

1. _____
2. _____
3. _____
4. _____
5. _____
6. _____
7. _____
8. _____
9. _____
10. _____
11. _____
12. _____

1-10	92	83	75	67	58	50	42	33	25	17
11-12	8	0								

Determina el valor de 'A'.

1)

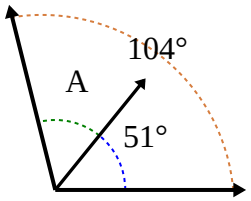

2)

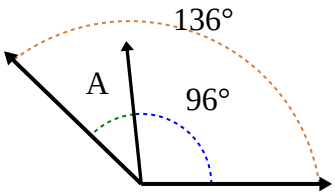

3)

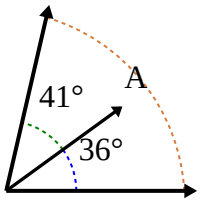

4)

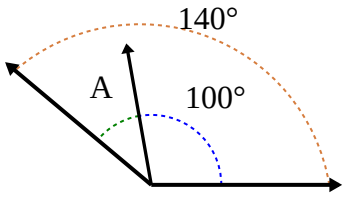

5)

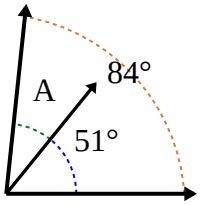

6)

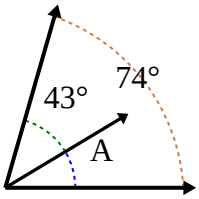

7)

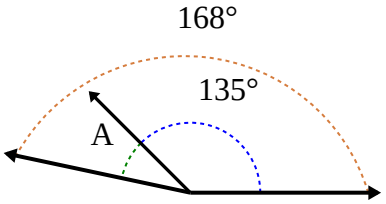

8)

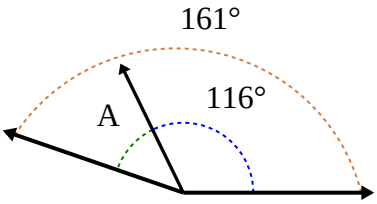

9)

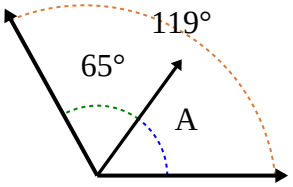

10)

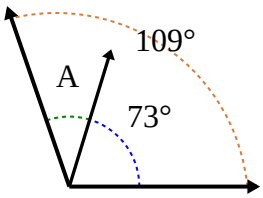

11)

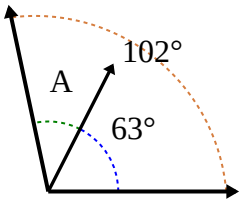

12)

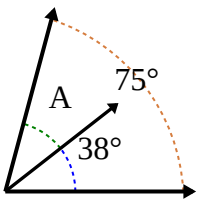

Respuestas

1. **53**
2. **40**
3. **77**
4. **40**
5. **33**
6. **31**
7. **33**
8. **45**
9. **54**
10. **36**
11. **39**
12. **37**

1-10	92	83	75	67	58	50	42	33	25	17
11-12	8	0								