Completar y emparejar ecuaciones de volumen Nombre:

Empareje cada problema con la ecuación que podría representarlo. Responda con el término y la letra que faltan.

Ej) 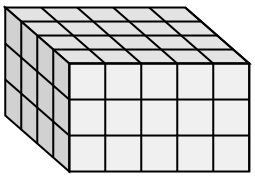

1) 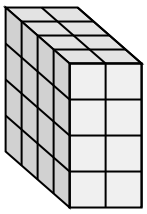

2) 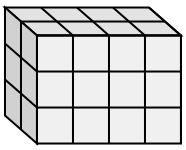

3) 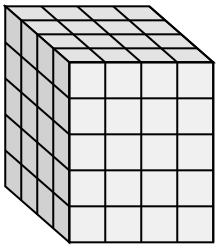

4) 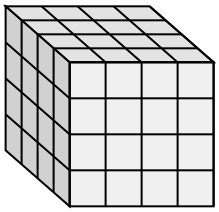

5) 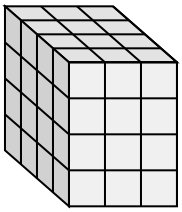

6) 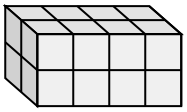

7) 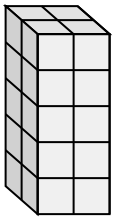

8) 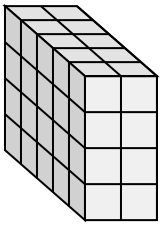

9) 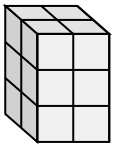

10) 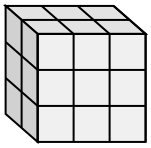

11) 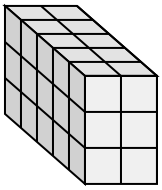

A. 2 × 2 × 3 = ___

B. ___ × 2 × 4 = 40

C. 2 × 3 × ___ = 18

D. 2 × 4 × ___ = 24

E. 4 × 5 × 3 = ___

F. 2 × 2 × 5 = ___

G. 4 × ___ × 4 = 64

H. ___ × 4 × 2 = 16

I. 4 × 4 × ___ = 80

J. ___ × 3 × 4 = 48

K. 4 × 2 × 4 = ___

L. 5 × ___ × 3 = 30

Respuestas

Ej. **E , 60**

1. _____
2. _____
3. _____
4. _____
5. _____
6. _____
7. _____
8. _____
9. _____
10. _____
11. _____

1-10	91	82	73	64	55	45	36	27	18	9
11	0									

Completar y emparejar ecuaciones de volumen Nombre: **Clave De Respuestas**

Empareje cada problema con la ecuación que podría representarlo. Responda con el término y la letra que faltan.

Ej) 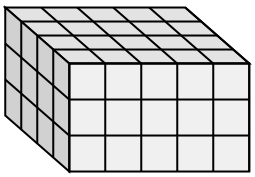

1) 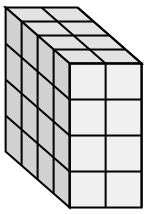

2) 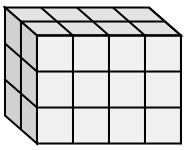

3) 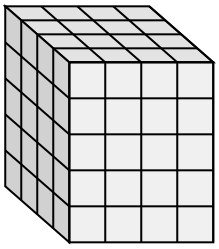

4) 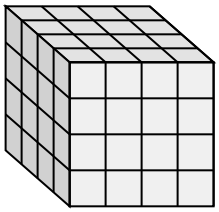

5) 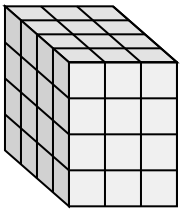

6) 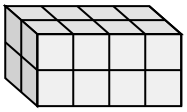

7) 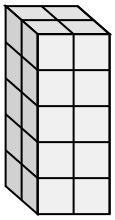

8) 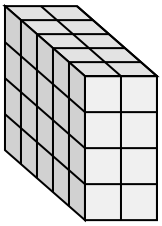

9) 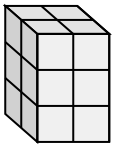

10) 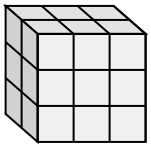

11) 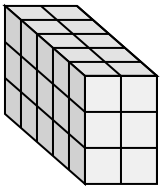

A. 2 × 2 × 3 = ___

B. ___ × 2 × 4 = 40

C. 2 × 3 × ___ = 18

D. 2 × 4 × ___ = 24

E. 4 × 5 × 3 = ___

F. 2 × 2 × 5 = ___

G. 4 × ___ × 4 = 64

H. ___ × 4 × 2 = 16

I. 4 × 4 × ___ = 80

J. ___ × 3 × 4 = 48

K. 4 × 2 × 4 = ___

L. 5 × ___ × 3 = 30

Respuestas

Ej. **E , 60**

1. **K , 32**
2. **D , 3**
3. **I , 5**
4. **G , 4**
5. **J , 4**
6. **H , 2**
7. **F , 20**
8. **B , 5**
9. **A , 12**
10. **C , 3**
11. **L , 2**

1-10	91	82	73	64	55	45	36	27	18	9
11	0									