Completar y emparejar ecuaciones de volumen Nombre:

Empareje cada problema con la ecuación que podría representarlo. Responda con el término y la letra que faltan.

Ej) 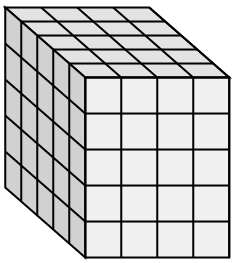

1) 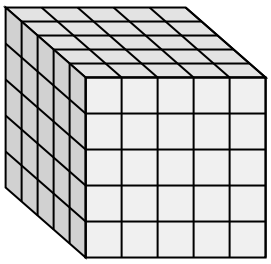

2) 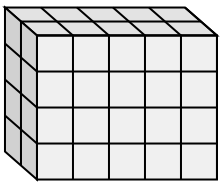

3) 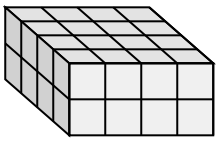

4) 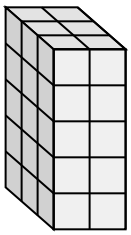

5) 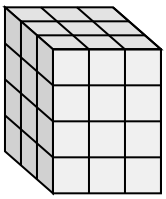

6) 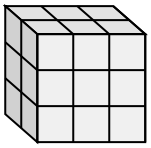

7) 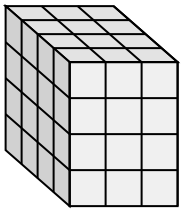

8) 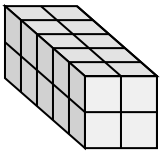

9) 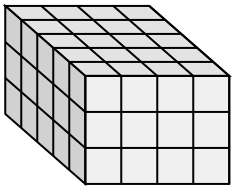

10) 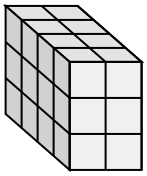

11) 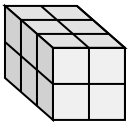

A. ___ × 2 × 2 = 20

B. ___ × 5 × 4 = 40

C. 3 × 2 × ___ = 30

D. 5 × ___ × 3 = 60

E. ___ × 4 × 2 = 32

F. ___ × 2 × 3 = 24

G. 4 × ___ × 4 = 48

H. 5 × 4 × ___ = 100

I. ___ × 3 × 4 = 36

J. 3 × 2 × ___ = 12

K. 2 × ___ × 3 = 18

L. 5 × ___ × 5 = 125

Respuestas

Ej. H , 5

1. _____
2. _____
3. _____
4. _____
5. _____
6. _____
7. _____
8. _____
9. _____
10. _____
11. _____

1-10	91	82	73	64	55	45	36	27	18	9
11	0									

Completar y emparejar ecuaciones de volumen

Nombre: **Clave De Respuestas**

Empareje cada problema con la ecuación que podría representarlo. Responda con el término y la letra que faltan.

Ej)

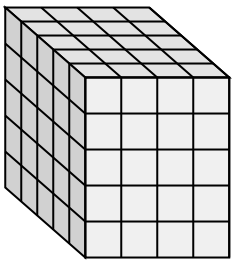

1)

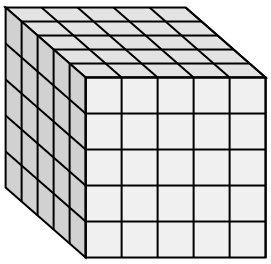

2)

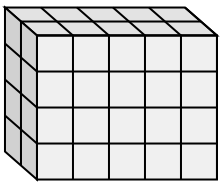

3)

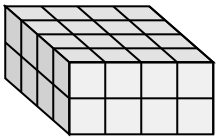

4)

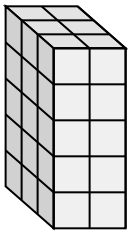

5)

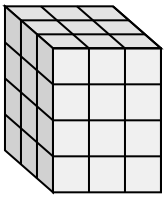

6)

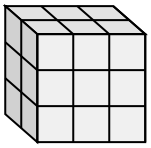

7)

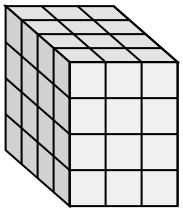

8)

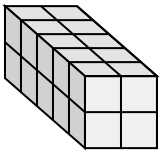

9)

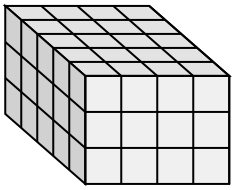

10)

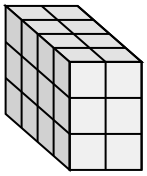

11)

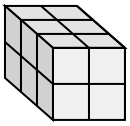

A. ___ × 2 × 2 = 20

B. ___ × 5 × 4 = 40

C. 3 × 2 × ___ = 30

D. 5 × ___ × 3 = 60

E. ___ × 4 × 2 = 32

F. ___ × 2 × 3 = 24

G. 4 × ___ × 4 = 48

H. 5 × 4 × ___ = 100

I. ___ × 3 × 4 = 36

J. 3 × 2 × ___ = 12

K. 2 × ___ × 3 = 18

L. 5 × ___ × 5 = 125

Respuestas

Ej.	H , 5
1.	L , 5
2.	B , 2
3.	E , 4
4.	C , 5
5.	I , 3
6.	K , 3
7.	G , 3
8.	A , 5
9.	D , 4
10.	F , 4
11.	J , 2