Usando cubos de unidades para determinar el volumen Nombre:

Rellenar cada prisma rectangular con cubos para determinar el volumen. Cada unidad de primsa es medida en cm (no a escala).

Ej)

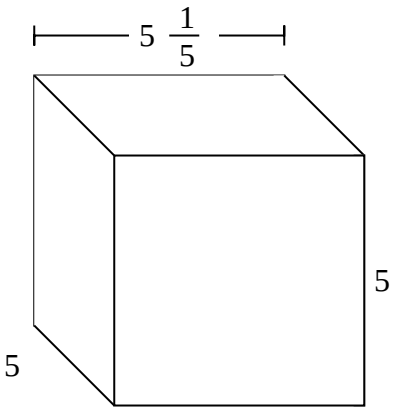

1)

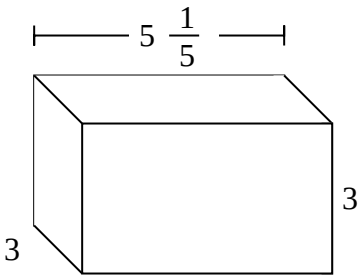

2)

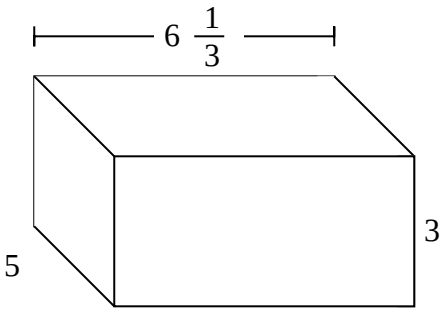

3)

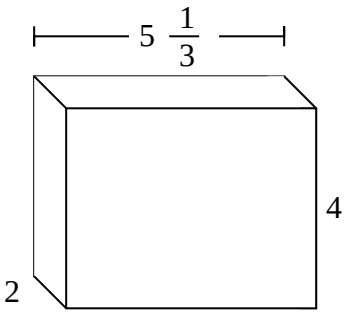

4)

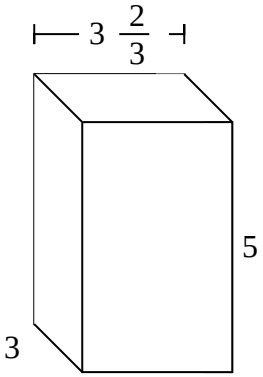

5)

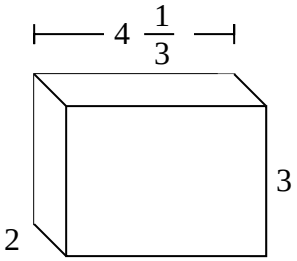

6)

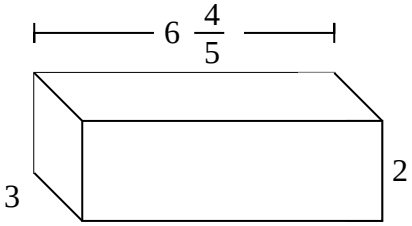

7)

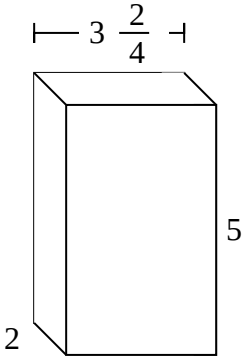

Respuestas

Ej. 130 cm

1. _____

2. _____

3. _____

4. _____

5. _____

6. _____

7. _____

1-7	86	71	57	43	29	14	0

Usando cubos de unidades para determinar el volumen Nombre: **Clave De Respuestas**

Rellenar cada prisma rectangular con cubos para determinar el volumen. Cada unidad de primsa es medida en cm (no a escala).

Ej)

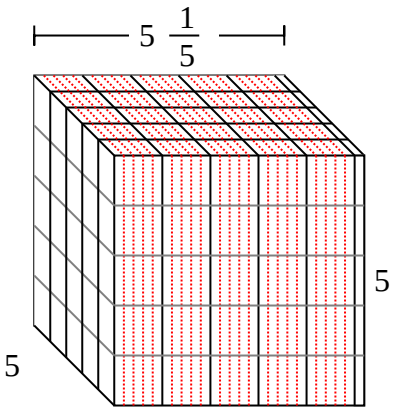

1)

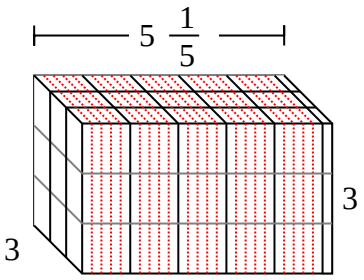

2)

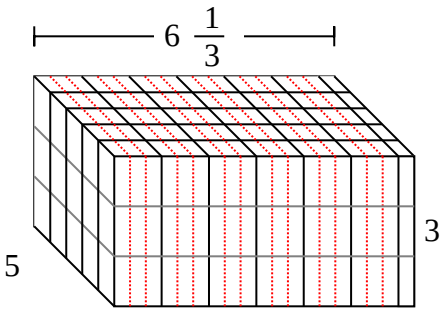

3)

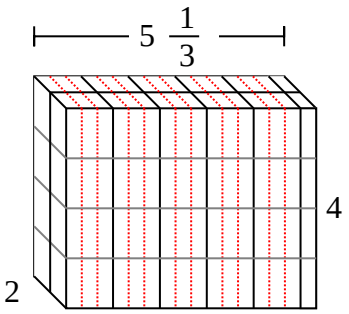

4)

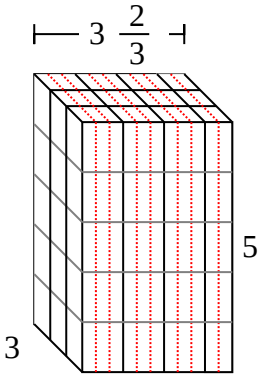

5)

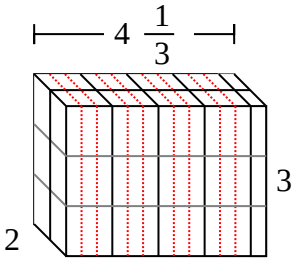

6)

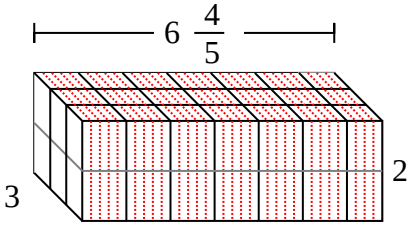

7)

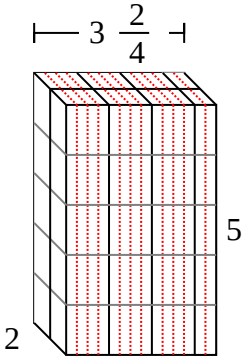

Respuestas

Ej.	130 cm
1.	$46\ ^{4}/_{5}$ cm
2.	95 cm
3.	$42\ ^{2}/_{3}$ cm
4.	55 cm
5.	26 cm
6.	$40\ ^{4}/_{5}$ cm
7.	35 cm