Encontrando el volumen de prismas Rectangulares Nombre:

Encuentra el volumen de cada prisma rectangular. Mide en cm (no estan en escala).

1)

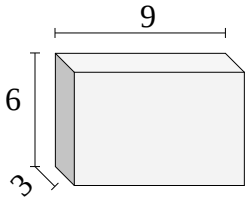

2)

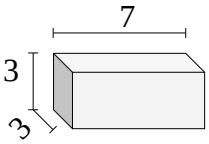

3)

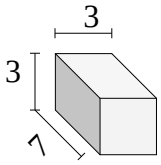

4)

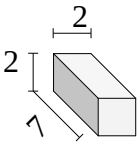

5)

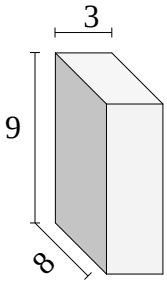

6)

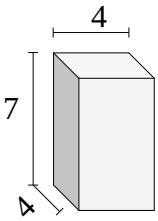

7)

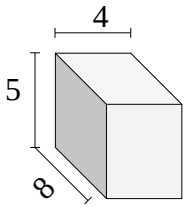

8)

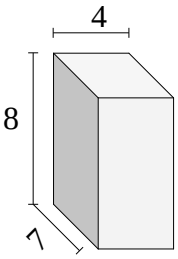

9)

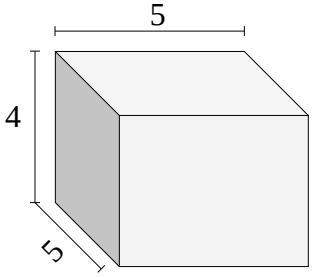

10)

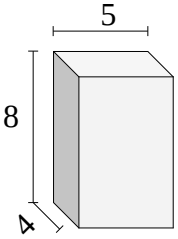

Respuestas

1. _____
2. _____
3. _____
4. _____
5. _____
6. _____
7. _____
8. _____
9. _____
10. _____

1-10	90	80	70	60	50	40	30	20	10	0

Encontrando el volumen de prismas Rectangulares Nombre: **Clave De Respuestas**

Encuentra el volumen de cada prisma rectangular. Mide en cm (no estan en escala).

1)

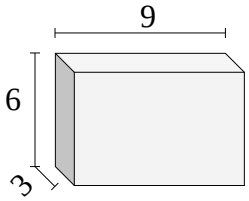

2)

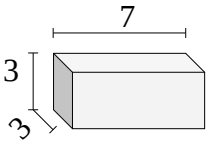

3)

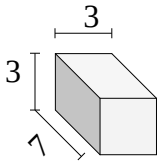

4)

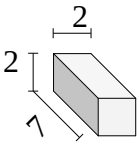

5)

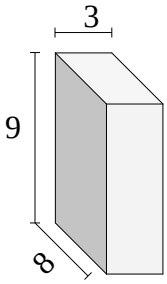

6)

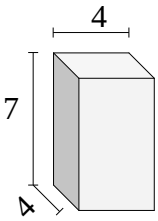

7)

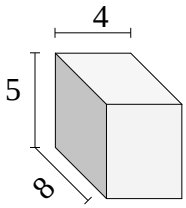

8)

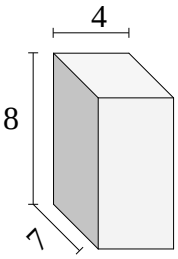

9)

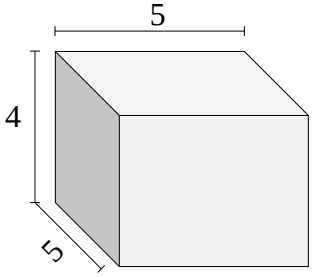

10)

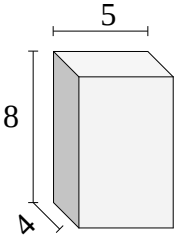

Respuestas

1. **162**
2. **63**
3. **63**
4. **28**
5. **216**
6. **112**
7. **160**
8. **224**
9. **100**
10. **160**

1-10	90	80	70	60	50	40	30	20	10	0