Encuentra el área de los triángulos. Nombre:

Encuentra el área de cada triángulo. Redondea tu respuesta a la décima más cercana.

1)

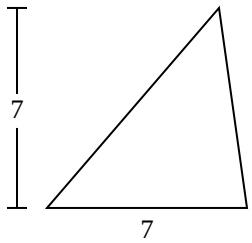

2)

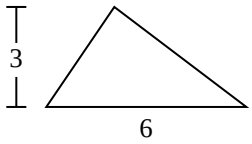

3)

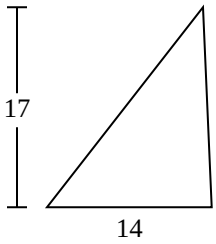

4)

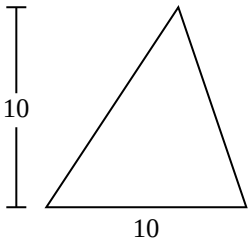

5)

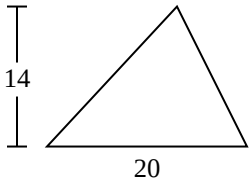

6)

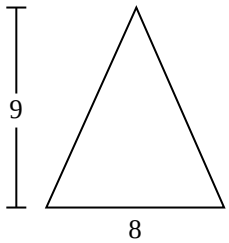

7)

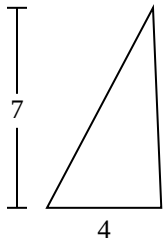

8)

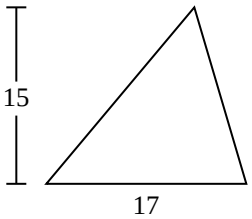

9)

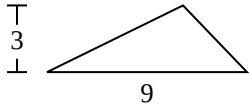

10)

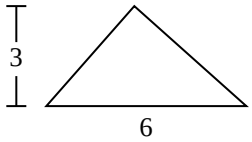

Respuestas

1. _____
2. _____
3. _____
4. _____
5. _____
6. _____
7. _____
8. _____
9. _____
10. _____

1-10	90	80	70	60	50	40	30	20	10	0

Encuentra el área de los triángulos. Nombre: **Clave De Respuestas**

Encuentra el área de cada triángulo. Redondea tu respuesta a la décima más cercana.

1)

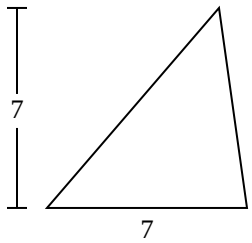

2)

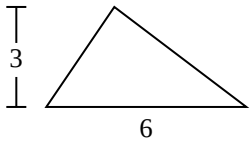

3)

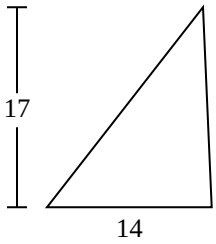

4)

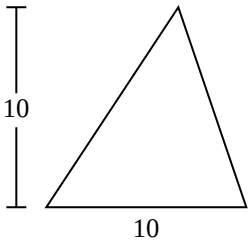

5)

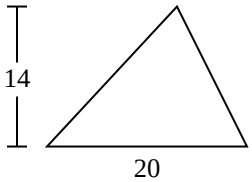

6)

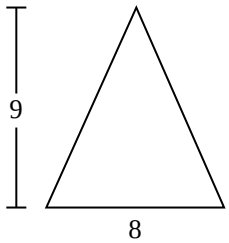

7)

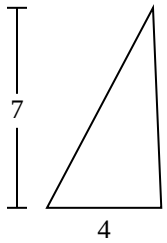

8)

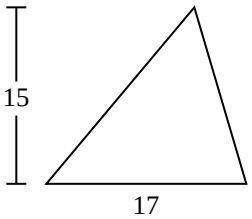

9)

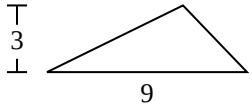

10)

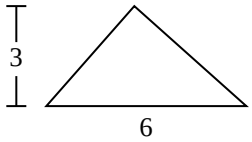

Respuestas

1. **24.5**
2. **9**
3. **119**
4. **50**
5. **140**
6. **36**
7. **14**
8. **127.5**
9. **13.5**
10. **9**

1-10	90	80	70	60	50	40	30	20	10	0

Encuentra el área de los triángulos. Nombre:

Encuentra el área de cada triángulo. Redondea tu respuesta a la décima más cercana.

127.5	13.5	119	140	14
24.5	9	36	50	

1)

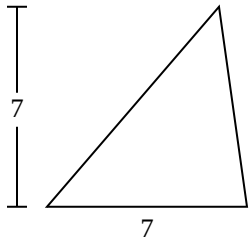

2)

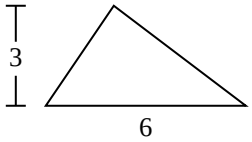

3)

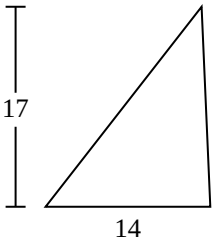

4)

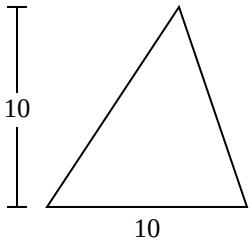

5)

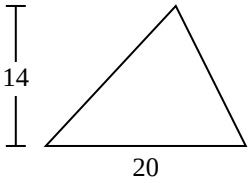

6)

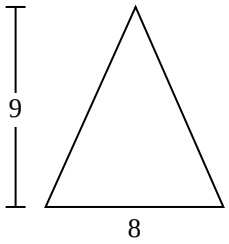

7)

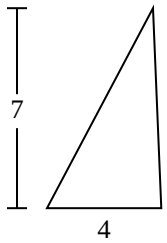

8)

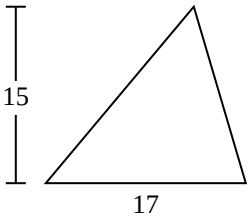

9)

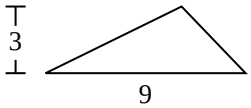

Respuestas

1. _____
2. _____
3. _____
4. _____
5. _____
6. _____
7. _____
8. _____
9. _____

1-9	89	78	67	56	44	33	22	11	0