Determinando el área rectilínea Nombre:

**Encuentra el área total de cada figura. La medida está en milímetros (mm). No a escala.**

**1)**

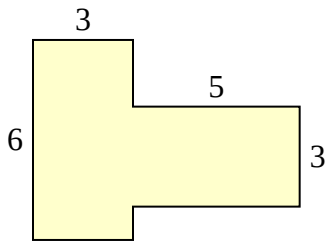


**2)**

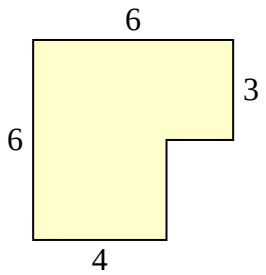


**3)**

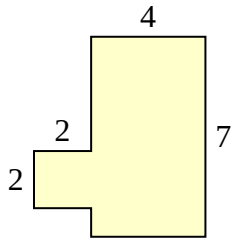


**4)**

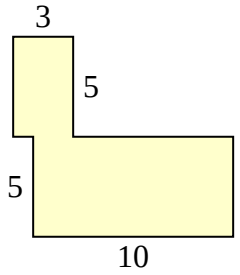


**5)**

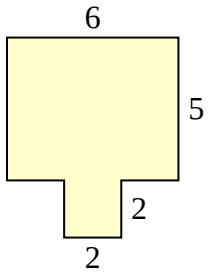


**6)**

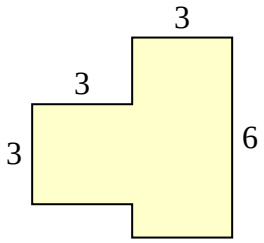


**7)**

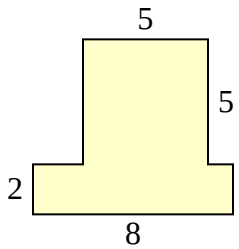


**8)**

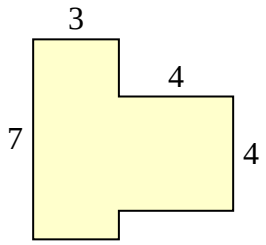


**9)**

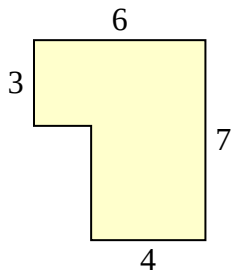


**10)**

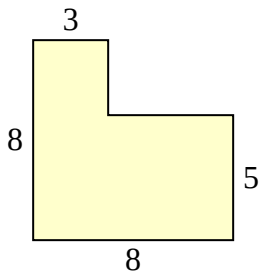


**Respuestas**

1. _____
2. _____
3. _____
4. _____
5. _____
6. _____
7. _____
8. _____
9. _____
10. _____



| 1-10 | 90 | 80 | 70 | 60 | 50 | 40 | 30 | 20 | 10 | 0 |
|---|---|---|---|---|---|---|---|---|---|---|

**Encuentra el área total de cada figura. La medida está en milímetros (mm). No a escala.**

**1)**

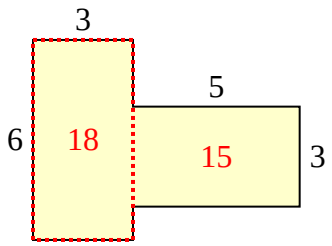


**2)**

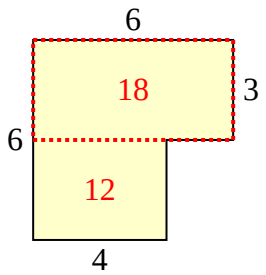


**3)**

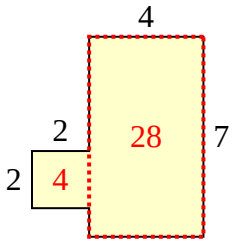


**4)**

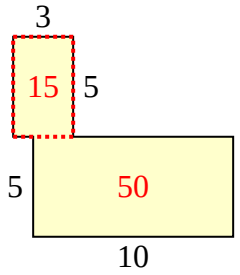


**5)**

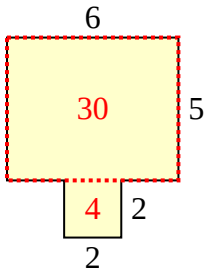


**6)**

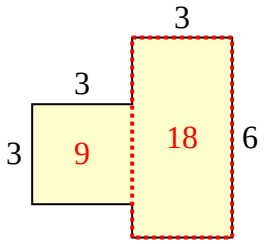


**7)**

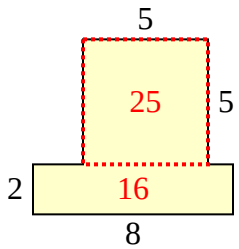


**8)**

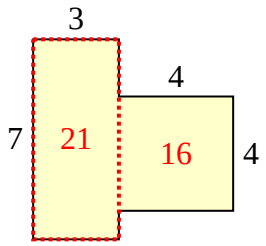


**9)**

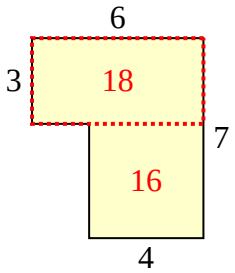


**10)**

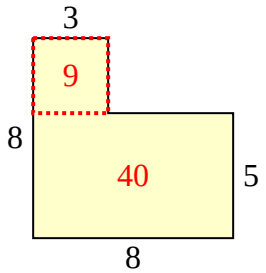


## Respuestas

1. **33 mm²**
2. **30 mm²**
3. **32 mm²**
4. **65 mm²**
5. **34 mm²**
6. **27 mm²**
7. **41 mm²**
8. **37 mm²**
9. **34 mm²**
10. **49 mm²**



| 1-10 | 90 | 80 | 70 | 60 | 50 | 40 | 30 | 20 | 10 | 0 |
|---|---|---|---|---|---|---|---|---|---|---|