Expresar fracciones numéricamente Nombre:

Escribe la cantidad sombreada como una fracción.

Ej)



1)



2)



3)



4)

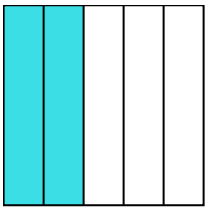

5)

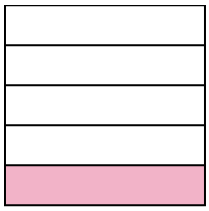

6)

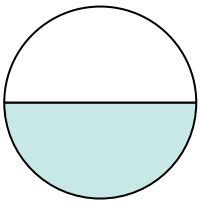

7)



8)

9)



10)

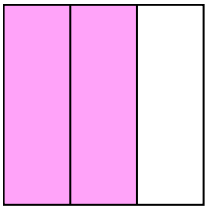

11)

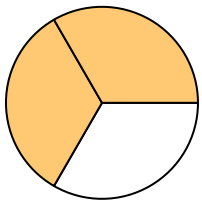

12)



13)

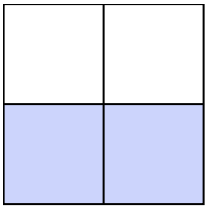

14)

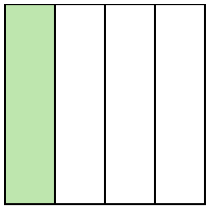

Respuestas

Ej. $\frac{4}{8}$

1. _____
2. _____
3. _____
4. _____
5. _____
6. _____
7. _____
8. _____
9. _____
10. _____
11. _____
12. _____
13. _____
14. _____

1-10	93	86	79	71	64	57	50	43	36	29
11-14	21	14	7	0						

Escribe la cantidad sombreada como una fracción.

Ej)



1)



2)



3)



4)

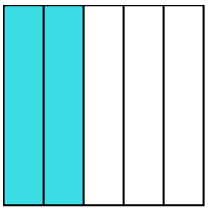

5)

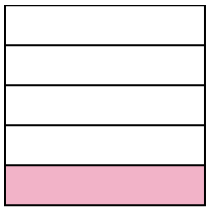

6)

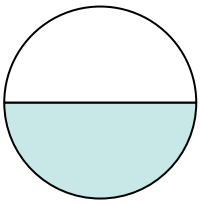

7)



8)

9)



10)

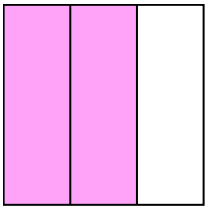

11)

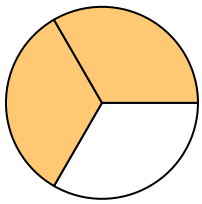

12)



13)

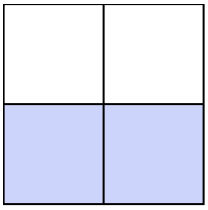

14)

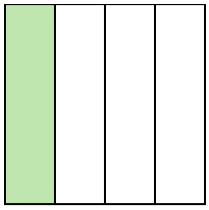

Respuestas

Ej.	$\frac{4}{8}$
1.	$\frac{2}{8}$
2.	$\frac{1}{2}$
3.	$\frac{1}{3}$
4.	$\frac{2}{5}$
5.	$\frac{1}{5}$
6.	$\frac{1}{2}$
7.	$\frac{1}{8}$
8.	$\frac{1}{5}$
9.	$\frac{4}{4}$
10.	$\frac{2}{3}$
11.	$\frac{2}{3}$
12.	$\frac{1}{2}$
13.	$\frac{2}{4}$
14.	$\frac{1}{4}$

1-10	93	86	79	71	64	57	50	43	36	29
11-14	21	14	7	0						